Addition & Subtraction on the Number Line · 1

$17 + 8 = ___$



Addition & Subtraction on the Number Line · 2

$51 - 14 = ___$

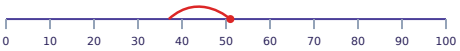

Addition & Subtraction on the Number Line · 3

$34 + 11 = ___$



Addition & Subtraction on the Number Line · 4

$31 - 5 = ___$



Addition & Subtraction on the Number Line · 5

$31 + 6 = ___$



Addition & Subtraction on the Number Line · 6

$39 - 2 = ___$



Addition & Subtraction on the Number Line · 7

$5 + 5 = ___$



Addition & Subtraction on the Number Line · 8

$20 - 13 = ___$



Addition & Subtraction on the Number Line · 2

ANSWER

37

Addition & Subtraction on the Number Line · 1

ANSWER

25

Addition & Subtraction on the Number Line · 4

ANSWER

26

Addition & Subtraction on the Number Line · 3

ANSWER

45

Addition & Subtraction on the Number Line · 6

ANSWER

37

Addition & Subtraction on the Number Line · 5

ANSWER

37

Addition & Subtraction on the Number Line · 8

ANSWER

7

Addition & Subtraction on the Number Line · 7

ANSWER

10

Addition & Subtraction on the Number Line · 9

$74 + 18 = ___$



Addition & Subtraction on the Number Line · 10

$28 - 4 = ___$



Addition & Subtraction on the Number Line · 11

$55 + 6 = ___$



Addition & Subtraction on the Number Line · 12

$16 - 8 = ___$



Addition & Subtraction on the Number Line · 13

$26 + 6 = ___$



Addition & Subtraction on the Number Line · 14

$73 - 18 = ___$



Addition & Subtraction on the Number Line · 15

$36 + 12 = ___$



Addition & Subtraction on the Number Line · 16

$63 - 6 = ___$

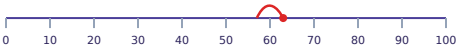

Addition & Subtraction on the Number Line · 10

ANSWER

24

Addition & Subtraction on the Number Line · 9

ANSWER

92

Addition & Subtraction on the Number Line · 12

ANSWER

8

Addition & Subtraction on the Number Line · 11

ANSWER

61

Addition & Subtraction on the Number Line · 14

ANSWER

55

Addition & Subtraction on the Number Line · 13

ANSWER

32

Addition & Subtraction on the Number Line · 16

ANSWER

57

Addition & Subtraction on the Number Line · 15

ANSWER

48

Addition & Subtraction on the Number Line · 17

$71 + 10 = ___$



Addition & Subtraction on the Number Line · 18

$81 - 5 = ___$



Addition & Subtraction on the Number Line · 19

$61 + 7 = ___$



Addition & Subtraction on the Number Line · 20

$94 - 17 = ___$



Addition & Subtraction on the Number Line · 21

$54 + 20 = ___$

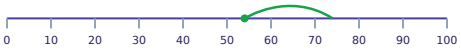

Addition & Subtraction on the Number Line · 22

$35 - 11 = ___$



Addition & Subtraction on the Number Line · 23

$21 + 8 = ___$

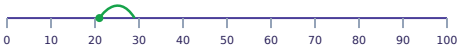

Addition & Subtraction on the Number Line · 24

$44 - 16 = ___$

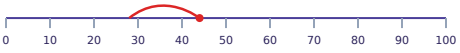

Addition & Subtraction on the Number Line · 18

ANSWER

76

Addition & Subtraction on the Number Line · 17

ANSWER

81

Addition & Subtraction on the Number Line · 20

ANSWER

77

Addition & Subtraction on the Number Line · 19

ANSWER

68

Addition & Subtraction on the Number Line · 22

ANSWER

24

Addition & Subtraction on the Number Line · 21

ANSWER

74

Addition & Subtraction on the Number Line · 24

ANSWER

28

Addition & Subtraction on the Number Line · 23

ANSWER

29