Task card 1 Missing Addends Within 100

___ + 12 = 36

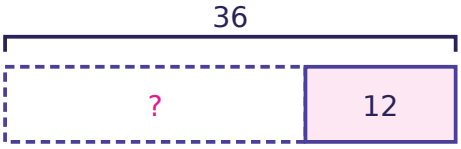

Task card 2 Missing Addends Within 100

42 + ___ = 54

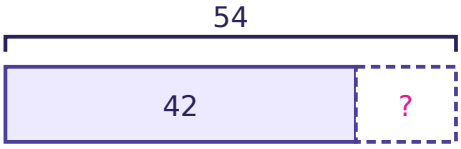

Task card 3 Missing Addends Within 100

___ + 12 = 48



Task card 4 Missing Addends Within 100

36 + ___ = 57

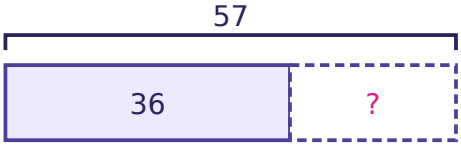

Task card 5 Missing Addends Within 100

___ + 12 = 57



Task card 6 Missing Addends Within 100

28 + ___ = 48

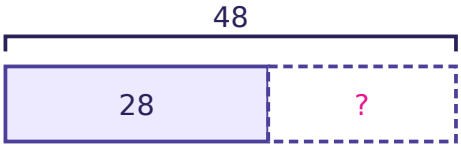

Task card 7 Missing Addends Within 100

$___ + 24 = 54$

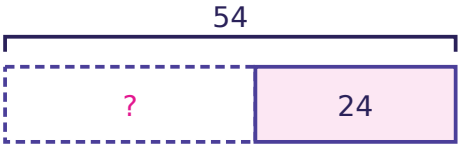

Task card 8 Missing Addends Within 100

$31 + ___ = 48$

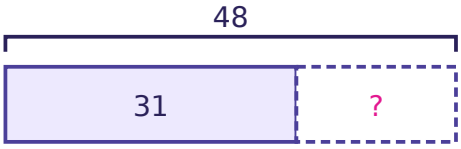

Task card 9 Missing Addends Within 100

$20 + ___ = 36$

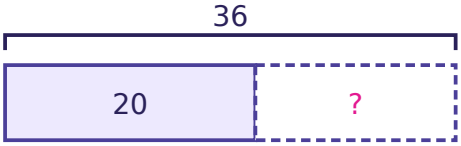

Task card 10 Missing Addends Within 100

$___ + 15 = 38$

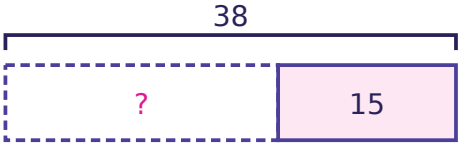

Task card 11 Missing Addends Within 100

$20 + ___ = 50$

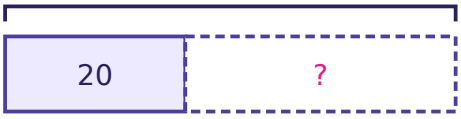

Task card 12 Missing Addends Within 100

$___ + 16 = 58$



Task card 13 Missing Addends Within 100

$17 + ___ = 39$

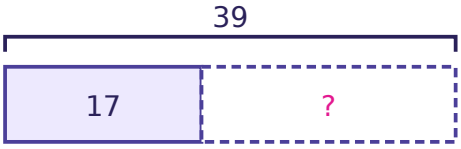

Task card 14 Missing Addends Within 100

$___ + 35 = 47$

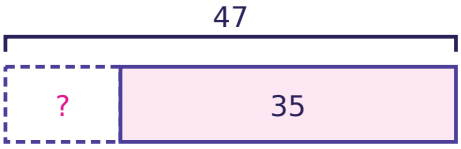

Task card 15 Missing Addends Within 100

$16 + ___ = 37$

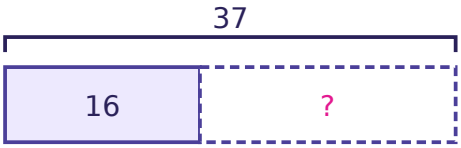

Task card 16 Missing Addends Within 100

$___ + 23 = 39$

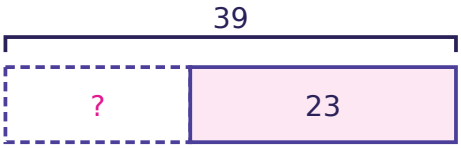

Task card 17 Missing Addends Within 100

$37 + ___ = 78$

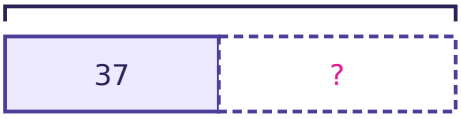

Task card 18 Missing Addends Within 100

$82 - ___ = 70$



Task card 19 Missing Addends Within 100

$17 + ___ = 58$



Task card 20 Missing Addends Within 100

$___ + 31 = 44$

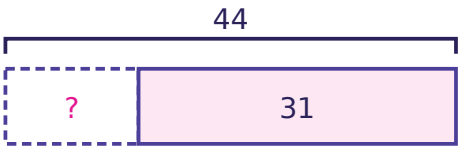

Task card 21 Missing Addends Within 100

$52 + ___ = 89$

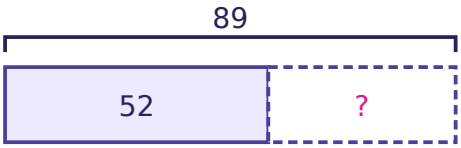

Task card 22 Missing Addends Within 100

$46 - ___ = 33$

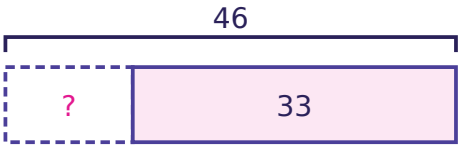

Task card 23 Missing Addends Within 100

$21 + ___ = 37$

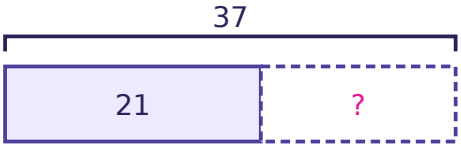

Task card 24 Missing Addends Within 100

$___ + 19 = 39$

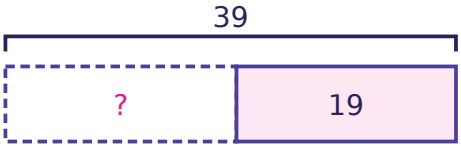

Missing Addends Within 100 Task Cards

Recording sheet · Grade 2 · Find the missing number. Check by putting it back in the number sentence.

Name: _____ Date: _____

Scan to check your answers

1	2	3	4
5	6	7	8
9	10	11	12
13	14	15	16
17	18	19	20
21	22	23	24

Missing Addends Within 100 Task Cards: Answer Key

Grade 2 · Easy

The answers online

1. 24	**2.** 12	**3.** 36
4. 21	**5.** 45	**6.** 20
7. 30	**8.** 17	**9.** 16
10. 23	**11.** 30	**12.** 42
13. 22	**14.** 12	**15.** 21
16. 16	**17.** 41	**18.** 12
19. 41	**20.** 13	**21.** 37
22. 13	**23.** 16	**24.** 20