Task card 1 Measuring in Inches & Centimeters

How long is the stick in inches? Careful — it does not start at 0!

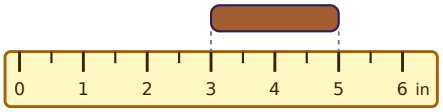

Task card 2 Measuring in Inches & Centimeters

How long is the worm in centimeters?

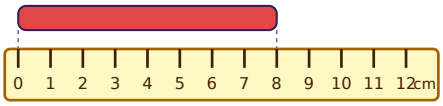

Task card 3 Measuring in Inches & Centimeters

How long is the stick in inches? Careful — it does not start at 0!

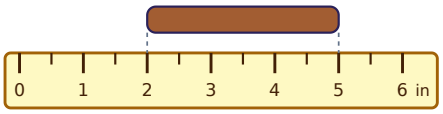

Task card 4 Measuring in Inches & Centimeters

How long is the straw in centimeters? Careful — it does not start at 0!

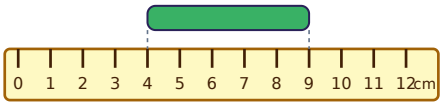

Task card 5 Measuring in Inches & Centimeters

How long is the worm in inches? Careful — it does not start at 0!

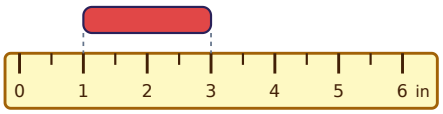

Task card 6 Measuring in Inches & Centimeters

How long is the straw in centimeters?

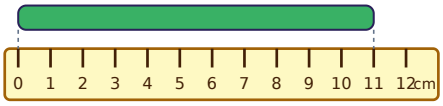

Task card 7 Measuring in Inches & Centimeters

A crayon is 19 inches long. If you measure it in centimeters, will the number be more or less than 19? Write more or less.

Task card 8 Measuring in Inches & Centimeters

A stick is 19 inches long. If you measure it in centimeters, will the number be more or less than 19? Write more or less.

Task card 9 Measuring in Inches & Centimeters

How long is the straw in inches? Careful — it does not start at 0!

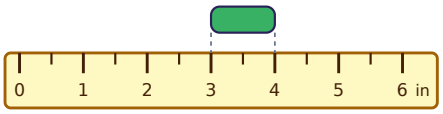

Task card 10 Measuring in Inches & Centimeters

How long is the crayon in centimeters? Careful — it does not start at 0!

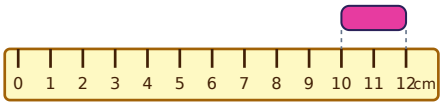

Task card 11 Measuring in Inches & Centimeters

How long is the ribbon in inches? Careful — it does not start at 0!

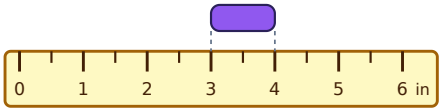

Task card 12 Measuring in Inches & Centimeters

How long is the ribbon in centimeters? Careful — it does not start at 0!

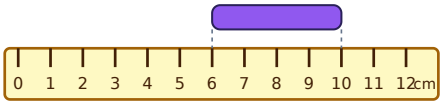

Task card 13 Measuring in Inches & Centimeters

How long is the ribbon in inches? Careful — it does not start at 0!

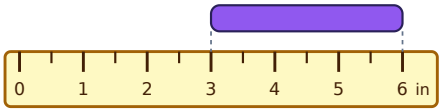

Task card 14 Measuring in Inches & Centimeters

How long is the stick in centimeters? Careful — it does not start at 0!

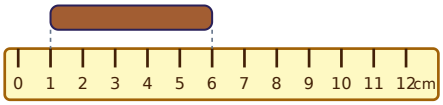

Task card 15 Measuring in Inches & Centimeters

Which is a better estimate for the length of a marker in centimeters: 13 or 130?

Task card 16 Measuring in Inches & Centimeters

Which is a better estimate for the length of a button in centimeters: 20 or 2?

Task card 17 Measuring in Inches & Centimeters

How long is the stick in inches? Careful — it does not start at 0!

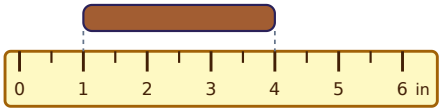

Task card 18 Measuring in Inches & Centimeters

How long is the worm in centimeters? Careful — it does not start at 0!

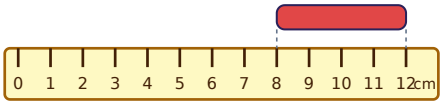

Task card 19 Measuring in Inches & Centimeters

How long is the crayon in inches? Careful — it does not start at 0!

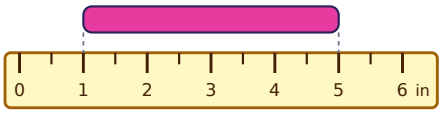

Task card 20 Measuring in Inches & Centimeters

How long is the stick in centimeters? Careful — it does not start at 0!

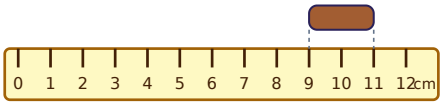

Task card 21 Measuring in Inches & Centimeters

How long is the stick in inches? Careful — it does not start at 0!

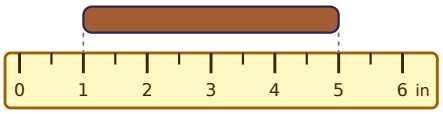

Task card 22 Measuring in Inches & Centimeters

How long is the worm in centimeters? Careful — it does not start at 0!

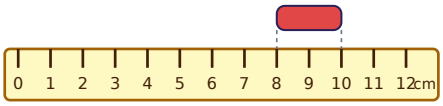

Task card 23 Measuring in Inches & Centimeters

Which is a better estimate for the length of a book in inches: 10 or 100?

Task card 24 Measuring in Inches & Centimeters

A pencil is 20 centimeters long. If you measure it in inches, will the number be more or less than 20? Write more or less.

Measuring in Inches & Centimeters Task Cards

Recording sheet · Grade 2 · Use the ruler to find each length. Answer with a number.

Name: _____ Date: _____

Scan to check your answers

1	2	3	4
5	6	7	8
9	10	11	12
13	14	15	16
17	18	19	20
21	22	23	24

Measuring in Inches & Centimeters Task Cards: Answer Key

Grade 2 · Hard

The answers online

1. 2	**2.** 8	**3.** 3
4. 5	**5.** 2	**6.** 11
7. more	**8.** more	**9.** 1
10. 2	**11.** 1	**12.** 4
13. 3	**14.** 5	**15.** 13
16. 2	**17.** 3	**18.** 4
19. 4	**20.** 2	**21.** 4
22. 2	**23.** 10	**24.** less