Task card 1 Measuring in Inches & Centimeters

How long is the ribbon in inches?

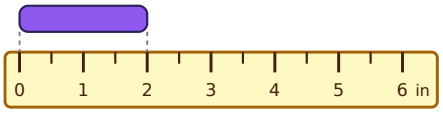

Task card 2 Measuring in Inches & Centimeters

How long is the crayon in inches?

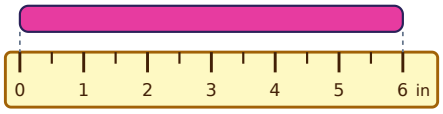

Task card 3 Measuring in Inches & Centimeters

How long is the stick in inches?

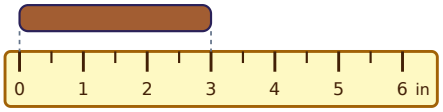

Task card 4 Measuring in Inches & Centimeters

How long is the ribbon in inches?

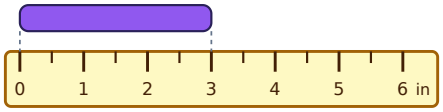

Task card 5 Measuring in Inches & Centimeters

How long is the stick in inches?

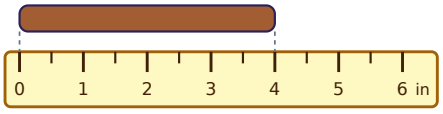

Task card 6 Measuring in Inches & Centimeters

How long is the ribbon in inches?

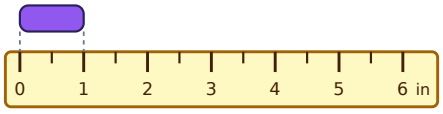

Task card 7 Measuring in Inches & Centimeters

How long is the worm in inches?

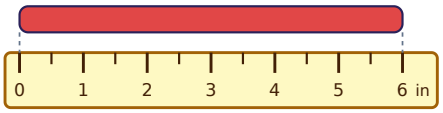

Task card 8 Measuring in Inches & Centimeters

How long is the straw in inches?

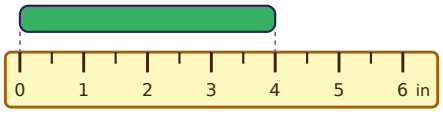

Task card 9 Measuring in Inches & Centimeters

How long is the worm in inches?

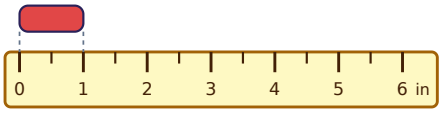

Task card 10 Measuring in Inches & Centimeters

How long is the ribbon in centimeters?

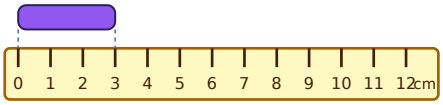

Task card 11 Measuring in Inches & Centimeters

How long is the crayon in inches?

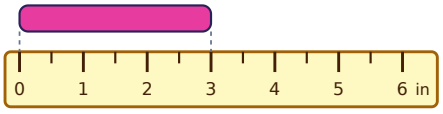

Task card 12 Measuring in Inches & Centimeters

How long is the pencil in centimeters?

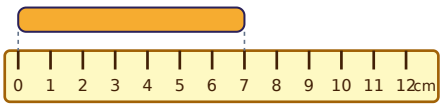

Task card 13 Measuring in Inches & Centimeters

How long is the ribbon in inches?

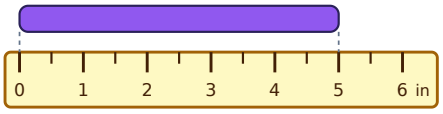

Task card 14 Measuring in Inches & Centimeters

How long is the stick in centimeters?

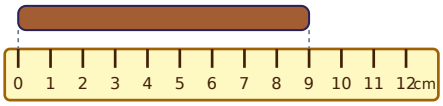

Task card 15 Measuring in Inches & Centimeters

How long is the worm in inches?

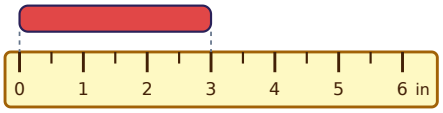

Task card 16 Measuring in Inches & Centimeters

How long is the straw in centimeters?

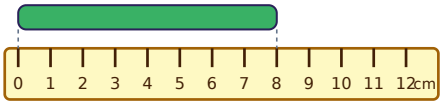

Task card 17 Measuring in Inches & Centimeters

How long is the stick in inches?

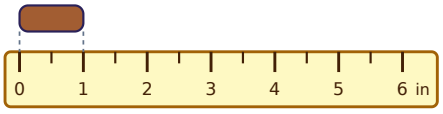

Task card 18 Measuring in Inches & Centimeters

How long is the pencil in inches?

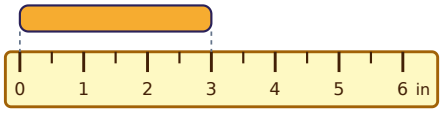

Task card 19 Measuring in Inches & Centimeters

How long is the stick in centimeters?

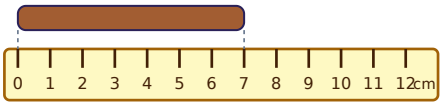

Task card 20 Measuring in Inches & Centimeters

A straw is 7 inches long. If you measure it in centimeters, will the number be more or less than 7? Write more or less.

Task card 21 Measuring in Inches & Centimeters

A straw is 8 centimeters long. If you measure it in inches, will the number be more or less than 8? Write more or less.

Task card 22 Measuring in Inches & Centimeters

How long is the crayon in inches?

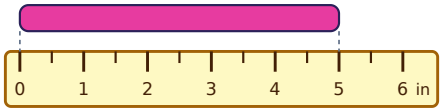

Task card 23 Measuring in Inches & Centimeters

How long is the pencil in inches?

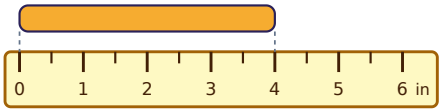

Task card 24 Measuring in Inches & Centimeters

How long is the straw in inches?

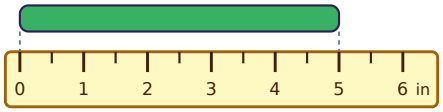

Measuring in Inches & Centimeters Task Cards

Recording sheet · Grade 2 · Use the ruler to find each length. Answer with a number.

Name: _____ Date: _____

Scan to check your answers

1	2	3	4
5	6	7	8
9	10	11	12
13	14	15	16
17	18	19	20
21	22	23	24

Measuring in Inches & Centimeters Task Cards: Answer Key

Grade 2 · Easy

The answers online

1. 2	**2.** 6	**3.** 3
4. 3	**5.** 4	**6.** 1
7. 6	**8.** 4	**9.** 1
10. 3	**11.** 3	**12.** 7
13. 5	**14.** 9	**15.** 3
16. 8	**17.** 1	**18.** 3
19. 7	**20.** more	**21.** less
22. 5	**23.** 4	**24.** 5