Measuring in Inches & Centimeters · 1

How long is the stick in inches? Careful — it does not start at 0!

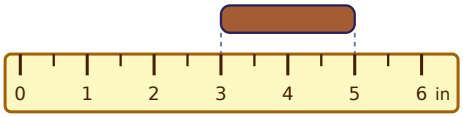

Measuring in Inches & Centimeters · 2

How long is the worm in centimeters?

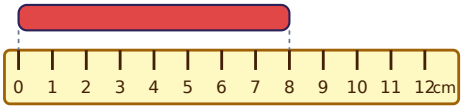

Measuring in Inches & Centimeters · 3

How long is the stick in inches? Careful — it does not start at 0!

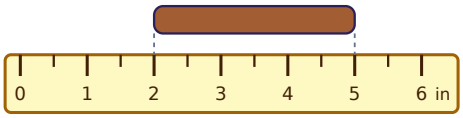

Measuring in Inches & Centimeters · 4

How long is the straw in centimeters? Careful — it does not start at 0!

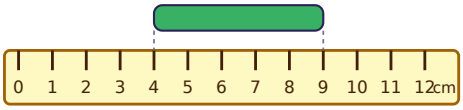

Measuring in Inches & Centimeters · 5

How long is the worm in inches? Careful — it does not start at 0!

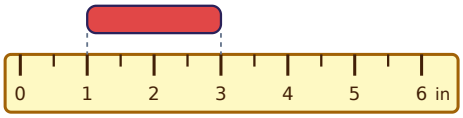

Measuring in Inches & Centimeters · 6

How long is the straw in centimeters?

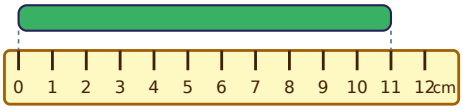

Measuring in Inches & Centimeters · 7

A crayon is 19 inches long. If you measure it in centimeters, will the number be more or less than 19? Write more or less.

Measuring in Inches & Centimeters · 8

A stick is 19 inches long. If you measure it in centimeters, will the number be more or less than 19? Write more or less.

Measuring in Inches & Centimeters · 2

ANSWER

8

Measuring in Inches & Centimeters · 1

ANSWER

2

Measuring in Inches & Centimeters · 4

ANSWER

5

Measuring in Inches & Centimeters · 3

ANSWER

3

Measuring in Inches & Centimeters · 6

ANSWER

11

Measuring in Inches & Centimeters · 5

ANSWER

2

Measuring in Inches & Centimeters · 8

ANSWER

more

Measuring in Inches & Centimeters · 7

ANSWER

more

Measuring in Inches & Centimeters · 9

How long is the straw in inches? Careful — it does not start at 0!

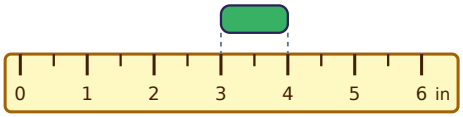

Measuring in Inches & Centimeters · 10

How long is the crayon in centimeters? Careful — it does not start at 0!

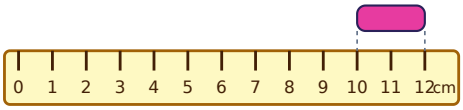

Measuring in Inches & Centimeters · 11

How long is the ribbon in inches? Careful — it does not start at 0!

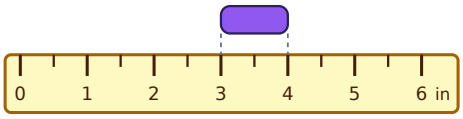

Measuring in Inches & Centimeters · 12

How long is the ribbon in centimeters? Careful — it does not start at 0!

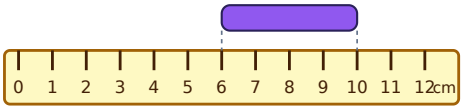

Measuring in Inches & Centimeters · 13

How long is the ribbon in inches? Careful — it does not start at 0!

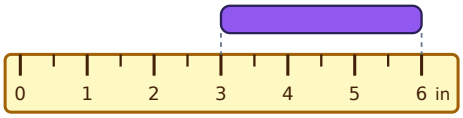

Measuring in Inches & Centimeters · 14

How long is the stick in centimeters? Careful — it does not start at 0!

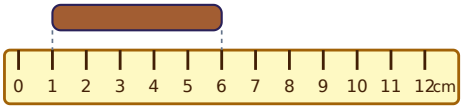

Measuring in Inches & Centimeters · 15

Which is a better estimate for the length of a marker in centimeters: 13 or 130?

Measuring in Inches & Centimeters · 16

Which is a better estimate for the length of a button in centimeters: 20 or 2?

Measuring in Inches & Centimeters · 10

ANSWER

2

Measuring in Inches & Centimeters · 9

ANSWER

1

Measuring in Inches & Centimeters · 12

ANSWER

4

Measuring in Inches & Centimeters · 11

ANSWER

1

Measuring in Inches & Centimeters · 14

ANSWER

5

Measuring in Inches & Centimeters · 13

ANSWER

3

Measuring in Inches & Centimeters · 16

ANSWER

2

Measuring in Inches & Centimeters · 15

ANSWER

13

Measuring in Inches & Centimeters · 17

How long is the stick in inches? Careful — it does not start at 0!

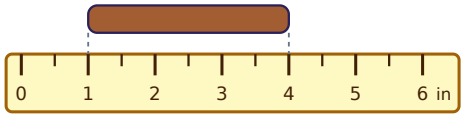

Measuring in Inches & Centimeters · 18

How long is the worm in centimeters? Careful — it does not start at 0!

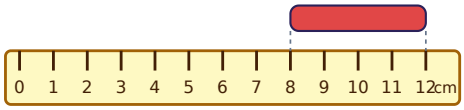

Measuring in Inches & Centimeters · 19

How long is the crayon in inches? Careful — it does not start at 0!

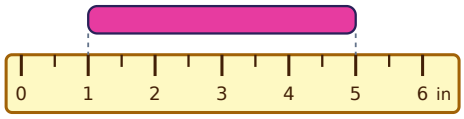

Measuring in Inches & Centimeters · 20

How long is the stick in centimeters? Careful — it does not start at 0!

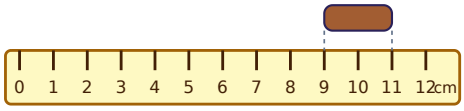

Measuring in Inches & Centimeters · 21

How long is the stick in inches? Careful — it does not start at 0!

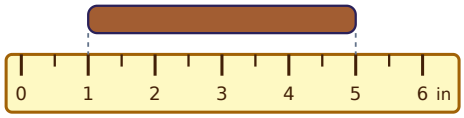

Measuring in Inches & Centimeters · 22

How long is the worm in centimeters? Careful — it does not start at 0!

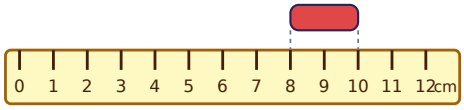

Measuring in Inches & Centimeters · 23

Which is a better estimate for the length of a book in inches: 10 or 100?

Measuring in Inches & Centimeters · 24

A pencil is 20 centimeters long. If you measure it in inches, will the number be more or less than 20? Write more or less.

Measuring in Inches & Centimeters · 18

ANSWER

4

Measuring in Inches & Centimeters · 17

ANSWER

3

Measuring in Inches & Centimeters · 20

ANSWER

2

Measuring in Inches & Centimeters · 19

ANSWER

4

Measuring in Inches & Centimeters · 22

ANSWER

2

Measuring in Inches & Centimeters · 21

ANSWER

4

Measuring in Inches & Centimeters · 24

ANSWER

less

Measuring in Inches & Centimeters · 23

ANSWER

10