Measuring in Inches & Centimeters · 1

How long is the ribbon in inches?

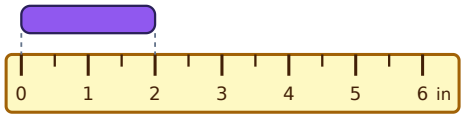

Measuring in Inches & Centimeters · 2

How long is the crayon in inches?

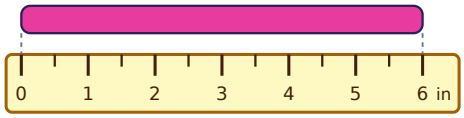

Measuring in Inches & Centimeters · 3

How long is the stick in inches?

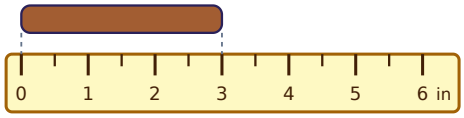

Measuring in Inches & Centimeters · 4

How long is the ribbon in inches?

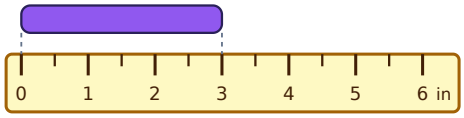

Measuring in Inches & Centimeters · 5

How long is the stick in inches?

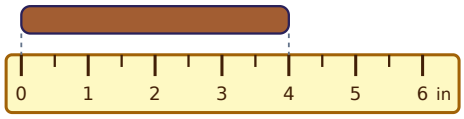

Measuring in Inches & Centimeters · 6

How long is the ribbon in inches?

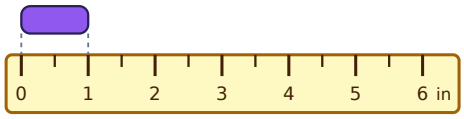

Measuring in Inches & Centimeters · 7

How long is the worm in inches?

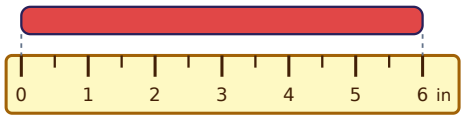

Measuring in Inches & Centimeters · 8

How long is the straw in inches?

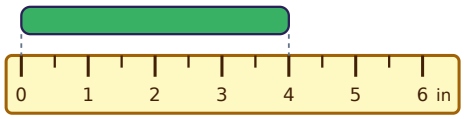

Measuring in Inches & Centimeters · 2

ANSWER

6

Measuring in Inches & Centimeters · 1

ANSWER

2

Measuring in Inches & Centimeters · 4

ANSWER

3

Measuring in Inches & Centimeters · 3

ANSWER

3

Measuring in Inches & Centimeters · 6

ANSWER

1

Measuring in Inches & Centimeters · 5

ANSWER

4

Measuring in Inches & Centimeters · 8

ANSWER

4

Measuring in Inches & Centimeters · 7

ANSWER

6

Measuring in Inches & Centimeters · 9

How long is the worm in inches?

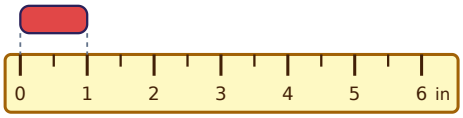

Measuring in Inches & Centimeters · 10

How long is the ribbon in centimeters?

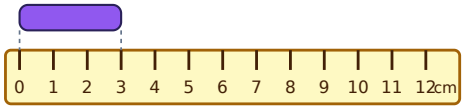

Measuring in Inches & Centimeters · 11

How long is the crayon in inches?

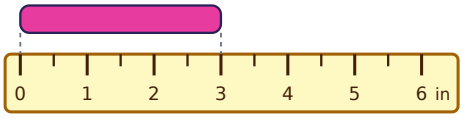

Measuring in Inches & Centimeters · 12

How long is the pencil in centimeters?

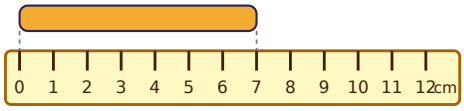

Measuring in Inches & Centimeters · 13

How long is the ribbon in inches?

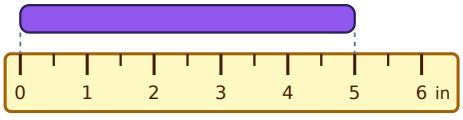

Measuring in Inches & Centimeters · 14

How long is the stick in centimeters?

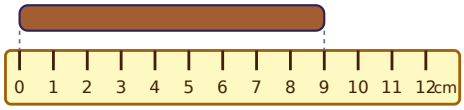

Measuring in Inches & Centimeters · 15

How long is the worm in inches?

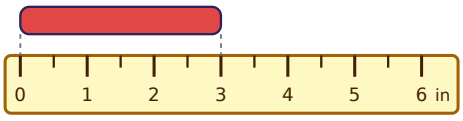

Measuring in Inches & Centimeters · 16

How long is the straw in centimeters?

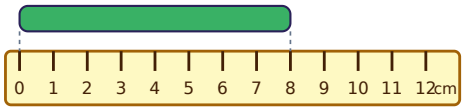

Measuring in Inches & Centimeters · 10

ANSWER

3

Measuring in Inches & Centimeters · 9

ANSWER

1

Measuring in Inches & Centimeters · 12

ANSWER

7

Measuring in Inches & Centimeters · 11

ANSWER

3

Measuring in Inches & Centimeters · 14

ANSWER

9

Measuring in Inches & Centimeters · 13

ANSWER

5

Measuring in Inches & Centimeters · 16

ANSWER

8

Measuring in Inches & Centimeters · 15

ANSWER

3

Measuring in Inches & Centimeters · 17

How long is the stick in inches?

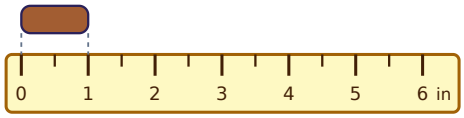

Measuring in Inches & Centimeters · 18

How long is the pencil in inches?

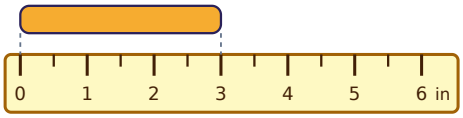

Measuring in Inches & Centimeters · 19

How long is the stick in centimeters?

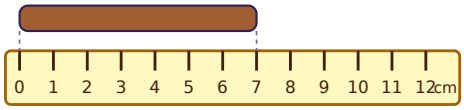

Measuring in Inches & Centimeters · 20

A straw is 7 inches long. If you measure it in centimeters, will the number be more or less than 7? Write more or less.

Measuring in Inches & Centimeters · 21

A straw is 8 centimeters long. If you measure it in inches, will the number be more or less than 8? Write more or less.

Measuring in Inches & Centimeters · 22

How long is the crayon in inches?

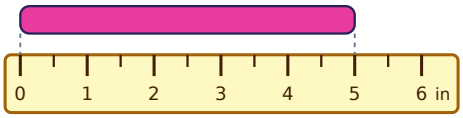

Measuring in Inches & Centimeters · 23

How long is the pencil in inches?

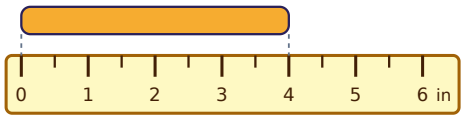

Measuring in Inches & Centimeters · 24

How long is the straw in inches?

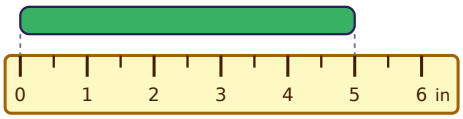

Measuring in Inches & Centimeters · 18

ANSWER

3

Measuring in Inches & Centimeters · 17

ANSWER

1

Measuring in Inches & Centimeters · 20

ANSWER

more

Measuring in Inches & Centimeters · 19

ANSWER

7

Measuring in Inches & Centimeters · 22

ANSWER

5

Measuring in Inches & Centimeters · 21

ANSWER

less

Measuring in Inches & Centimeters · 24

ANSWER

5

Measuring in Inches & Centimeters · 23

ANSWER

4