Task card 1 Line Plots

How many leaves are 7 inches long or shorter?

Lengths of Leaves (inches)

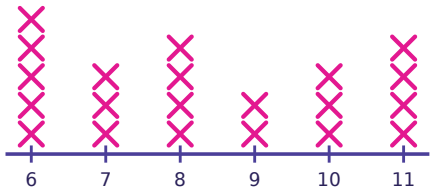

Task card 2 Line Plots

How many inches longer is the longest shell than the shortest shell?

Lengths of Shells (inches)

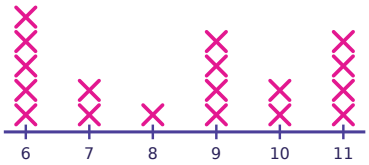

Task card 3 Line Plots

Which length, in inches, do the most sticks have?

Lengths of Sticks (inches)

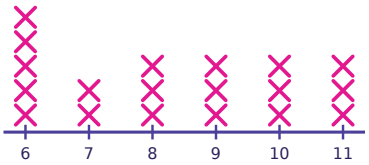

Task card 4 Line Plots

How many leaves are 8 inches long?

Lengths of Leaves (inches)

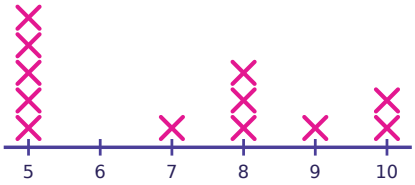

Task card 5 Line Plots

How many pencils were measured in all?

Lengths of Pencils (inches)

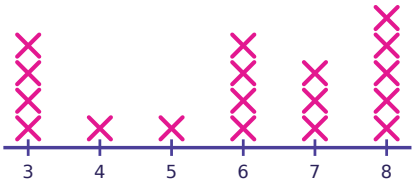

Task card 6 Line Plots

How many crayons are longer than 7 inches?

Lengths of Crayons (inches)

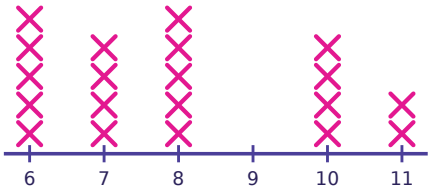

Task card 7 Line Plots

How many crayons are 8 inches long or shorter?

Lengths of Crayons (inches)

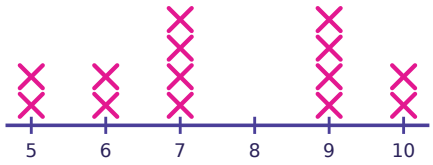

Task card 8 Line Plots

How many inches longer is the longest ribbon than the shortest ribbon?

Lengths of Ribbons (inches)

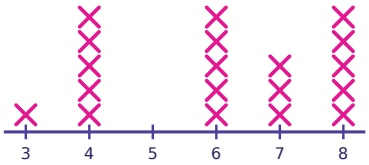

Task card 9 Line Plots

How many shells are 9 inches long or shorter?

Lengths of Shells (inches)

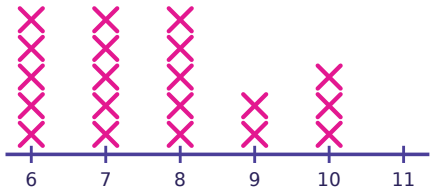

Task card 10 Line Plots

How many inches longer is the longest pencil than the shortest pencil?

Lengths of Pencils (inches)

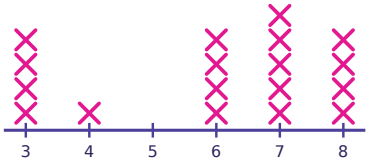

Task card 11 Line Plots

Which length, in inches, do the most pencils have?

Lengths of Pencils (inches)

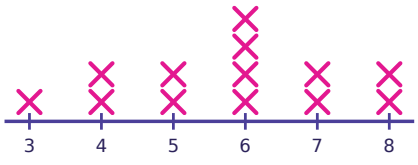

Task card 12 Line Plots

How many ribbons are 3 inches long?

Lengths of Ribbons (inches)

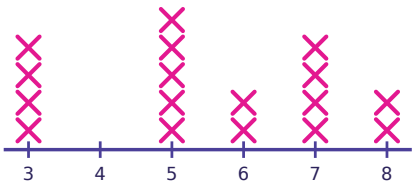

Task card 13 Line Plots

How many leaves were measured in all?

Lengths of Leaves (inches)

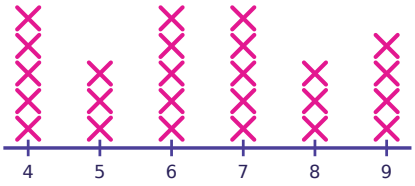

Task card 14 Line Plots

How many sticks are longer than 4 inches?

Lengths of Sticks (inches)

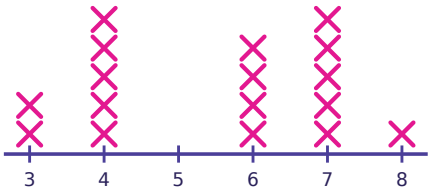

Task card 15 Line Plots

How many shells are 5 inches long or shorter?

Lengths of Shells (inches)

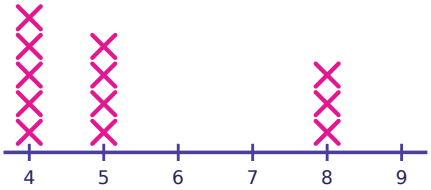

Task card 16 Line Plots

How many inches longer is the longest pencil than the shortest pencil?

Lengths of Pencils (inches)

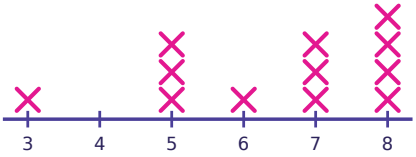

Task card 17 Line Plots

How many pencils are 2 inches long?

Lengths of Pencils (inches)

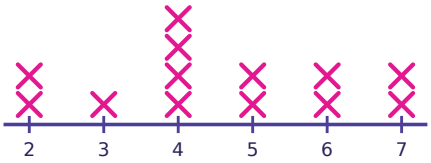

Task card 18 Line Plots

How many leaves were measured in all?

Lengths of Leaves (inches)

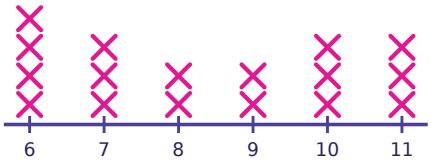

Task card 19 Line Plots

How many ribbons are longer than 4 inches?

Lengths of Ribbons (inches)

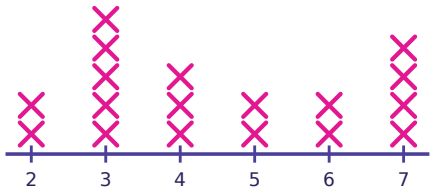

Task card 20 Line Plots

How many pencils are 7 inches long or shorter?

Lengths of Pencils (inches)

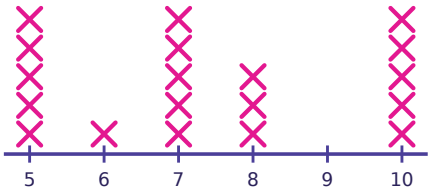

Task card 21 Line Plots

How many inches longer is the longest shell than the shortest shell?

Lengths of Shells (inches)

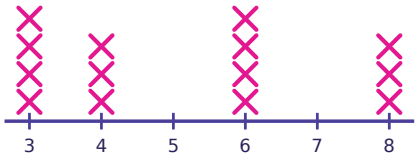

Task card 22 Line Plots

Which length, in inches, do the most leaves have?

Lengths of Leaves (inches)

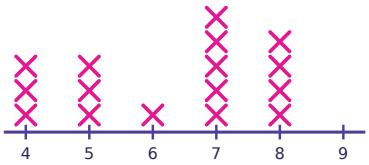

Task card 23 Line Plots

How many ribbons are 4 inches long?

Lengths of Ribbons (inches)

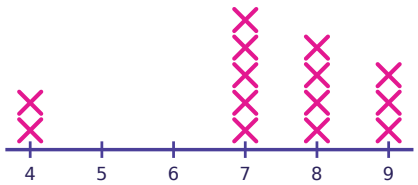

Task card 24 Line Plots

How many pencils were measured in all?

Lengths of Pencils (inches)

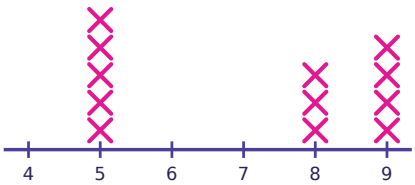

Line Plots Task Cards

Recording sheet · Grade 2 · Each X stands for one object that was measured. Use the line plot to answer.

Name: _____ Date: _____

Scan to check your answers

1	2	3	4
5	6	7	8
9	10	11	12
13	14	15	16
17	18	19	20
21	22	23	24

Line Plots Task Cards: Answer Key

Grade 2 · Hard

The answers online

1. 8	**2.** 5	**3.** 6
4. 3	**5.** 18	**6.** 11
7. 8	**8.** 5	**9.** 17
10. 5	**11.** 6	**12.** 4
13. 25	**14.** 10	**15.** 9
16. 5	**17.** 2	**18.** 17
19. 8	**20.** 11	**21.** 5
22. 7	**23.** 2	**24.** 12