Task card 1 Line Plots

How many crayons are longer than 9 inches?

Lengths of Crayons (inches)

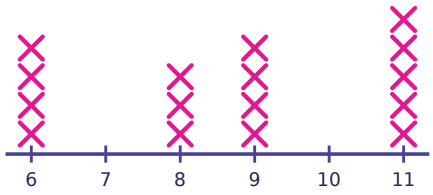

Task card 2 Line Plots

How many crayons are 8 inches long?

Lengths of Crayons (inches)

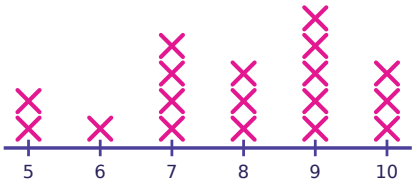

Task card 3 Line Plots

How many leaves were measured in all?

Lengths of Leaves (inches)

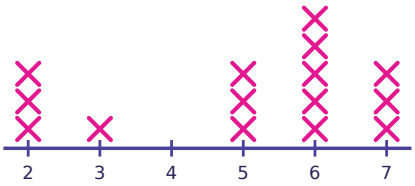

Task card 4 Line Plots

Which length, in inches, do the most sticks have?

Lengths of Sticks (inches)

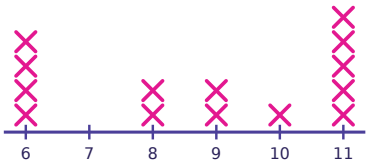

Task card 5 Line Plots

How many ribbons are longer than 5 inches?

Lengths of Ribbons (inches)

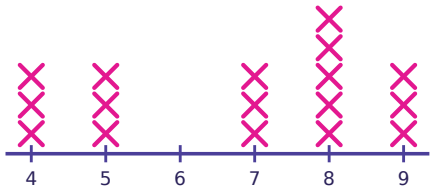

Task card 6 Line Plots

How many leaves are 4 inches long?

Lengths of Leaves (inches)

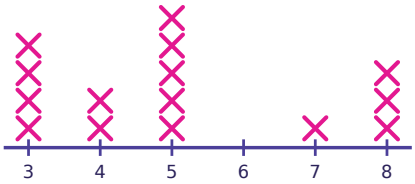

Task card 7 Line Plots

How many crayons were measured in all?

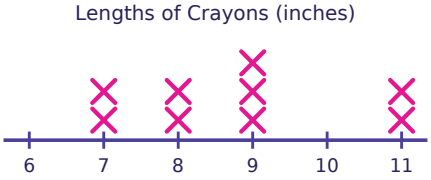

Task card 8 Line Plots

Which length, in inches, do the most sticks have?

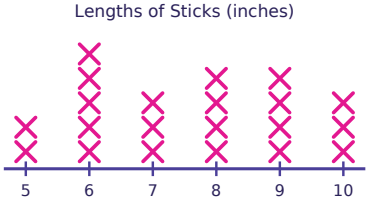

Task card 9 Line Plots

How many inches longer is the longest pencil than the shortest pencil?

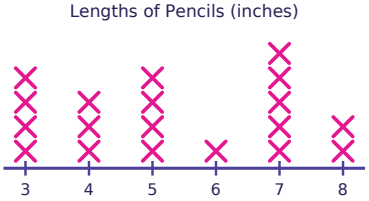

Task card 10 Line Plots

Which length, in inches, do the most shells have?

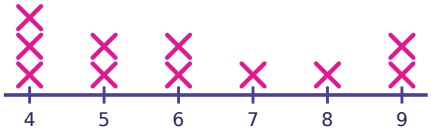

Task card 11 Line Plots

How many pencils are 10 inches long?

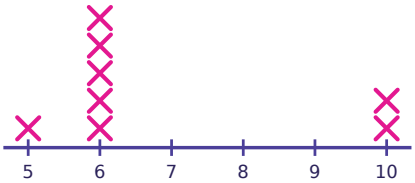

Task card 12 Line Plots

How many leaves were measured in all?

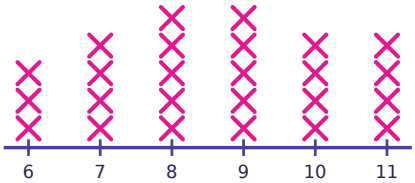

Task card 13 Line Plots

How many sticks are longer than 10 inches?

Lengths of Sticks (inches)

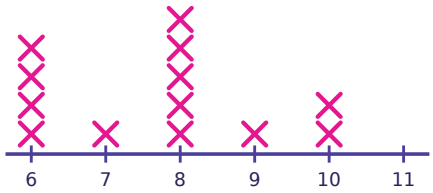

Task card 14 Line Plots

How many crayons are 4 inches long or shorter?

Lengths of Crayons (inches)

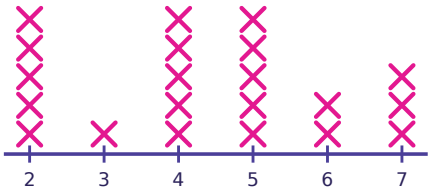

Task card 15 Line Plots

How many inches longer is the longest leaf than the shortest leaf?

Lengths of Leaves (inches)

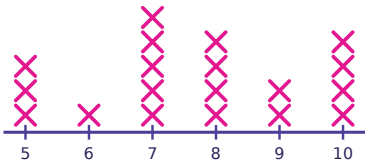

Task card 16 Line Plots

Which length, in inches, do the most leaves have?

Lengths of Leaves (inches)

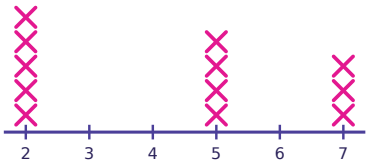

Task card 17 Line Plots

How many sticks were measured in all?

Lengths of Sticks (inches)

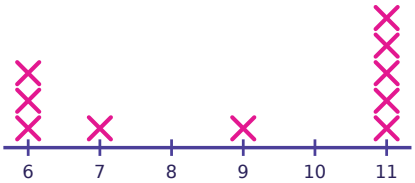

Task card 18 Line Plots

How many shells are longer than 6 inches?

Lengths of Shells (inches)

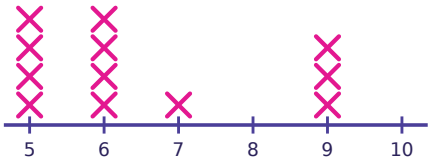

Task card 19 Line Plots

How many crayons are 9 inches long or shorter?

Lengths of Crayons (inches)

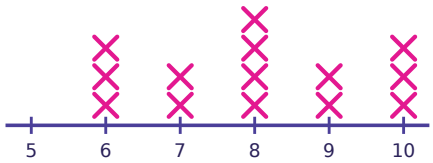

Task card 20 Line Plots

How many inches longer is the longest leaf than the shortest leaf?

Lengths of Leaves (inches)

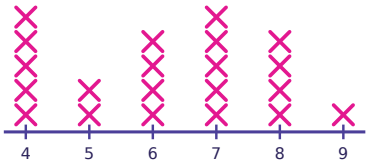

Task card 21 Line Plots

Which length, in inches, do the most crayons have?

Lengths of Crayons (inches)

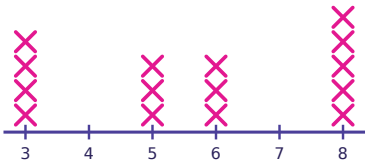

Task card 22 Line Plots

How many pencils are 8 inches long?

Lengths of Pencils (inches)

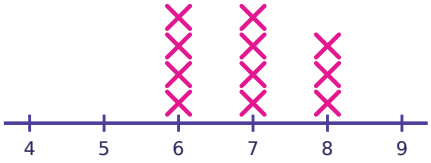

Task card 23 Line Plots

How many leaves were measured in all?

Lengths of Leaves (inches)

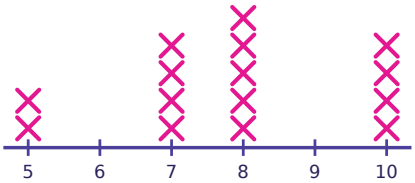

Task card 24 Line Plots

How many ribbons are longer than 7 inches?

Lengths of Ribbons (inches)

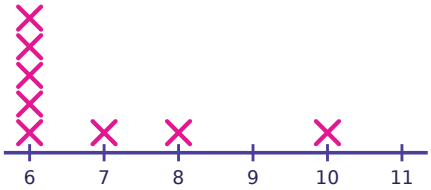

Line Plots Task Cards

Recording sheet · Grade 2 · Each X stands for one object that was measured. Use the line plot to answer.

Name: _____ Date: _____

Scan to check your answers

1	2	3	4
5	6	7	8
9	10	11	12
13	14	15	16
17	18	19	20
21	22	23	24

Line Plots Task Cards: Answer Key

Grade 2 · Medium

The answers online

1. 5	**2.** 3	**3.** 15
4. 11	**5.** 11	**6.** 2
7. 9	**8.** 6	**9.** 5
10. 4	**11.** 2	**12.** 25
13. 0	**14.** 11	**15.** 5
16. 2	**17.** 10	**18.** 4
19. 11	**20.** 5	**21.** 8
22. 3	**23.** 15	**24.** 2