Line Plots · 1

How many leaves are 7 inches long or shorter?



Line Plots · 2

How many inches longer is the longest shell than the shortest shell?

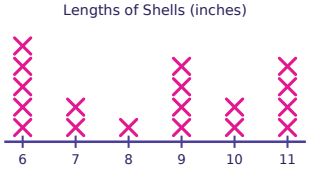

Line Plots · 3

Which length, in inches, do the most sticks have?

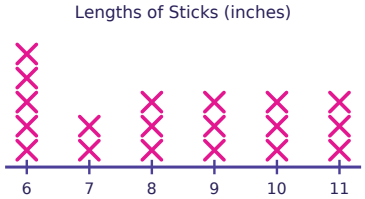

Line Plots · 4

How many leaves are 8 inches long?



Line Plots · 5

How many pencils were measured in all?

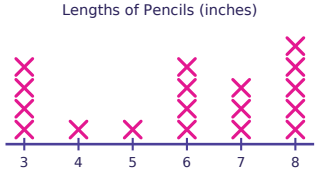

Line Plots · 6

How many crayons are longer than 7 inches?

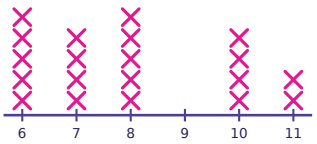

Line Plots · 7

How many crayons are 8 inches long or shorter?

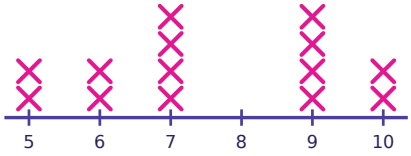

Line Plots · 8

How many inches longer is the longest ribbon than the shortest ribbon?

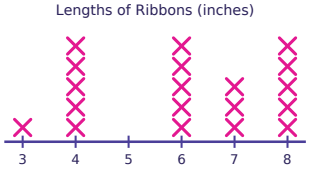

Line Plots · 2

ANSWER

5

Line Plots · 1

ANSWER

8

Line Plots · 4

ANSWER

3

Line Plots · 3

ANSWER

6

Line Plots · 6

ANSWER

11

Line Plots · 5

ANSWER

18

Line Plots · 8

ANSWER

5

Line Plots · 7

ANSWER

8

Line Plots · 9

How many shells are 9 inches long or shorter?

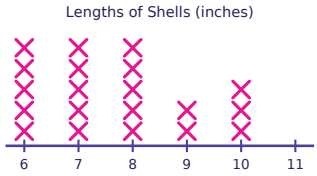

Line Plots · 10

How many inches longer is the longest pencil than the shortest pencil?

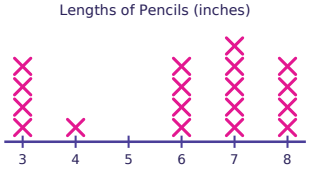

Line Plots · 11

Which length, in inches, do the most pencils have?

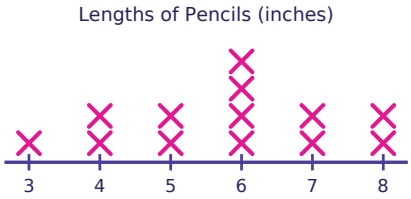

Line Plots · 12

How many ribbons are 3 inches long?

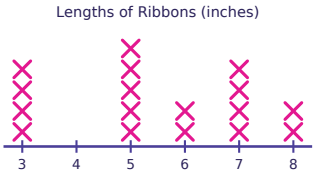

Line Plots · 13

How many leaves were measured in all?



Line Plots · 14

How many sticks are longer than 4 inches?

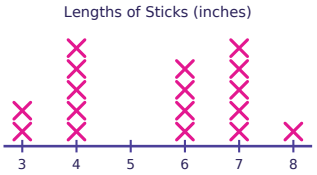

Line Plots · 15

How many shells are 5 inches long or shorter?

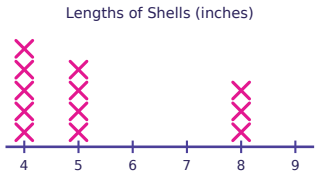

Line Plots · 16

How many inches longer is the longest pencil than the shortest pencil?

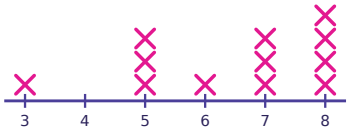

Line Plots · 10

ANSWER

5

Line Plots · 9

ANSWER

17

Line Plots · 12

ANSWER

4

Line Plots · 11

ANSWER

6

Line Plots · 14

ANSWER

10

Line Plots · 13

ANSWER

25

Line Plots · 16

ANSWER

5

Line Plots · 15

ANSWER

9

Line Plots · 17

How many pencils are 2 inches long?

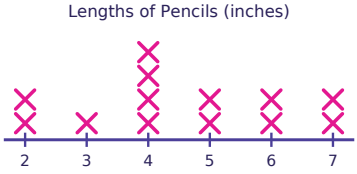

Line Plots · 18

How many leaves were measured in all?

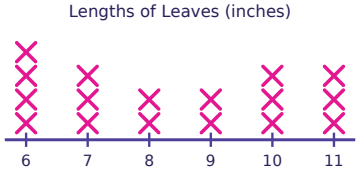

Line Plots · 19

How many ribbons are longer than 4 inches?

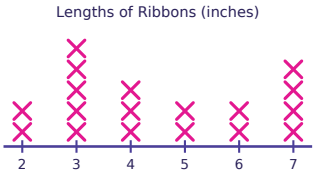

Line Plots · 20

How many pencils are 7 inches long or shorter?

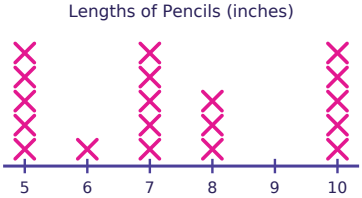

Line Plots · 21

How many inches longer is the longest shell than the shortest shell?

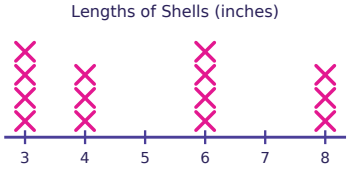

Line Plots · 22

Which length, in inches, do the most leaves have?

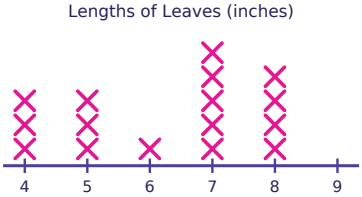

Line Plots · 23

How many ribbons are 4 inches long?

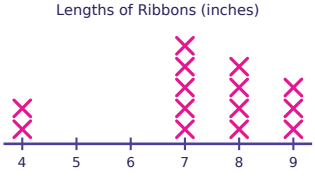

Line Plots · 24

How many pencils were measured in all?

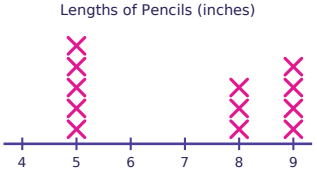

Line Plots · 18

ANSWER

17

Line Plots · 17

ANSWER

2

Line Plots · 20

ANSWER

11

Line Plots · 19

ANSWER

8

Line Plots · 22

ANSWER

7

Line Plots · 21

ANSWER

5

Line Plots · 24

ANSWER

12

Line Plots · 23

ANSWER

2