Line Plots · 1

Which length, in inches, do the most shells have?

Lengths of Shells (inches)

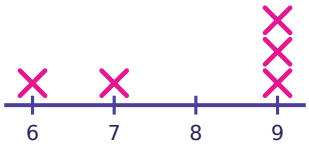

Line Plots · 2

How many sticks are 4 inches long?

Lengths of Sticks (inches)

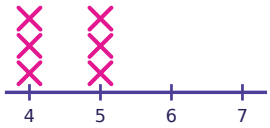

Line Plots · 3

How many leaves are 8 inches long?

Lengths of Leaves (inches)

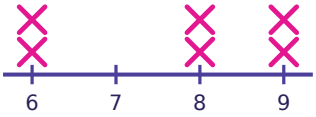

Line Plots · 4

How many sticks were measured in all?

Lengths of Sticks (inches)

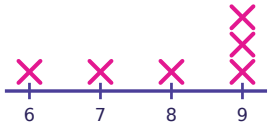

Line Plots · 5

Which length, in inches, do the most leaves have?

Lengths of Leaves (inches)

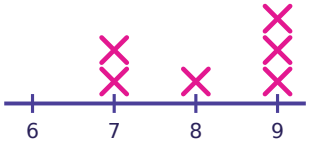

Line Plots · 6

How many crayons are 6 inches long?

Lengths of Crayons (inches)

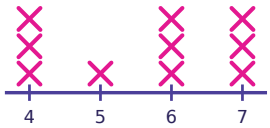

Line Plots · 7

How many shells are 6 inches long?

Lengths of Shells (inches)

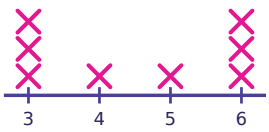

Line Plots · 8

How many pencils were measured in all?

Lengths of Pencils (inches)

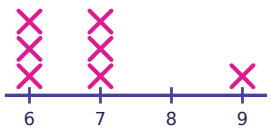

Line Plots · 2

ANSWER

3

Line Plots · 1

ANSWER

9

Line Plots · 4

ANSWER

6

Line Plots · 3

ANSWER

2

Line Plots · 6

ANSWER

3

Line Plots · 5

ANSWER

9

Line Plots · 8

ANSWER

7

Line Plots · 7

ANSWER

3

Line Plots · 9

How many shells were measured in all?

Lengths of Shells (inches)

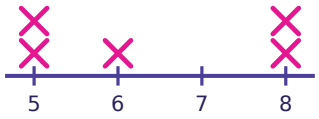

Line Plots · 10

Which length, in inches, do the most sticks have?

Lengths of Sticks (inches)

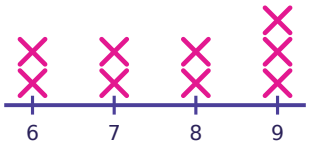

Line Plots · 11

How many shells are 5 inches long?

Lengths of Shells (inches)

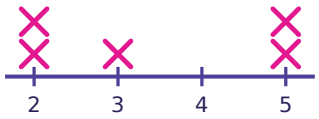

Line Plots · 12

How many ribbons are 4 inches long?

Lengths of Ribbons (inches)

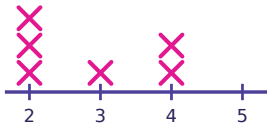

Line Plots · 13

How many shells were measured in all?

Lengths of Shells (inches)

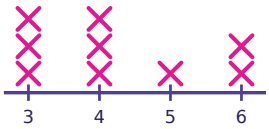

Line Plots · 14

Which length, in inches, do the most crayons have?

Lengths of Crayons (inches)

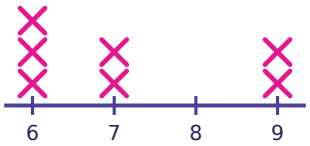

Line Plots · 15

How many leaves are 8 inches long?

Lengths of Leaves (inches)

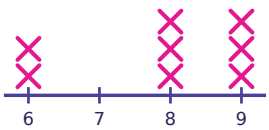

Line Plots · 16

How many ribbons are 5 inches long?

Lengths of Ribbons (inches)

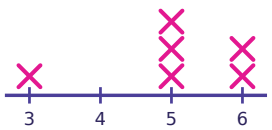

Line Plots · 10

ANSWER

9

Line Plots · 9

ANSWER

5

Line Plots · 12

ANSWER

2

Line Plots · 11

ANSWER

2

Line Plots · 14

ANSWER

6

Line Plots · 13

ANSWER

9

Line Plots · 16

ANSWER

3

Line Plots · 15

ANSWER

3

Line Plots · 17

How many ribbons were measured in all?

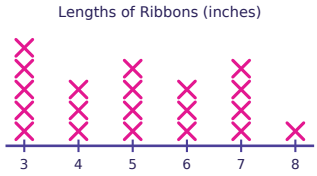

Line Plots · 18

Which length, in inches, do the most shells have?

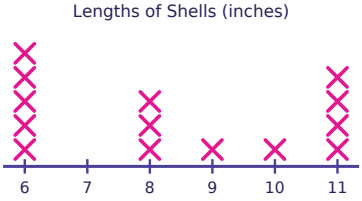

Line Plots · 19

How many pencils are longer than 5 inches?

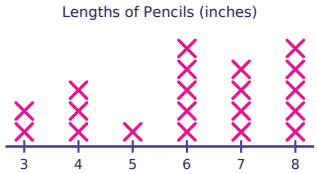

Line Plots · 20

How many shells are 9 inches long?

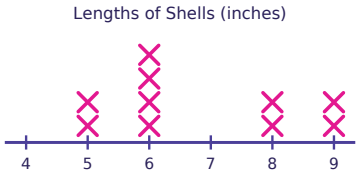

Line Plots · 21

How many sticks were measured in all?

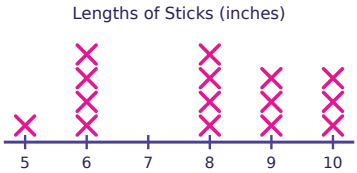

Line Plots · 22

Which length, in inches, do the most ribbons have?

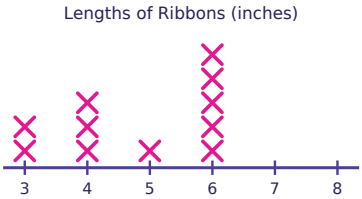

Line Plots · 23

How many pencils are longer than 9 inches?

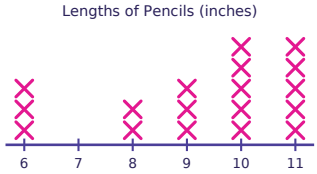

Line Plots · 24

How many leaves are 5 inches long?



Line Plots · 18

ANSWER

6

Line Plots · 17

ANSWER

20

Line Plots · 20

ANSWER

2

Line Plots · 19

ANSWER

14

Line Plots · 22

ANSWER

6

Line Plots · 21

ANSWER

15

Line Plots · 24

ANSWER

5

Line Plots · 23

ANSWER

10