Task card 1 Hundreds, Tens & Ones

What number do the blocks show?



Task card 2 Hundreds, Tens & Ones

What number do the blocks show?



Task card 3 Hundreds, Tens & Ones

What number do the blocks show?



Task card 4 Hundreds, Tens & Ones

How many ones cubes are in the picture?

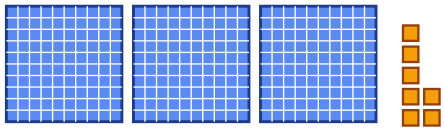

Task card 5 Hundreds, Tens & Ones

4 hundreds, 7 tens and 5 ones make ___

Task card 6 Hundreds, Tens & Ones

656 = ___ hundreds, 5 tens, 6 ones. Fill in the blank.

Task card 7 Hundreds, Tens & Ones

Which digit is in the tens place of 563?

Task card 8 Hundreds, Tens & Ones

I have 4 hundreds, 0 tens and 8 ones. What number am I?

Task card 9 Hundreds, Tens & Ones

What number do the blocks show?

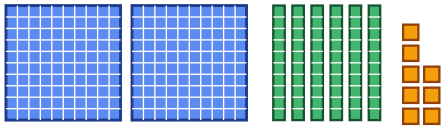

Task card 10 Hundreds, Tens & Ones

What number do the blocks show?

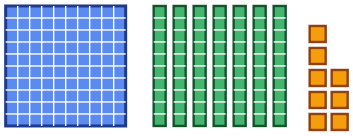

Task card 11 Hundreds, Tens & Ones

How many tens rods are in the picture?

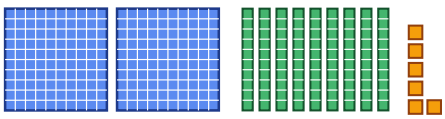

Task card 12 Hundreds, Tens & Ones

3 hundreds, 5 tens and 4 ones make ___

Task card 13 Hundreds, Tens & Ones

405 = ___ hundreds, 0 tens, 5 ones. Fill in the blank.

Task card 14 Hundreds, Tens & Ones

Which digit is in the ones place of 754?

Task card 15 Hundreds, Tens & Ones

What number is 5 hundreds, 10 tens and 2 ones?

Task card 16 Hundreds, Tens & Ones

How many tens are in 300?

Task card 17 Hundreds, Tens & Ones

What number do the blocks show?

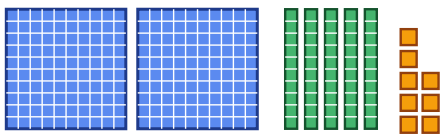

Task card 18 Hundreds, Tens & Ones

What number do the blocks show?

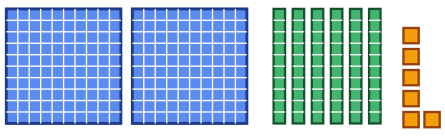

Task card 19 Hundreds, Tens & Ones

There are more than 9 tens rods. Ten rods make one hundred. What number do the blocks show?



Task card 20 Hundreds, Tens & Ones

How many hundreds squares are in the picture?

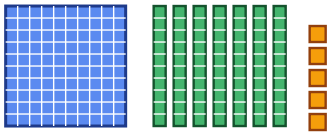

Task card 21 Hundreds, Tens & Ones

4 hundreds, 7 tens and 1 one make ___

Task card 22 Hundreds, Tens & Ones

782 = ___ hundreds, 8 tens, 2 ones. Fill in the blank.

Task card 23 Hundreds, Tens & Ones

What number is 8 hundreds, 11 tens and 4 ones?

Task card 24 Hundreds, Tens & Ones

How many tens are in 200?

Hundreds, Tens & Ones Task Cards

Recording sheet · Grade 2 · Each big square is 100, each long rod is 10 and each small cube is 1. Answer each question about hundreds, tens and ones.

Name: _____ Date: _____

Scan to check your answers

1	2	3	4
5	6	7	8
9	10	11	12
13	14	15	16
17	18	19	20
21	22	23	24

Hundreds, Tens & Ones Task Cards: Answer Key

Grade 2 · Medium

The answers online

1. 477	**2.** 518	**3.** 639
4. 7	**5.** 475	**6.** 6
7. 6	**8.** 408	**9.** 268
10. 178	**11.** 9	**12.** 354
13. 4	**14.** 4	**15.** 602
16. 30	**17.** 258	**18.** 266
19. 212	**20.** 1	**21.** 471
22. 7	**23.** 914	**24.** 20