Task card 1 Hundreds, Tens & Ones

What number do the blocks show?

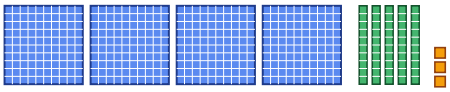

Task card 2 Hundreds, Tens & Ones

What number do the blocks show?

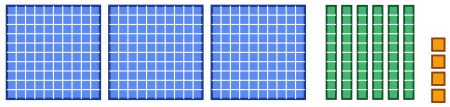

Task card 3 Hundreds, Tens & Ones

There are more than 9 tens rods. Ten rods make one hundred. What number do the blocks show?

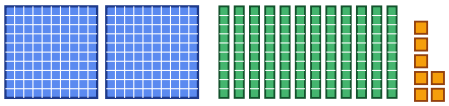

Task card 4 Hundreds, Tens & Ones

How many ones cubes are in the picture?



Task card 5 Hundreds, Tens & Ones

1 hundred, 0 tens and 5 ones make ___

Task card 6 Hundreds, Tens & Ones

112 = 1 hundred, 1 ten, ___ ones. Fill in the blank.

Task card 7 Hundreds, Tens & Ones

What number is 7 hundreds, 14 tens and 5 ones?

Task card 8 Hundreds, Tens & Ones

How many tens are in 900?

Task card 9 Hundreds, Tens & Ones

What number do the blocks show?

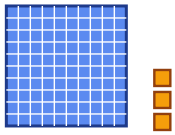

Task card 10 Hundreds, Tens & Ones

What number do the blocks show?

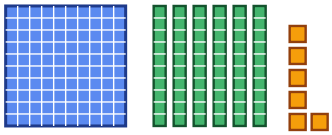

Task card 11 Hundreds, Tens & Ones

There are more than 9 tens rods. Ten rods make one hundred. What number do the blocks show?



Task card 12 Hundreds, Tens & Ones

How many hundreds squares are in the picture?

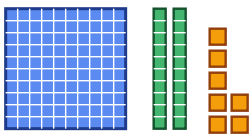

Task card 13 Hundreds, Tens & Ones

7 hundreds, 4 tens and 4 ones make ___

Task card 14 Hundreds, Tens & Ones

449 = 4 hundreds, 4 tens, ___ ones. Fill in the blank.

Task card 15 Hundreds, Tens & Ones

What number is 1 hundred, 11 tens and 2 ones?

Task card 16 Hundreds, Tens & Ones

How many tens are in 300?

Task card 17 Hundreds, Tens & Ones

What number do the blocks show?



Task card 18 Hundreds, Tens & Ones

What number do the blocks show?



Task card 19 Hundreds, Tens & Ones

There are more than 9 tens rods. Ten rods make one hundred. What number do the blocks show?

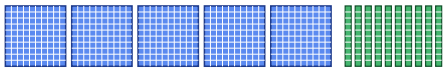

Task card 20 Hundreds, Tens & Ones

How many hundreds squares are in the picture?



Task card 21 Hundreds, Tens & Ones

3 hundreds, 4 tens and 3 ones make ___

Task card 22 Hundreds, Tens & Ones

434 = 4 hundreds, ___ tens, 4 ones. Fill in the blank.

Task card 23 Hundreds, Tens & Ones

What number is 4 hundreds, 16 tens and 3 ones?

Task card 24 Hundreds, Tens & Ones

How many tens are in 100?

Hundreds, Tens & Ones Task Cards

Recording sheet · Grade 2 · Each big square is 100, each long rod is 10 and each small cube is 1. Answer each question about hundreds, tens and ones.

Name: _____ Date: _____

Scan to check your answers

1	2	3	4
5	6	7	8
9	10	11	12
13	14	15	16
17	18	19	20
21	22	23	24

Hundreds, Tens & Ones Task Cards: Answer Key

Grade 2 · Hard

The answers online

1. 453	**2.** 364	**3.** 327
4. 7	**5.** 105	**6.** 2
7. 845	**8.** 90	**9.** 103
10. 166	**11.** 534	**12.** 1
13. 744	**14.** 9	**15.** 212
16. 30	**17.** 110	**18.** 619
19. 600	**20.** 2	**21.** 343
22. 3	**23.** 563	**24.** 10