Hundreds, Tens & Ones · 1

What number do the blocks show?

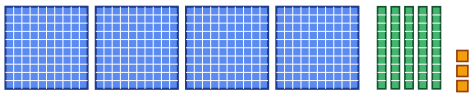

Hundreds, Tens & Ones · 2

What number do the blocks show?



Hundreds, Tens & Ones · 3

There are more than 9 tens rods. Ten rods make one hundred. What number do the blocks show?

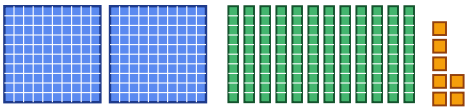

Hundreds, Tens & Ones · 4

How many ones cubes are in the picture?

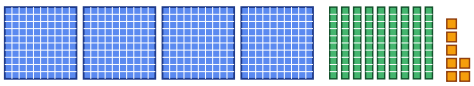

Hundreds, Tens & Ones · 5

1 hundred, 0 tens and 5 ones make ___

Hundreds, Tens & Ones · 6

112 = 1 hundred, 1 ten, ___ ones. Fill in the blank.

Hundreds, Tens & Ones · 7

What number is 7 hundreds, 14 tens and 5 ones?

Hundreds, Tens & Ones · 8

How many tens are in 900?

Hundreds, Tens & Ones · 2

ANSWER

364

Hundreds, Tens & Ones · 1

ANSWER

453

Hundreds, Tens & Ones · 4

ANSWER

7

Hundreds, Tens & Ones · 3

ANSWER

327

Hundreds, Tens & Ones · 6

ANSWER

2

Hundreds, Tens & Ones · 5

ANSWER

105

Hundreds, Tens & Ones · 8

ANSWER

90

Hundreds, Tens & Ones · 7

ANSWER

845

Hundreds, Tens & Ones · 9

What number do the blocks show?

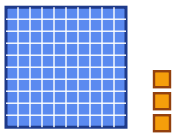

Hundreds, Tens & Ones · 10

What number do the blocks show?

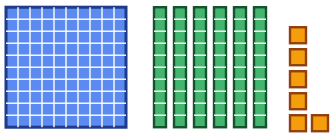

Hundreds, Tens & Ones · 11

There are more than 9 tens rods. Ten rods make one hundred. What number do the blocks show?



Hundreds, Tens & Ones · 12

How many hundreds squares are in the picture?

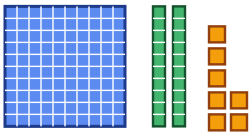

Hundreds, Tens & Ones · 13

7 hundreds, 4 tens and 4 ones make ___

Hundreds, Tens & Ones · 14

449 = 4 hundreds, 4 tens, ___ ones. Fill in the blank.

Hundreds, Tens & Ones · 15

What number is 1 hundred, 11 tens and 2 ones?

Hundreds, Tens & Ones · 16

How many tens are in 300?

Hundreds, Tens & Ones · 10

ANSWER

166

Hundreds, Tens & Ones · 9

ANSWER

103

Hundreds, Tens & Ones · 12

ANSWER

1

Hundreds, Tens & Ones · 11

ANSWER

534

Hundreds, Tens & Ones · 14

ANSWER

9

Hundreds, Tens & Ones · 13

ANSWER

744

Hundreds, Tens & Ones · 16

ANSWER

30

Hundreds, Tens & Ones · 15

ANSWER

212

Hundreds, Tens & Ones · 17

What number do the blocks show?



Hundreds, Tens & Ones · 18

What number do the blocks show?

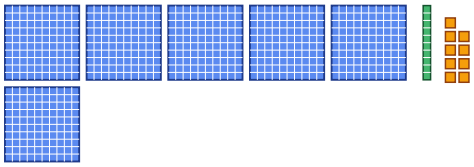

Hundreds, Tens & Ones · 19

There are more than 9 tens rods. Ten rods make one hundred. What number do the blocks show?



Hundreds, Tens & Ones · 20

How many hundreds squares are in the picture?



Hundreds, Tens & Ones · 21

3 hundreds, 4 tens and 3 ones make ___

Hundreds, Tens & Ones · 22

434 = 4 hundreds, ___ tens, 4 ones. Fill in the blank.

Hundreds, Tens & Ones · 23

What number is 4 hundreds, 16 tens and 3 ones?

Hundreds, Tens & Ones · 24

How many tens are in 100?

Hundreds, Tens & Ones · 18

ANSWER

619

Hundreds, Tens & Ones · 17

ANSWER

110

Hundreds, Tens & Ones · 20

ANSWER

2

Hundreds, Tens & Ones · 19

ANSWER

600

Hundreds, Tens & Ones · 22

ANSWER

3

Hundreds, Tens & Ones · 21

ANSWER

343

Hundreds, Tens & Ones · 24

ANSWER

10

Hundreds, Tens & Ones · 23

ANSWER

563