Hundreds, Tens & Ones · 1

What number do the blocks show?



Hundreds, Tens & Ones · 2

What number do the blocks show?



Hundreds, Tens & Ones · 3

What number do the blocks show?

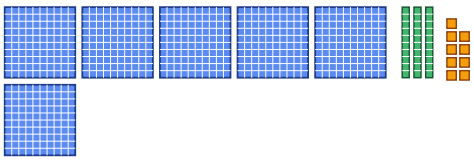

Hundreds, Tens & Ones · 4

How many ones cubes are in the picture?

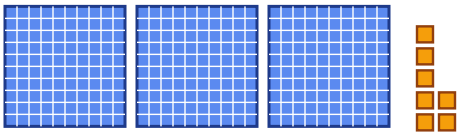

Hundreds, Tens & Ones · 5

4 hundreds, 7 tens and 5 ones make ___

Hundreds, Tens & Ones · 6

656 = ___ hundreds, 5 tens, 6 ones. Fill in the blank.

Hundreds, Tens & Ones · 7

Which digit is in the tens place of 563?

Hundreds, Tens & Ones · 8

I have 4 hundreds, 0 tens and 8 ones. What number am I?

Hundreds, Tens & Ones · 2

ANSWER

518

Hundreds, Tens & Ones · 1

ANSWER

477

Hundreds, Tens & Ones · 4

ANSWER

7

Hundreds, Tens & Ones · 3

ANSWER

639

Hundreds, Tens & Ones · 6

ANSWER

6

Hundreds, Tens & Ones · 5

ANSWER

475

Hundreds, Tens & Ones · 8

ANSWER

408

Hundreds, Tens & Ones · 7

ANSWER

6

What number do the blocks show?

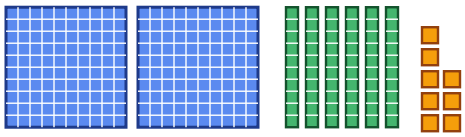

What number do the blocks show?

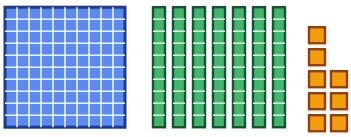

How many tens rods are in the picture?

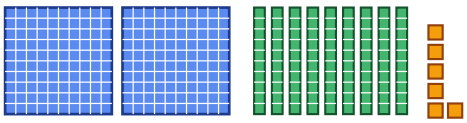

3 hundreds, 5 tens and 4 ones make ___

405 = ___ hundreds, 0 tens, 5 ones. Fill in the blank.

Which digit is in the ones place of 754?

What number is 5 hundreds, 10 tens and 2 ones?

How many tens are in 300?

Hundreds, Tens & Ones · 10

ANSWER

178

Hundreds, Tens & Ones · 9

ANSWER

268

Hundreds, Tens & Ones · 12

ANSWER

354

Hundreds, Tens & Ones · 11

ANSWER

9

Hundreds, Tens & Ones · 14

ANSWER

4

Hundreds, Tens & Ones · 13

ANSWER

4

Hundreds, Tens & Ones · 16

ANSWER

30

Hundreds, Tens & Ones · 15

ANSWER

602

Hundreds, Tens & Ones · 17

What number do the blocks show?

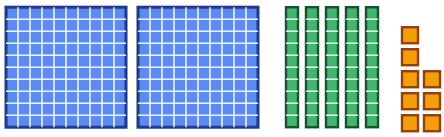

Hundreds, Tens & Ones · 18

What number do the blocks show?

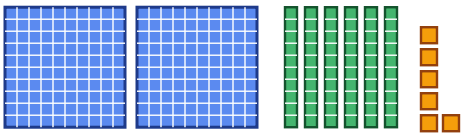

Hundreds, Tens & Ones · 19

There are more than 9 tens rods. Ten rods make one hundred. What number do the blocks show?



Hundreds, Tens & Ones · 20

How many hundreds squares are in the picture?

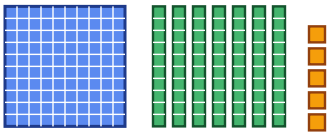

Hundreds, Tens & Ones · 21

4 hundreds, 7 tens and 1 one make ___

Hundreds, Tens & Ones · 22

782 = ___ hundreds, 8 tens, 2 ones. Fill in the blank.

Hundreds, Tens & Ones · 23

What number is 8 hundreds, 11 tens and 4 ones?

Hundreds, Tens & Ones · 24

How many tens are in 200?

Hundreds, Tens & Ones · 18

ANSWER

266

Hundreds, Tens & Ones · 17

ANSWER

258

Hundreds, Tens & Ones · 20

ANSWER

1

Hundreds, Tens & Ones · 19

ANSWER

212

Hundreds, Tens & Ones · 22

ANSWER

7

Hundreds, Tens & Ones · 21

ANSWER

471

Hundreds, Tens & Ones · 24

ANSWER

20

Hundreds, Tens & Ones · 23

ANSWER

914