Hundreds, Tens & Ones · 1

What number do the blocks show?

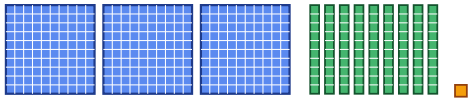

Hundreds, Tens & Ones · 2

What number do the blocks show?

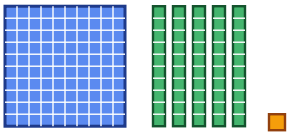

Hundreds, Tens & Ones · 3

What number do the blocks show?

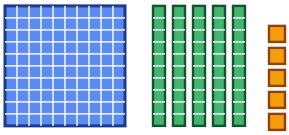

Hundreds, Tens & Ones · 4

How many hundreds squares are in the picture?

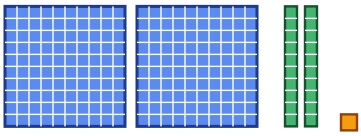

Hundreds, Tens & Ones · 5

1 hundred, 9 tens and 5 ones make ___

Hundreds, Tens & Ones · 6

115 = 1 hundred, 1 ten, ___ ones. Fill in the blank.

Hundreds, Tens & Ones · 7

Which digit is in the tens place of 391?

Hundreds, Tens & Ones · 8

I have 3 hundreds, 9 tens and 0 ones. What number am I?

Hundreds, Tens & Ones · 2

ANSWER

151

Hundreds, Tens & Ones · 1

ANSWER

391

Hundreds, Tens & Ones · 4

ANSWER

2

Hundreds, Tens & Ones · 3

ANSWER

155

Hundreds, Tens & Ones · 6

ANSWER

5

Hundreds, Tens & Ones · 5

ANSWER

195

Hundreds, Tens & Ones · 8

ANSWER

390

Hundreds, Tens & Ones · 7

ANSWER

9

Hundreds, Tens & Ones · 9

What number do the blocks show?

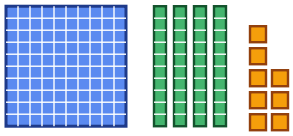

Hundreds, Tens & Ones · 10

What number do the blocks show?

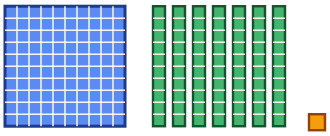

Hundreds, Tens & Ones · 11

What number do the blocks show?

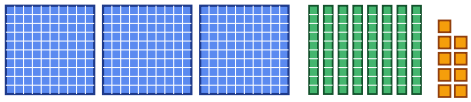

Hundreds, Tens & Ones · 12

How many tens rods are in the picture?

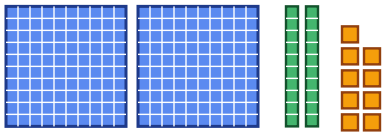

Hundreds, Tens & Ones · 13

1 hundred, 5 tens and 5 ones make ___

Hundreds, Tens & Ones · 14

402 = 4 hundreds, 0 tens, ___ ones. Fill in the blank.

Hundreds, Tens & Ones · 15

Which digit is in the tens place of 138?

Hundreds, Tens & Ones · 16

I have 2 hundreds, 0 tens and 6 ones. What number am I?

Hundreds, Tens & Ones · 10

ANSWER

171

Hundreds, Tens & Ones · 9

ANSWER

148

Hundreds, Tens & Ones · 12

ANSWER

2

Hundreds, Tens & Ones · 11

ANSWER

389

Hundreds, Tens & Ones · 14

ANSWER

2

Hundreds, Tens & Ones · 13

ANSWER

155

Hundreds, Tens & Ones · 16

ANSWER

206

Hundreds, Tens & Ones · 15

ANSWER

3

Hundreds, Tens & Ones · 17

What number do the blocks show?

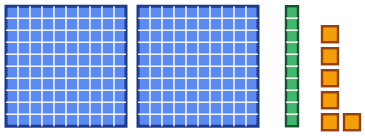

Hundreds, Tens & Ones · 18

What number do the blocks show?



Hundreds, Tens & Ones · 19

What number do the blocks show?

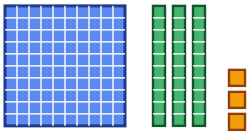

Hundreds, Tens & Ones · 20

How many ones cubes are in the picture?

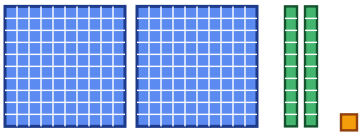

Hundreds, Tens & Ones · 21

4 hundreds, 7 tens and 3 ones make ___

Hundreds, Tens & Ones · 22

496 = 4 hundreds, ___ tens, 6 ones. Fill in the blank.

Hundreds, Tens & Ones · 23

Which digit is in the ones place of 387?

Hundreds, Tens & Ones · 24

I have 3 hundreds, 5 tens and 0 ones. What number am I?

Hundreds, Tens & Ones · 18

ANSWER

595

Hundreds, Tens & Ones · 17

ANSWER

216

Hundreds, Tens & Ones · 20

ANSWER

1

Hundreds, Tens & Ones · 19

ANSWER

133

Hundreds, Tens & Ones · 22

ANSWER

9

Hundreds, Tens & Ones · 21

ANSWER

473

Hundreds, Tens & Ones · 24

ANSWER

350

Hundreds, Tens & Ones · 23

ANSWER

7