**Task card 1** Halloween Math

The school bakes 47 spider cookies and 50 cupcakes for the bake sale. How many treats is that in all?

**Task card 2** Halloween Math

Sam buys a spider ring for 45¢ and a paper bat for 10¢. How many cents does Sam spend?

**Task card 3** Halloween Math

Ava puts 3 spider cookies on each of 2 plates. How many spider cookies is that in all?



**Task card 4** Halloween Math

The bakery makes 90 cupcakes. It sells 81 of them. How many cupcakes are left?

**Task card 5** Halloween Math

Lily puts 4 cupcakes on each of 4 plates. How many cupcakes is that in all?



**Task card 6** Halloween Math

The bakery makes 59 cupcakes. It sells 42 of them. How many cupcakes are left?

**Task card 7** Halloween Math

Noah buys a paper bat for 25¢ and a glow stick for 5¢. How many cents does Noah spend?

**Task card 8** Halloween Math

The school bakes 34 pumpkin muffins and 62 cupcakes for the bake sale. How many treats is that in all?

**Task card 9** Halloween Math

Mia puts 2 spider cookies on each of 4 plates. How many spider cookies is that in all?



**Task card 10** Halloween Math

Ava buys a paper bat for 15¢ and a spider ring for 40¢. How many cents does Ava spend?

**Task card 11** Halloween Math

The school bakes 59 pumpkin muffins and 50 spider cookies for the bake sale. How many treats is that in all?

**Task card 12** Halloween Math

Ava puts 4 pumpkin muffins on each of 3 plates. How many pumpkin muffins is that in all?



**Task card 13** Halloween Math

The school bakes 35 cupcakes and 54 pumpkin muffins for the bake sale. How many treats is that in all?

**Task card 14** Halloween Math

The bakery makes 271 pumpkin muffins. It sells 176 of them. How many pumpkin muffins are left?

**Task card 15** Halloween Math

Ava buys a paper bat for 25¢ and a glow stick for 15¢. How many cents does Ava spend?

**Task card 16** Halloween Math

The bakery makes 479 pumpkin muffins. It sells 378 of them. How many pumpkin muffins are left?

**Task card 17** Halloween Math

The bakery makes 408 pumpkin muffins. It sells 278 of them. How many pumpkin muffins are left?

**Task card 18** Halloween Math

The bakery makes 221 cupcakes. It sells 39 of them. How many cupcakes are left?

**Task card 19** Halloween Math

The school bakes 137 cupcakes and 104 pumpkin muffins for the bake sale. How many treats is that in all?

**Task card 20** Halloween Math

Lily puts 3 cupcakes on each of 5 plates. How many cupcakes is that in all?



**Task card 21** Halloween Math

The school bakes 226 spider cookies and 174 pumpkin muffins for the bake sale. How many treats is that in all?

**Task card 22** Halloween Math

Ben puts 4 spider cookies on each of 5 plates. How many spider cookies is that in all?



**Task card 23** Halloween Math

Zoe buys a spider ring for 15¢ and a paper bat for 45¢. How many cents does Zoe spend?

**Task card 24** Halloween Math

Ava buys a paper bat for 45¢ and a glow stick for 30¢. How many cents does Ava spend?

# Halloween Math Task Cards

Recording sheet · Grade 2 · Read each story and solve.

Name: _____ Date: _____

Scan to check your answers

| | | | |
|---|---|---|---|
| 1 | 2 | 3 | 4 |
| 5 | 6 | 7 | 8 |
| 9 | 10 | 11 | 12 |
| 13 | 14 | 15 | 16 |
| 17 | 18 | 19 | 20 |
| 21 | 22 | 23 | 24 |

# Halloween Math Task Cards: Answer Key

Grade 2 · Medium

The answers online

| | | |
|---|---|---|
| **1.** 97 | **2.** 55 | **3.** 6 |
| **4.** 9 | **5.** 16 | **6.** 17 |
| **7.** 30 | **8.** 96 | **9.** 8 |
| **10.** 55 | **11.** 109 | **12.** 12 |
| **13.** 89 | **14.** 95 | **15.** 40 |
| **16.** 101 | **17.** 130 | **18.** 182 |
| **19.** 241 | **20.** 15 | **21.** 400 |
| **22.** 20 | **23.** 60 | **24.** 75 |