Task card 1 Halloween Math

The school bakes 47 spider cookies and 50 cupcakes for the bake sale. How many treats is that in all?

Task card 2 Halloween Math

Sam buys a spider ring for 45¢ and a paper bat for 10¢. How many cents does Sam spend?

Task card 3 Halloween Math

Ava puts 3 spider cookies on each of 2 plates. How many spider cookies is that in all?



Task card 4 Halloween Math

The bakery makes 90 cupcakes. It sells 81 of them. How many cupcakes are left?

Task card 5 Halloween Math

Lily puts 4 cupcakes on each of 4 plates. How many cupcakes is that in all?



Task card 6 Halloween Math

The bakery makes 59 cupcakes. It sells 42 of them. How many cupcakes are left?

Task card 7 Halloween Math

Noah buys a paper bat for 25¢ and a glow stick for 5¢. How many cents does Noah spend?

Task card 8 Halloween Math

The school bakes 34 pumpkin muffins and 62 cupcakes for the bake sale. How many treats is that in all?

Task card 9 Halloween Math

Mia puts 2 spider cookies on each of 4 plates. How many spider cookies is that in all?



Task card 10 Halloween Math

Ava buys a paper bat for 15¢ and a spider ring for 40¢. How many cents does Ava spend?

Task card 11 Halloween Math

The school bakes 59 pumpkin muffins and 50 spider cookies for the bake sale. How many treats is that in all?

Task card 12 Halloween Math

Ava puts 4 pumpkin muffins on each of 3 plates. How many pumpkin muffins is that in all?



Task card 13 Halloween Math

The school bakes 35 cupcakes and 54 pumpkin muffins for the bake sale. How many treats is that in all?

Task card 14 Halloween Math

The bakery makes 271 pumpkin muffins. It sells 176 of them. How many pumpkin muffins are left?

Task card 15 Halloween Math

Ava buys a paper bat for 25¢ and a glow stick for 15¢. How many cents does Ava spend?

Task card 16 Halloween Math

The bakery makes 479 pumpkin muffins. It sells 378 of them. How many pumpkin muffins are left?

Task card 17 Halloween Math

The bakery makes 408 pumpkin muffins. It sells 278 of them. How many pumpkin muffins are left?

Task card 18 Halloween Math

The bakery makes 221 cupcakes. It sells 39 of them. How many cupcakes are left?

Task card 19 Halloween Math

The school bakes 137 cupcakes and 104 pumpkin muffins for the bake sale. How many treats is that in all?

Task card 20 Halloween Math

Lily puts 3 cupcakes on each of 5 plates. How many cupcakes is that in all?



Task card 21 Halloween Math

The school bakes 226 spider cookies and 174 pumpkin muffins for the bake sale. How many treats is that in all?

Task card 22 Halloween Math

Ben puts 4 spider cookies on each of 5 plates. How many spider cookies is that in all?



Task card 23 Halloween Math

Zoe buys a spider ring for 15¢ and a paper bat for 45¢. How many cents does Zoe spend?

Task card 24 Halloween Math

Ava buys a paper bat for 45¢ and a glow stick for 30¢. How many cents does Ava spend?

Halloween Math Task Cards

Recording sheet · Grade 2 · Read each story and solve.

Name: _____ Date: _____

Scan to check your answers

1	2	3	4
5	6	7	8
9	10	11	12
13	14	15	16
17	18	19	20
21	22	23	24

Halloween Math Task Cards: Answer Key

Grade 2 · Medium

The answers online

1. 97	**2.** 55	**3.** 6
4. 9	**5.** 16	**6.** 17
7. 30	**8.** 96	**9.** 8
10. 55	**11.** 109	**12.** 12
13. 89	**14.** 95	**15.** 40
16. 101	**17.** 130	**18.** 182
19. 241	**20.** 15	**21.** 400
22. 20	**23.** 60	**24.** 75