Halloween Math · 1

The bakery makes 425 spider cookies. It sells 414 of them. How many spider cookies are left?

Halloween Math · 2

The school bakes 29 cupcakes and 202 pumpkin muffins for the bake sale. How many treats is that in all?

Halloween Math · 3

Ben puts 4 pumpkin muffins on each of 4 plates. How many pumpkin muffins is that in all?



Halloween Math · 4

Noah buys a spider ring for 25¢ and a glow stick for 50¢. How many cents does Noah spend?

Halloween Math · 5

Omar puts 4 cupcakes on each of 2 plates. How many cupcakes is that in all?



Halloween Math · 6

The school bakes 104 pumpkin muffins and 353 cupcakes for the bake sale. How many treats is that in all?

Halloween Math · 7

Ben buys a paper bat for 45¢ and a glow stick for 35¢. How many cents does Ben spend?

Halloween Math · 8

The bakery makes 426 cupcakes. It sells 53 of them. How many cupcakes are left?

Halloween Math · 2

ANSWER

231

Halloween Math · 1

ANSWER

11

Halloween Math · 4

ANSWER

75

Halloween Math · 3

ANSWER

16

Halloween Math · 6

ANSWER

457

Halloween Math · 5

ANSWER

8

Halloween Math · 8

ANSWER

373

Halloween Math · 7

ANSWER

80

Halloween Math · 9

Ben buys a paper bat for 30¢ and a spider ring for 5¢. How many cents does Ben spend?

Halloween Math · 10

The bakery makes 427 spider cookies. It sells 204 of them. How many spider cookies are left?

Halloween Math · 11

The school bakes 105 cupcakes and 79 spider cookies for the bake sale. How many treats is that in all?

Halloween Math · 12

The bakery makes 381 spider cookies. It sells 184 of them. How many spider cookies are left?

Halloween Math · 13

Sam puts 4 pumpkin muffins on each of 4 plates. How many pumpkin muffins is that in all?



Halloween Math · 14

Omar puts 3 cupcakes on each of 4 plates. How many cupcakes is that in all?



Halloween Math · 15

The school bakes 88 pumpkin muffins and 138 spider cookies for the bake sale. How many treats is that in all?

Halloween Math · 16

Ella buys a spider ring for 30¢ and a glow stick for 20¢. How many cents does Ella spend?

Halloween Math · 10

ANSWER

223

Halloween Math · 9

ANSWER

35

Halloween Math · 12

ANSWER

197

Halloween Math · 11

ANSWER

184

Halloween Math · 14

ANSWER

12

Halloween Math · 13

ANSWER

16

Halloween Math · 16

ANSWER

50

Halloween Math · 15

ANSWER

226

Halloween Math · 17

Zoe puts 2 cupcakes on each of 5 plates. How many cupcakes is that in all?



Halloween Math · 18

Ella puts 4 cupcakes on each of 4 plates. How many cupcakes is that in all?



Halloween Math · 19

The school bakes 159 cupcakes and 66 pumpkin muffins for the bake sale. How many treats is that in all?

Halloween Math · 20

Zoe buys a glow stick for 45¢ and a spider ring for 25¢. How many cents does Zoe spend?

Halloween Math · 21

Mia buys a spider ring for 10¢ and a paper bat for 20¢. How many cents does Mia spend?

Halloween Math · 22

The bakery makes 346 pumpkin muffins. It sells 175 of them. How many pumpkin muffins are left?

Halloween Math · 23

The school bakes 215 cupcakes and 94 spider cookies for the bake sale. How many treats is that in all?

Halloween Math · 24

The bakery makes 97 spider cookies. It sells 47 of them. How many spider cookies are left?

Halloween Math · 18

ANSWER

16

Halloween Math · 17

ANSWER

10

Halloween Math · 20

ANSWER

70

Halloween Math · 19

ANSWER

225

Halloween Math · 22

ANSWER

171

Halloween Math · 21

ANSWER

30

Halloween Math · 24

ANSWER

50

Halloween Math · 23

ANSWER

309