Task card 1 Fractions Basics

What fraction of the bar is NOT shaded?



Task card 2 Fractions Basics

What fraction of the circle is shaded?



Task card 3 Fractions Basics

What fraction of the circle is shaded?

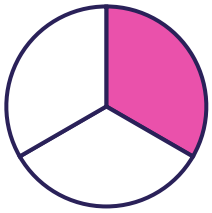

Task card 4 Fractions Basics

What fraction of the bar is shaded?



Task card 5 Fractions Basics

What fraction of the bar is shaded?



Task card 6 Fractions Basics

What fraction of the circle is NOT shaded?

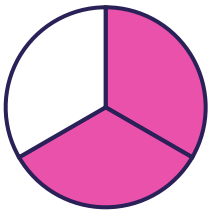

Task card 7 Fractions Basics

What fraction of the circle is NOT shaded?



Task card 8 Fractions Basics

What fraction of the circle is NOT shaded?



Task card 9 Fractions Basics

What fraction of the bar is shaded?



Task card 10 Fractions Basics

What fraction of the bar is shaded?



Task card 11 Fractions Basics

What fraction of the bar is NOT shaded?



Task card 12 Fractions Basics

What fraction of the bar is shaded?



Task card 13 Fractions Basics

What fraction of the circle is NOT shaded?



Task card 14 Fractions Basics

What fraction of the circle is shaded?



Task card 15 Fractions Basics

What fraction of the bar is NOT shaded?



Task card 16 Fractions Basics

What fraction of the circle is shaded?

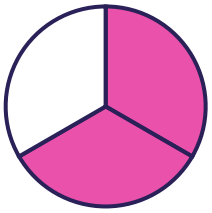

Task card 17 Fractions Basics

What fraction of the bar is NOT shaded?



Task card 18 Fractions Basics

What fraction of the circle is NOT shaded?

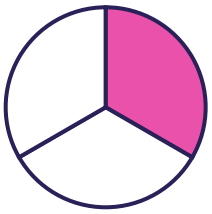

Task card 19 Fractions Basics

What fraction of the circle is shaded?



Task card 20 Fractions Basics

What fraction of the bar is NOT shaded?



Fractions Basics Task Cards

Recording sheet · Grade 2 · Answer each question.

Name: _____ Date: _____

Scan to check your answers

1	2	3	4
5	6	7	8
9	10	11	12
13	14	15	16
17	18	19	20

Fractions Basics Task Cards: Answer Key

Grade 2 · Hard

The answers online

1. $\frac{1}{3}$	**2.** $\frac{1}{4}$	**3.** $\frac{1}{3}$
4. $\frac{1}{4}$	**5.** $\frac{1}{3}$	**6.** $\frac{1}{3}$
7. $\frac{1}{4}$	**8.** $\frac{3}{4}$	**9.** $\frac{2}{4}$
10. $\frac{3}{4}$	**11.** $\frac{1}{4}$	**12.** $\frac{2}{3}$
13. $\frac{2}{4}$	**14.** $\frac{3}{4}$	**15.** $\frac{2}{4}$
16. $\frac{2}{3}$	**17.** $\frac{2}{3}$	**18.** $\frac{2}{3}$
19. $\frac{2}{4}$	**20.** $\frac{3}{4}$	