Task card 1 Fact Families

The two parts make the whole. What is the missing number?

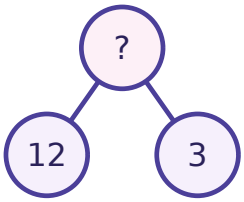

Task card 2 Fact Families

The two parts make the whole. What is the missing number?

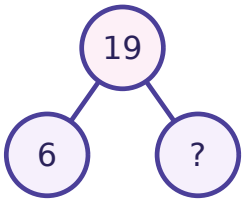

Task card 3 Fact Families

$4 + 12 = 16$, so

$16 - 12 =$ ___

Task card 4 Fact Families

$21 - 8 = 13$, so

$13 + 8 =$ ___

Task card 5 Fact Families

Finish the fact family: $12 + 4 = 16$, $4 + 12 = 16$, $16 - 12 = 4$, $16 - 4 =$ ___

Task card 6 Fact Families

A fact family has three numbers. Two of them are 5 and 11, and 11 is the biggest. What is the third number?

Task card 7 Fact Families

The two parts make the whole. What is the missing number?

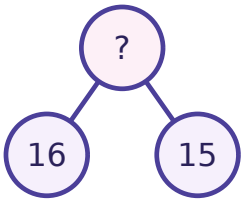

Task card 8 Fact Families

The two parts make the whole. What is the missing number?

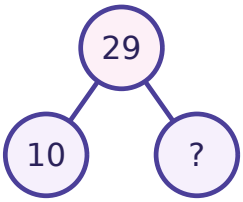

Task card 9 Fact Families

$13 + 18 = 31$, so $31 - 18 =$ ___

Task card 10 Fact Families

$23 - 17 = 6$, so $6 + 17 =$ ___

Task card 11 Fact Families

Finish the fact family: $18 + 17 = 35$, $17 + 18 = 35$, $35 - 18 = 17$, $35 - 17 =$ ___

Task card 12 Fact Families

A fact family has three numbers. Two of them are 17 and 28, and 28 is the biggest. What is the third number?

Task card 13 Fact Families

The two parts make the whole. What is the missing number?

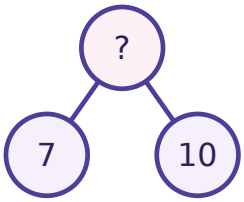

Task card 14 Fact Families

The two parts make the whole. What is the missing number?

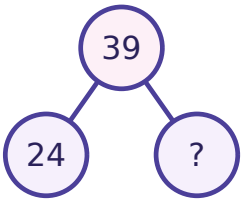

Task card 15 Fact Families

$24 + 7 = 31$, so $31 - 7 =$ ___

Task card 16 Fact Families

$36 - 11 = 25$, so $25 + 11 =$ ___

Task card 17 Fact Families

Finish the fact family: $23 + 9 = 32$, $9 + 23 = 32$, $32 - 23 = 9$, $32 - 9 =$ ___

Task card 18 Fact Families

A fact family has three numbers. Two of them are 8 and 22, and 22 is the biggest. What is the third number?

Task card 19 Fact Families

The two parts make the whole. What is the missing number?

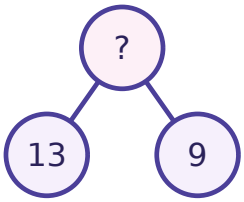

Task card 20 Fact Families

The two parts make the whole. What is the missing number?

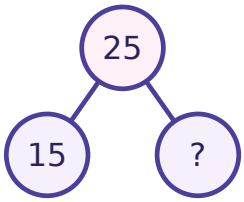

Task card 21 Fact Families

3 + 9 = 12, so 12 − 9 = ___

Task card 22 Fact Families

13 − 7 = 6, so 6 + 7 = ___

Task card 23 Fact Families

Finish the fact family: 5 + 14 = 19, 14 + 5 = 19, 19 − 5 = 14, 19 − 14 = ___

Task card 24 Fact Families

A fact family has three numbers. Two of them are 15 and 24, and 24 is the biggest. What is the third number?

Fact Families Task Cards

Recording sheet · Grade 2 · The facts in a family use the same three numbers. Write the four related facts, then use a family to answer each question.

Name: _____ Date: _____

Scan to check your answers

1	2	3	4
5	6	7	8
9	10	11	12
13	14	15	16
17	18	19	20
21	22	23	24

Fact Families Task Cards: Answer Key

Grade 2 · Easy

The answers online

1. 15	**2.** 13	**3.** 4
4. 21	**5.** 12	**6.** 6
7. 31	**8.** 19	**9.** 13
10. 23	**11.** 18	**12.** 11
13. 17	**14.** 15	**15.** 24
16. 36	**17.** 23	**18.** 14
19. 22	**20.** 10	**21.** 3
22. 13	**23.** 5	**24.** 9