Task card 1 Equal Groups & Arrays

There are 2 rows of 4. How many apples in all? Write the multiplication fact: 2 × 4 = ___



Task card 2 Equal Groups & Arrays

There are 2 rows of 4. How many balloons in all? Write the multiplication fact: 2 × 4 = ___



Task card 3 Equal Groups & Arrays

There are 3 rows of 4. How many hearts in all? Write the multiplication fact: 3 × 4 = ___



Task card 4 Equal Groups & Arrays

There are 4 rows of 3. How many apples in all? Write the multiplication fact: 4 × 3 = ___



Task card 5 Equal Groups & Arrays

There are 4 rows of 2. How many balloons in all? Write the multiplication fact: 4 × 2 = ___



Task card 6 Equal Groups & Arrays

There are 2 rows of 2. How many balloons in all? Write the multiplication fact: 2 × 2 = ___



Task card 7 Equal Groups & Arrays

There are 3 rows of 3. How many stars in all? Write the multiplication fact: 3 × 3 = ___



Task card 8 Equal Groups & Arrays

There are 2 rows of 2. How many apples in all? Write the multiplication fact: 2 × 2 = ___



Task card 9 Equal Groups & Arrays

There are 4 rows of 4. How many apples in all? Write the multiplication fact: 4 × 4 = ___



Task card 10 Equal Groups & Arrays

There are 4 rows of 2. How many stars in all? Write the multiplication fact: 4 × 2 = ___



Task card 11 Equal Groups & Arrays

There are 3 rows of 2. How many apples in all? Write the multiplication fact: 3 × 2 = ___



Task card 12 Equal Groups & Arrays

There are 4 rows of 4. How many balloons in all? Write the multiplication fact: 4 × 4 = ___



Task card 13 Equal Groups & Arrays

There are 4 rows of 4. How many stars in all? Write the multiplication fact: 4 × 4 = ___



Task card 14 Equal Groups & Arrays

There are 3 rows of 4. How many balloons in all? Write the multiplication fact: 3 × 4 = ___



Task card 15 Equal Groups & Arrays

There are 2 rows of 4. How many hearts in all? Write the multiplication fact: 2 × 4 = ___



Task card 16 Equal Groups & Arrays

There are 3 rows of 3. How many hearts in all? Write the multiplication fact: 3 × 3 = ___



Task card 17 Equal Groups & Arrays

There are 3 rows of 3. How many balloons in all? Write the multiplication fact: 3 × 3 = ___



Task card 18 Equal Groups & Arrays

There are 3 rows of 2. How many stars in all? Write the multiplication fact: 3 × 2 = ___



Task card 19 Equal Groups & Arrays

There are 3 rows of 5. How many balloons in all? Write the multiplication fact: 3 × 5 = ___



Task card 20 Equal Groups & Arrays

There are 2 rows of 5. How many balloons in all? Write the multiplication fact: 2 × 5 = ___



Task card 21 Equal Groups & Arrays

There are 2 rows of 5. How many hearts in all? Write the multiplication fact: 2 × 5 = ___



Task card 22 Equal Groups & Arrays

There are 5 rows of 2. How many hearts in all? Write the multiplication fact: 5 × 2 = ___



Task card 23 Equal Groups & Arrays

There are 2 rows of 4. How many stars in all? Write the multiplication fact: 2 × 4 = ___



Task card 24 Equal Groups & Arrays

There are 3 rows of 3. How many apples in all? Write the multiplication fact: 3 × 3 = ___



Equal Groups & Arrays Task Cards

Recording sheet · Grade 2 · Count the picture, then write the multiplication fact.

Name: _____ Date: _____

Scan to check your answers

1	2	3	4
5	6	7	8
9	10	11	12
13	14	15	16
17	18	19	20
21	22	23	24

Equal Groups & Arrays Task Cards: Answer Key

Grade 2 · Medium

The answers online

1. 8	**2.** 8	**3.** 12
4. 12	**5.** 8	**6.** 4
7. 9	**8.** 4	**9.** 16
10. 8	**11.** 6	**12.** 16
13. 16	**14.** 12	**15.** 8
16. 9	**17.** 9	**18.** 6
19. 15	**20.** 10	**21.** 10
22. 10	**23.** 8	**24.** 9