Task card 1 Equal Groups & Arrays

There are 5 rows of 4. How many apples in all? Write the multiplication fact: 5 × 4 = ___



Task card 2 Equal Groups & Arrays

There are 3 rows of 5. How many stars in all? Write the multiplication fact: 3 × 5 = ___



Task card 3 Equal Groups & Arrays

There are 3 rows of 3. How many hearts in all? Write the multiplication fact: 3 × 3 = ___



Task card 4 Equal Groups & Arrays

There are 2 rows of 2. How many balloons in all? Write the multiplication fact: 2 × 2 = ___



Task card 5 Equal Groups & Arrays

There are 2 rows of 5. How many stars in all? Write the multiplication fact: 2 × 5 = ___



Task card 6 Equal Groups & Arrays

There are 5 rows of 4. How many stars in all? Write the multiplication fact: 5 × 4 = ___



Task card 7 Equal Groups & Arrays

There are 3 rows of 3. How many stars in all? Write the multiplication fact: 3 × 3 = ___



Task card 8 Equal Groups & Arrays

There are 4 rows of 4. How many hearts in all? Write the multiplication fact: 4 × 4 = ___



Task card 9 Equal Groups & Arrays

There are 5 rows of 6. How many hearts in all? Write the multiplication fact: 5 × 6 = ___



Task card 10 Equal Groups & Arrays

There are 2 rows of 4. How many hearts in all? Write the multiplication fact: 2 × 4 = ___



Task card 11 Equal Groups & Arrays

There are 4 rows of 3. How many hearts in all? Write the multiplication fact: 4 × 3 = ___



Task card 12 Equal Groups & Arrays

There are 3 rows of 2. How many balloons in all? Write the multiplication fact: 3 × 2 = ___



Task card 13 Equal Groups & Arrays

There are 2 rows of 3. How many balloons in all? Write the multiplication fact: 2 × 3 = ___



Task card 14 Equal Groups & Arrays

There are 2 rows of 2. How many stars in all? Write the multiplication fact: 2 × 2 = ___



Task card 15 Equal Groups & Arrays

There are 2 rows of 4. How many stars in all? Write the multiplication fact: 2 × 4 = ___



Task card 16 Equal Groups & Arrays

There are 2 rows of 3. How many apples in all? Write the multiplication fact: 2 × 3 = ___



Task card 17 Equal Groups & Arrays

There are 3 rows of 4. How many stars in all? Write the multiplication fact: 3 × 4 = ___



Task card 18 Equal Groups & Arrays

There are 4 rows of 3. How many balloons in all? Write the multiplication fact: 4 × 3 = ___



Task card 19 Equal Groups & Arrays

There are 4 rows of 2. How many apples in all? Write the multiplication fact: 4 × 2 = ___



Task card 20 Equal Groups & Arrays

There are 5 rows of 5. How many apples in all? Write the multiplication fact: 5 × 5 = ___



Task card 21 Equal Groups & Arrays

There are 2 rows of 6. How many apples in all? Write the multiplication fact: 2 × 6 = ___



Task card 22 Equal Groups & Arrays

There are 4 rows of 5. How many hearts in all? Write the multiplication fact: 4 × 5 = ___



Task card 23 Equal Groups & Arrays

There are 2 rows of 5. How many hearts in all? Write the multiplication fact: 2 × 5 = ___



Task card 24 Equal Groups & Arrays

There are 4 rows of 5. How many apples in all? Write the multiplication fact: 4 × 5 = ___



Equal Groups & Arrays Task Cards

Recording sheet · Grade 2 · Count the picture, then write the multiplication fact.

Name: _____ Date: _____

Scan to check your answers

1	2	3	4
5	6	7	8
9	10	11	12
13	14	15	16
17	18	19	20
21	22	23	24

Equal Groups & Arrays Task Cards: Answer Key

Grade 2 · Hard

The answers online

1. 20	**2.** 15	**3.** 9
4. 4	**5.** 10	**6.** 20
7. 9	**8.** 16	**9.** 30
10. 8	**11.** 12	**12.** 6
13. 6	**14.** 4	**15.** 8
16. 6	**17.** 12	**18.** 12
19. 8	**20.** 25	**21.** 12
22. 20	**23.** 10	**24.** 20