Task card 1 Equal Groups & Arrays

There are 2 rows of 2. How many hearts in all? Write the multiplication fact: 2 × 2 = ___



Task card 2 Equal Groups & Arrays

There are 2 rows of 2. How many stars in all? Write the multiplication fact: 2 × 2 = ___



Task card 3 Equal Groups & Arrays

There are 2 rows of 2. How many apples in all? Write the multiplication fact: 2 × 2 = ___



Task card 4 Equal Groups & Arrays

There are 2 rows of 2. How many balloons in all? Write the multiplication fact: 2 × 2 = ___



Task card 5 Equal Groups & Arrays

There are 3 rows of 2. How many stars in all? Write the multiplication fact: 3 × 2 = ___



Task card 6 Equal Groups & Arrays

There are 2 rows of 3. How many apples in all? Write the multiplication fact: 2 × 3 = ___

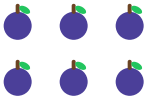

Task card 7 Equal Groups & Arrays

There are 2 rows of 3. How many stars in all? Write the multiplication fact: 2 × 3 = ___



Task card 8 Equal Groups & Arrays

There are 3 rows of 3. How many stars in all? Write the multiplication fact: 3 × 3 = ___



Task card 9 Equal Groups & Arrays

There are 3 rows of 2. How many hearts in all? Write the multiplication fact: 3 × 2 = ___



Task card 10 Equal Groups & Arrays

There are 3 rows of 2. How many balloons in all? Write the multiplication fact: 3 × 2 = ___



Task card 11 Equal Groups & Arrays

There are 3 rows of 3. How many apples in all? Write the multiplication fact: 3 × 3 = ___



Task card 12 Equal Groups & Arrays

There are 2 rows of 3. How many hearts in all? Write the multiplication fact: 2 × 3 = ___



Task card 13 Equal Groups & Arrays

There are 2 rows of 3. How many balloons in all? Write the multiplication fact: 2 × 3 = ___



Task card 14 Equal Groups & Arrays

There are 3 rows of 3. How many hearts in all? Write the multiplication fact: 3 × 3 = ___



Task card 15 Equal Groups & Arrays

There are 3 rows of 3. How many balloons in all? Write the multiplication fact: 3 × 3 = ___



Task card 16 Equal Groups & Arrays

There are 3 rows of 2. How many apples in all? Write the multiplication fact: 3 × 2 = ___



Equal Groups & Arrays Task Cards

Recording sheet · Grade 2 · Count the picture, then write the multiplication fact.

Name: _____ Date: _____

Scan to check your answers

1	2	3	4
5	6	7	8
9	10	11	12
13	14	15	16

Equal Groups & Arrays Task Cards: Answer Key

Grade 2 · Easy

The answers online

1. 4	**2.** 4	**3.** 4
4. 4	**5.** 6	**6.** 6
7. 6	**8.** 9	**9.** 6
10. 6	**11.** 9	**12.** 6
13. 6	**14.** 9	**15.** 9
16. 6		