Equal Groups & Arrays · 1

There are 5 rows of 4. How many apples in all? Write the multiplication fact: 5 × 4 = ___



Equal Groups & Arrays · 2

There are 3 rows of 5. How many stars in all? Write the multiplication fact: 3 × 5 = ___



Equal Groups & Arrays · 3

There are 3 rows of 3. How many hearts in all? Write the multiplication fact: 3 × 3 = ___



Equal Groups & Arrays · 4

There are 2 rows of 2. How many balloons in all? Write the multiplication fact: 2 × 2 = ___



Equal Groups & Arrays · 5

There are 2 rows of 5. How many stars in all? Write the multiplication fact: 2 × 5 = ___



Equal Groups & Arrays · 6

There are 5 rows of 4. How many stars in all? Write the multiplication fact: 5 × 4 = ___



Equal Groups & Arrays · 7

There are 3 rows of 3. How many stars in all? Write the multiplication fact: 3 × 3 = ___



Equal Groups & Arrays · 8

There are 4 rows of 4. How many hearts in all? Write the multiplication fact: 4 × 4 = ___



Equal Groups & Arrays · 2

ANSWER

15

Equal Groups & Arrays · 1

ANSWER

20

Equal Groups & Arrays · 4

ANSWER

4

Equal Groups & Arrays · 3

ANSWER

9

Equal Groups & Arrays · 6

ANSWER

20

Equal Groups & Arrays · 5

ANSWER

10

Equal Groups & Arrays · 8

ANSWER

16

Equal Groups & Arrays · 7

ANSWER

9

Equal Groups & Arrays · 9

There are 5 rows of 6. How many hearts in all? Write the multiplication fact: 5 × 6 = ___



Equal Groups & Arrays · 10

There are 2 rows of 4. How many hearts in all? Write the multiplication fact: 2 × 4 = ___



Equal Groups & Arrays · 11

There are 4 rows of 3. How many hearts in all? Write the multiplication fact: 4 × 3 = ___



Equal Groups & Arrays · 12

There are 3 rows of 2. How many balloons in all? Write the multiplication fact: 3 × 2 = ___



Equal Groups & Arrays · 13

There are 2 rows of 3. How many balloons in all? Write the multiplication fact: 2 × 3 = ___



Equal Groups & Arrays · 14

There are 2 rows of 2. How many stars in all? Write the multiplication fact: 2 × 2 = ___



Equal Groups & Arrays · 15

There are 2 rows of 4. How many stars in all? Write the multiplication fact: 2 × 4 = ___



Equal Groups & Arrays · 16

There are 2 rows of 3. How many apples in all? Write the multiplication fact: 2 × 3 = ___

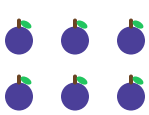

Equal Groups & Arrays · 10

ANSWER

8

Equal Groups & Arrays · 9

ANSWER

30

Equal Groups & Arrays · 12

ANSWER

6

Equal Groups & Arrays · 11

ANSWER

12

Equal Groups & Arrays · 14

ANSWER

4

Equal Groups & Arrays · 13

ANSWER

6

Equal Groups & Arrays · 16

ANSWER

6

Equal Groups & Arrays · 15

ANSWER

8

Equal Groups & Arrays · 17

There are 3 rows of 4. How many stars in all? Write the multiplication fact: 3 × 4 = ___



Equal Groups & Arrays · 18

There are 4 rows of 3. How many balloons in all? Write the multiplication fact: 4 × 3 = ___



Equal Groups & Arrays · 19

There are 4 rows of 2. How many apples in all? Write the multiplication fact: 4 × 2 = ___



Equal Groups & Arrays · 20

There are 5 rows of 5. How many apples in all? Write the multiplication fact: 5 × 5 = ___



Equal Groups & Arrays · 21

There are 2 rows of 6. How many apples in all? Write the multiplication fact: 2 × 6 = ___



Equal Groups & Arrays · 22

There are 4 rows of 5. How many hearts in all? Write the multiplication fact: 4 × 5 = ___



Equal Groups & Arrays · 23

There are 2 rows of 5. How many hearts in all? Write the multiplication fact: 2 × 5 = ___



Equal Groups & Arrays · 24

There are 4 rows of 5. How many apples in all? Write the multiplication fact: 4 × 5 = ___



Equal Groups & Arrays · 18

ANSWER

12

Equal Groups & Arrays · 17

ANSWER

12

Equal Groups & Arrays · 20

ANSWER

25

Equal Groups & Arrays · 19

ANSWER

8

Equal Groups & Arrays · 22

ANSWER

20

Equal Groups & Arrays · 21

ANSWER

12

Equal Groups & Arrays · 24

ANSWER

20

Equal Groups & Arrays · 23

ANSWER

10