Task card 1 Easter Math

Ella puts 2 carrot muffins on each of 4 plates. How many carrot muffins is that in all?



Task card 2 Easter Math

The bakery makes 433 bunny cookies. It sells 269 of them. How many bunny cookies are left?

Task card 3 Easter Math

Ava buys a paper flower for 30¢ and a painted egg for 30¢. How many cents does Ava spend?

Task card 4 Easter Math

Ava buys a painted egg for 15¢ and a bunny sticker for 35¢. How many cents does Ava spend?

Task card 5 Easter Math

The bakery makes 230 carrot muffins. It sells 26 of them. How many carrot muffins are left?

Task card 6 Easter Math

The school bakes 118 hot cross buns and 80 carrot muffins for the bake sale. How many treats is that in all?

Task card 7 Easter Math

Mia puts 5 hot cross buns on each of 4 plates. How many hot cross buns is that in all?



Task card 8 Easter Math

The school bakes 187 bunny cookies and 154 carrot muffins for the bake sale. How many treats is that in all?

Task card 9 Easter Math

The bakery makes 364 carrot muffins. It sells 323 of them. How many carrot muffins are left?

Task card 10 Easter Math

The school bakes 32 carrot muffins and 209 hot cross buns for the bake sale. How many treats is that in all?

Task card 11 Easter Math

Ella puts 4 hot cross buns on each of 5 plates. How many hot cross buns is that in all?



Task card 12 Easter Math

Ella buys a painted egg for 20¢ and a bunny sticker for 55¢. How many cents does Ella spend?

Task card 13 Easter Math

Noah buys a bunny sticker for 45¢ and a paper flower for 50¢. How many cents does Noah spend?

Task card 14 Easter Math

The school bakes 126 bunny cookies and 137 carrot muffins for the bake sale. How many treats is that in all?

Task card 15 Easter Math

Noah puts 2 hot cross buns on each of 3 plates. How many hot cross buns is that in all?



Task card 16 Easter Math

The bakery makes 401 hot cross buns. It sells 117 of them. How many hot cross buns are left?

Task card 17 Easter Math

The bakery makes 43 hot cross buns. It sells 32 of them. How many hot cross buns are left?

Task card 18 Easter Math

The school bakes 225 hot cross buns and 262 bunny cookies for the bake sale. How many treats is that in all?

Task card 19 Easter Math

Leo buys a paper flower for 30¢ and a painted egg for 35¢. How many cents does Leo spend?

Task card 20 Easter Math

Leo puts 3 hot cross buns on each of 2 plates. How many hot cross buns is that in all?



Task card 21 Easter Math

The bakery makes 495 hot cross buns. It sells 405 of them. How many hot cross buns are left?

Task card 22 Easter Math

Ava puts 2 carrot muffins on each of 3 plates. How many carrot muffins is that in all?



Task card 23 Easter Math

The school bakes 245 bunny cookies and 149 hot cross buns for the bake sale. How many treats is that in all?

Task card 24 Easter Math

Ella buys a paper flower for 15¢ and a painted egg for 50¢. How many cents does Ella spend?

Easter Math Task Cards

Recording sheet · Grade 2 · Read each story and solve.

Name: _____ Date: _____

Scan to check your answers

1	2	3	4
5	6	7	8
9	10	11	12
13	14	15	16
17	18	19	20
21	22	23	24

Easter Math Task Cards: Answer Key

Grade 2 · Hard

The answers online

1. 8	**2.** 164	**3.** 60
4. 50	**5.** 204	**6.** 198
7. 20	**8.** 341	**9.** 41
10. 241	**11.** 20	**12.** 75
13. 95	**14.** 263	**15.** 6
16. 284	**17.** 11	**18.** 487
19. 65	**20.** 6	**21.** 90
22. 6	**23.** 394	**24.** 65