**Task card 1** Easter Math

The bakery makes 84 hot cross buns. It sells 71 of them. How many hot cross buns are left?

**Task card 2** Easter Math

Ava puts 5 hot cross buns on each of 3 plates. How many hot cross buns is that in all?



**Task card 3** Easter Math

Lily buys a paper flower for 40¢ and a bunny sticker for 15¢. How many cents does Lily spend?

**Task card 4** Easter Math

Ben buys a paper flower for 40¢ and a painted egg for 15¢. How many cents does Ben spend?

**Task card 5** Easter Math

The school bakes 41 hot cross buns and 49 carrot muffins for the bake sale. How many treats is that in all?

**Task card 6** Easter Math

The bakery makes 88 bunny cookies. It sells 11 of them. How many bunny cookies are left?

**Task card 7** Easter Math

The school bakes 29 carrot muffins and 66 hot cross buns for the bake sale. How many treats is that in all?

**Task card 8** Easter Math

Mia puts 3 bunny cookies on each of 4 plates. How many bunny cookies is that in all?



**Task card 9** Easter Math

The school bakes 171 hot cross buns and 39 carrot muffins for the bake sale. How many treats is that in all?

**Task card 10** Easter Math

Omar puts 5 bunny cookies on each of 2 plates. How many bunny cookies is that in all?



**Task card 11** Easter Math

Ava buys a bunny sticker for 40¢ and a painted egg for 45¢. How many cents does Ava spend?

**Task card 12** Easter Math

The bakery makes 497 carrot muffins. It sells 101 of them. How many carrot muffins are left?

**Task card 13** Easter Math

The bakery makes 70 bunny cookies. It sells 61 of them. How many bunny cookies are left?

**Task card 14** Easter Math

Lily buys a bunny sticker for 25¢ and a paper flower for 30¢. How many cents does Lily spend?

**Task card 15** Easter Math

Leo puts 3 hot cross buns on each of 4 plates. How many hot cross buns is that in all?



**Task card 16** Easter Math

The school bakes 65 hot cross buns and 149 carrot muffins for the bake sale. How many treats is that in all?

**Task card 17** Easter Math

Noah buys a bunny sticker for 25¢ and a painted egg for 50¢. How many cents does Noah spend?

**Task card 18** Easter Math

Omar buys a painted egg for 35¢ and a bunny sticker for 15¢. How many cents does Omar spend?

**Task card 19** Easter Math

The bakery makes 332 hot cross buns. It sells 62 of them. How many hot cross buns are left?

**Task card 20** Easter Math

Lily puts 4 bunny cookies on each of 2 plates. How many bunny cookies is that in all?



**Task card 21** Easter Math

The school bakes 125 carrot muffins and 172 bunny cookies for the bake sale. How many treats is that in all?

**Task card 22** Easter Math

The bakery makes 227 carrot muffins. It sells 42 of them. How many carrot muffins are left?

**Task card 23** Easter Math

Ava puts 5 bunny cookies on each of 5 plates. How many bunny cookies is that in all?



**Task card 24** Easter Math

The school bakes 250 carrot muffins and 185 bunny cookies for the bake sale. How many treats is that in all?

# Easter Math Task Cards

Recording sheet · Grade 2 · Read each story and solve.

Name: _____ Date: _____

Scan to check your answers

| | | | |
|---|---|---|---|
| 1 | 2 | 3 | 4 |
| 5 | 6 | 7 | 8 |
| 9 | 10 | 11 | 12 |
| 13 | 14 | 15 | 16 |
| 17 | 18 | 19 | 20 |
| 21 | 22 | 23 | 24 |

# Easter Math Task Cards: Answer Key

Grade 2 · Medium

The answers online

| | | |
|---|---|---|
| **1.** 13 | **2.** 15 | **3.** 55 |
| **4.** 55 | **5.** 90 | **6.** 77 |
| **7.** 95 | **8.** 12 | **9.** 210 |
| **10.** 10 | **11.** 85 | **12.** 396 |
| **13.** 9 | **14.** 55 | **15.** 12 |
| **16.** 214 | **17.** 75 | **18.** 50 |
| **19.** 270 | **20.** 8 | **21.** 297 |
| **22.** 185 | **23.** 25 | **24.** 435 |