Easter Math · 1

The bakery makes 84 hot cross buns. It sells 71 of them. How many hot cross buns are left?

Easter Math · 2

Ava puts 5 hot cross buns on each of 3 plates. How many hot cross buns is that in all?



Easter Math · 3

Lily buys a paper flower for 40¢ and a bunny sticker for 15¢. How many cents does Lily spend?

Easter Math · 4

Ben buys a paper flower for 40¢ and a painted egg for 15¢. How many cents does Ben spend?

Easter Math · 5

The school bakes 41 hot cross buns and 49 carrot muffins for the bake sale. How many treats is that in all?

Easter Math · 6

The bakery makes 88 bunny cookies. It sells 11 of them. How many bunny cookies are left?

Easter Math · 7

The school bakes 29 carrot muffins and 66 hot cross buns for the bake sale. How many treats is that in all?

Easter Math · 8

Mia puts 3 bunny cookies on each of 4 plates. How many bunny cookies is that in all?



Easter Math · 2

ANSWER

15

Easter Math · 1

ANSWER

13

Easter Math · 4

ANSWER

55

Easter Math · 3

ANSWER

55

Easter Math · 6

ANSWER

77

Easter Math · 5

ANSWER

90

Easter Math · 8

ANSWER

12

Easter Math · 7

ANSWER

95

Easter Math · 9

The school bakes 171 hot cross buns and 39 carrot muffins for the bake sale. How many treats is that in all?

Easter Math · 10

Omar puts 5 bunny cookies on each of 2 plates. How many bunny cookies is that in all?



Easter Math · 11

Ava buys a bunny sticker for 40¢ and a painted egg for 45¢. How many cents does Ava spend?

Easter Math · 12

The bakery makes 497 carrot muffins. It sells 101 of them. How many carrot muffins are left?

Easter Math · 13

The bakery makes 70 bunny cookies. It sells 61 of them. How many bunny cookies are left?

Easter Math · 14

Lily buys a bunny sticker for 25¢ and a paper flower for 30¢. How many cents does Lily spend?

Easter Math · 15

Leo puts 3 hot cross buns on each of 4 plates. How many hot cross buns is that in all?



Easter Math · 16

The school bakes 65 hot cross buns and 149 carrot muffins for the bake sale. How many treats is that in all?

Easter Math · 10

ANSWER

10

Easter Math · 9

ANSWER

210

Easter Math · 12

ANSWER

396

Easter Math · 11

ANSWER

85

Easter Math · 14

ANSWER

55

Easter Math · 13

ANSWER

9

Easter Math · 16

ANSWER

214

Easter Math · 15

ANSWER

12

Easter Math · 17

Noah buys a bunny sticker for 25¢ and a painted egg for 50¢. How many cents does Noah spend?

Easter Math · 18

Omar buys a painted egg for 35¢ and a bunny sticker for 15¢. How many cents does Omar spend?

Easter Math · 19

The bakery makes 332 hot cross buns. It sells 62 of them. How many hot cross buns are left?

Easter Math · 20

Lily puts 4 bunny cookies on each of 2 plates. How many bunny cookies is that in all?



Easter Math · 21

The school bakes 125 carrot muffins and 172 bunny cookies for the bake sale. How many treats is that in all?

Easter Math · 22

The bakery makes 227 carrot muffins. It sells 42 of them. How many carrot muffins are left?

Easter Math · 23

Ava puts 5 bunny cookies on each of 5 plates. How many bunny cookies is that in all?



Easter Math · 24

The school bakes 250 carrot muffins and 185 bunny cookies for the bake sale. How many treats is that in all?

Easter Math · 18

ANSWER

50

Easter Math · 17

ANSWER

75

Easter Math · 20

ANSWER

8

Easter Math · 19

ANSWER

270

Easter Math · 22

ANSWER

185

Easter Math · 21

ANSWER

297

Easter Math · 24

ANSWER

435

Easter Math · 23

ANSWER

25