Task card 1 Doubles & Near Doubles to 100

19 + 19 = ___

Task card 2 Doubles & Near Doubles to 100

15 + 15 = ___

Task card 3 Doubles & Near Doubles to 100

24 + 23 = ___ Think:

23 + 23, then add 1.

Task card 4 Doubles & Near Doubles to 100

Double the tens, then double the ones. 17 + 17 = ___

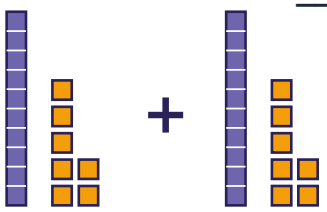

Task card 5 Doubles & Near Doubles to 100

22 + 22 = 44.

So 22 + 21 =

___

Task card 6 Doubles & Near Doubles to 100

14 + ___ = 28

Task card 7 Doubles & Near Doubles to 100

11 + 10 = ___ Think: 10 + 10, then add 1.

Task card 8 Doubles & Near Doubles to 100

Ava has 29 toy cars. Lily has 1 fewer than Ava. How many toy cars do they have in all?

Task card 9 Doubles & Near Doubles to 100

39 + 39 = ___

Task card 10 Doubles & Near Doubles to 100

15 + 16 = ___

Task card 11 Doubles & Near Doubles to 100

38 + 37 = ___

Task card 12 Doubles & Near Doubles to 100

Double the tens, then double the ones. 34 + 34 = ___

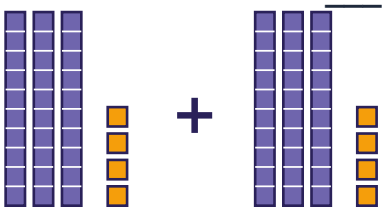

Task card 13 Doubles & Near Doubles to 100

Double ___ is 40.

Task card 14 Doubles & Near Doubles to 100

43 + ___ = 86

Task card 15 Doubles & Near Doubles to 100

Mia has 25 toy cars. Max has the same number. How many toy cars do they have in all?

Task card 16 Doubles & Near Doubles to 100

Two boxes hold the same number of stickers. Together they hold 34. How many stickers are in each box?

Task card 17 Doubles & Near Doubles to 100

43 + 43 = ___

Task card 18 Doubles & Near Doubles to 100

42 + 43 = ___

Task card 19 Doubles & Near Doubles to 100

27 + 26 = ___

Task card 20 Doubles & Near Doubles to 100

Double the tens, then double the ones. 25 + 25 = ___

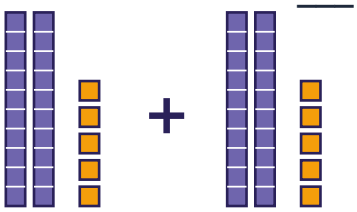

Task card 21 Doubles & Near Doubles to 100

Double ___ is 84.

Task card 22 Doubles & Near Doubles to 100

42 + ___ = 84

Task card 23 Doubles & Near Doubles to 100

Lily has 17 cards. Ava has the same number. How many cards do they have in all?

Task card 24 Doubles & Near Doubles to 100

Two boxes hold the same number of cards. Together they hold 62. How many cards are in each box?

Doubles & Near Doubles to 100 Task Cards

Recording sheet · Grade 2 · Use doubles to help you. The same facts come in different shapes.

Name: _____ Date: _____

Scan to check your answers

1	2	3	4
5	6	7	8
9	10	11	12
13	14	15	16
17	18	19	20
21	22	23	24

Doubles & Near Doubles to 100 Task Cards: Answer Key

Grade 2 · Medium

The answers online

1. 38	**2.** 30	**3.** 47
4. 34	**5.** 43	**6.** 14
7. 21	**8.** 57	**9.** 78
10. 31	**11.** 75	**12.** 68
13. 20	**14.** 43	**15.** 50
16. 17	**17.** 86	**18.** 85
19. 53	**20.** 50	**21.** 42
22. 42	**23.** 34	**24.** 31