19 + 19 = ___



15 + 15 = ___



24 + 23 = ___

Think: 23 + 23, then add 1.



Double the tens, then double the ones. 17 + 17 = ___

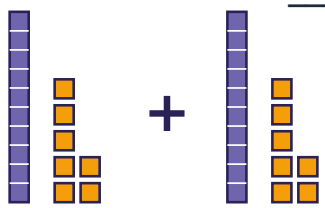



22 + 22 = 44. So 22 + 21 = ___



14 + ___ = 28



11 + 10 = ___

Think: 10 + 10, then add 1.



Ava has 29 toy cars. Lily has 1 fewer than Ava. How many toy cars do they have in all?

Doubles & Near Doubles to 100 · 2

**ANSWER**

**30**

Doubles & Near Doubles to 100 · 1

**ANSWER**

**38**

Doubles & Near Doubles to 100 · 4

**ANSWER**

**34**

Doubles & Near Doubles to 100 · 3

**ANSWER**

**47**

Doubles & Near Doubles to 100 · 6

**ANSWER**

**14**

Doubles & Near Doubles to 100 · 5

**ANSWER**

**43**

Doubles & Near Doubles to 100 · 8

**ANSWER**

**57**

Doubles & Near Doubles to 100 · 7

**ANSWER**

**21**

39 + 39 = ___



15 + 16 = ___



38 + 37 = ___



Double the tens, then double the ones. 34 + 34 = ___

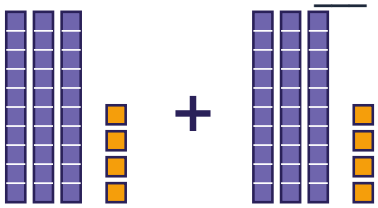



Double ___ is 40.



43 + ___ = 86



Mia has 25 toy cars. Max has the same number. How many toy cars do they have in all?



Two boxes hold the same number of stickers. Together they hold 34. How many stickers are in each box?

Doubles & Near Doubles to 100 · 10

**ANSWER**

# 31

Doubles & Near Doubles to 100 · 9

**ANSWER**

# 78

Doubles & Near Doubles to 100 · 12

**ANSWER**

# 68

Doubles & Near Doubles to 100 · 11

**ANSWER**

# 75

Doubles & Near Doubles to 100 · 14

**ANSWER**

# 43

Doubles & Near Doubles to 100 · 13

**ANSWER**

# 20

Doubles & Near Doubles to 100 · 16

**ANSWER**

# 17

Doubles & Near Doubles to 100 · 15

**ANSWER**

# 50

$43 + 43 = ___$



$42 + 43 = ___$



$27 + 26 = ___$



Double the tens, then double the ones. 25 + 25 = ___

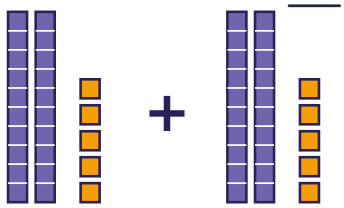



Double ___ is 84.



$42 + ___ = 84$



Lily has 17 cards. Ava has the same number. How many cards do they have in all?



Two boxes hold the same number of cards. Together they hold 62. How many cards are in each box?

Doubles & Near Doubles to 100 · 18

**ANSWER**

**85**

Doubles & Near Doubles to 100 · 17

**ANSWER**

**86**

Doubles & Near Doubles to 100 · 20

**ANSWER**

**50**

Doubles & Near Doubles to 100 · 19

**ANSWER**

**53**

Doubles & Near Doubles to 100 · 22

**ANSWER**

**42**

Doubles & Near Doubles to 100 · 21

**ANSWER**

**42**

Doubles & Near Doubles to 100 · 24

**ANSWER**

**31**

Doubles & Near Doubles to 100 · 23

**ANSWER**

**34**