Task card 1 Counting Money

3 quarters, 4 dimes, 6 nickels — how many cents in all?

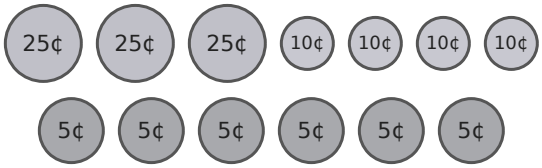

Task card 2 Counting Money

3 quarters, 6 dimes, 5 pennies — how many cents in all?

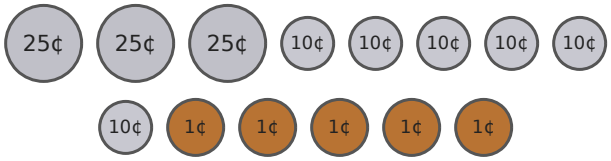

Task card 3 Counting Money

4 quarters, 2 dimes, 6 nickels — how many cents in all?

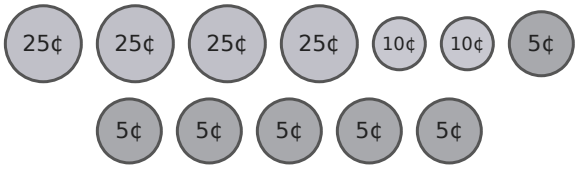

Task card 4 Counting Money

2 quarters, 2 dimes, 5 nickels, 5 pennies — how many cents in all?

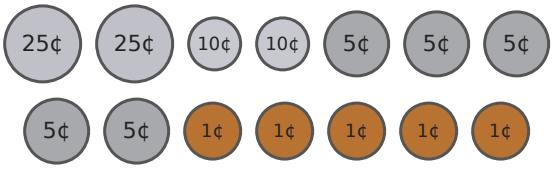

Task card 5 Counting Money

6 quarters, 3 dimes, 1 nickel, 2 pennies — how many cents in all?

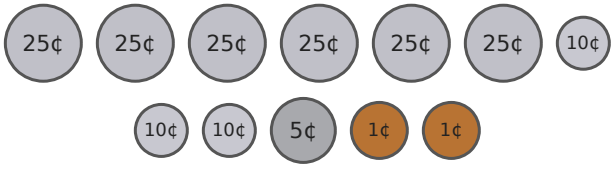

Task card 6 Counting Money

3 quarters, 4 dimes, 3 nickels, 4 pennies — how many cents in all?

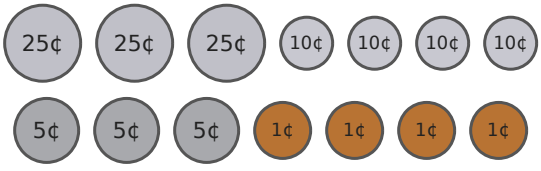

Task card 7 Counting Money

5 quarters, 4 dimes, 3 nickels, 6 pennies — how many cents in all?

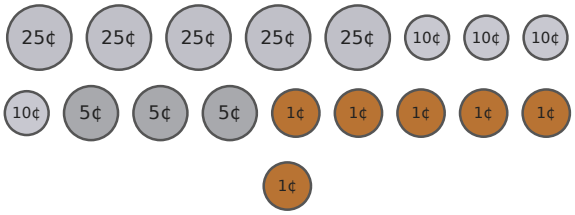

Task card 8 Counting Money

3 quarters, 1 dime, 4 nickels, 5 pennies — how many cents in all?

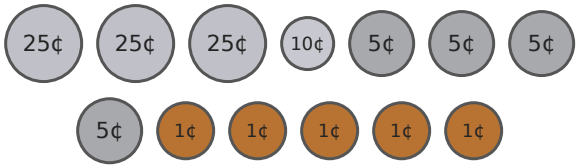

Task card 9 Counting Money

1 quarter, 1 dime, 4 nickels, 1 penny — how many cents in all?



Task card 10 Counting Money

4 quarters, 6 dimes, 4 nickels, 4 pennies — how many cents in all?

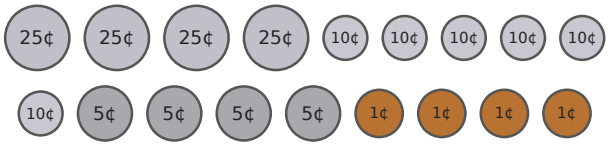

Task card 11 Counting Money

2 quarters, 6 dimes, 6 nickels — how many cents in all?

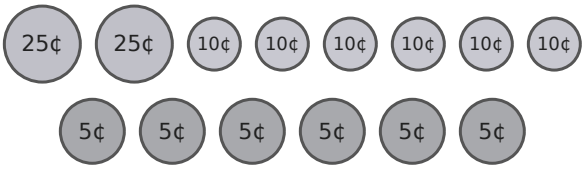

Task card 12 Counting Money

4 dimes, 5 nickels — how many cents in all?

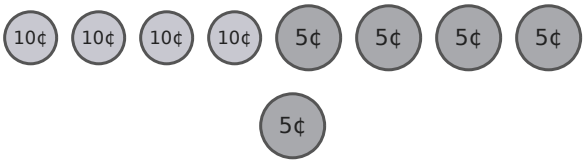

Task card 13 Counting Money

4 quarters, 6 dimes, 1 nickel, 2 pennies — how many cents in all?

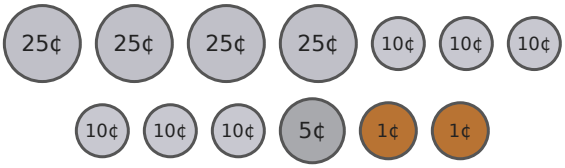

Task card 14 Counting Money

2 quarters, 4 dimes, 5 nickels — how many cents in all?

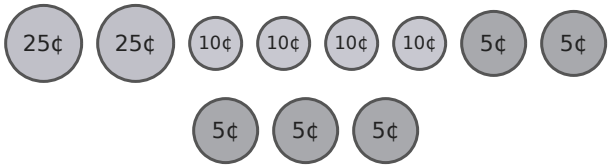

Task card 15 Counting Money

4 quarters, 4 dimes, 6 pennies — how many cents in all?

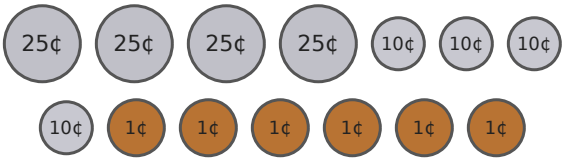

Task card 16 Counting Money

2 quarters, 2 dimes, 1 penny — how many cents in all?

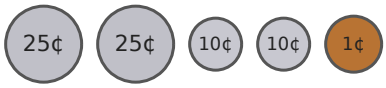

Task card 17 Counting Money

5 quarters, 1 dime, 6 pennies — how many cents in all?

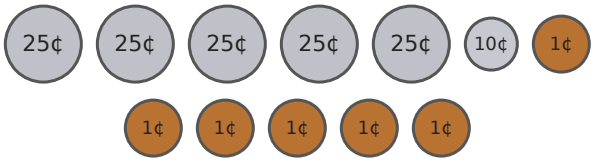

Task card 18 Counting Money

6 quarters, 3 dimes, 5 nickels, 5 pennies — how many cents in all?

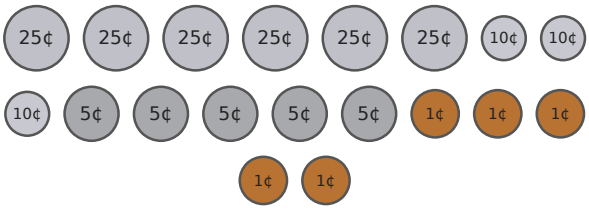

Task card 19 Counting Money

6 quarters, 2 dimes, 3 nickels, 4 pennies — how many cents in all?

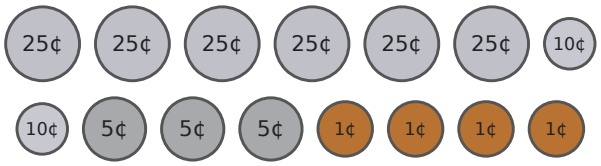

Task card 20 Counting Money

4 quarters, 2 dimes, 4 nickels, 5 pennies — how many cents in all?

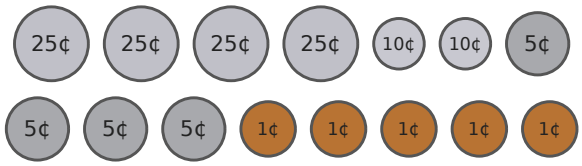

Task card 21 Counting Money

6 quarters, 1 dime, 3 nickels, 1 penny — how many cents in all?

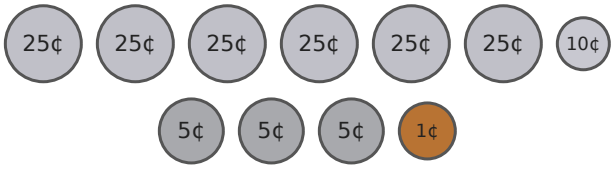

Task card 22 Counting Money

3 quarters, 4 dimes — how many cents in all?

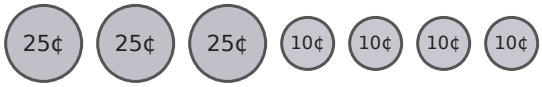

Task card 23 Counting Money

6 quarters, 5 dimes, 5 nickels, 1 penny — how many cents in all?

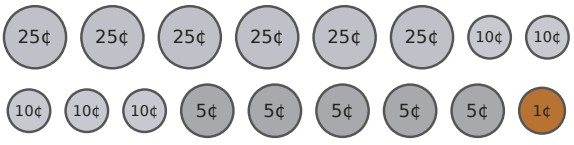

Task card 24 Counting Money

5 quarters, 3 dimes, 4 nickels, 1 penny — how many cents in all?

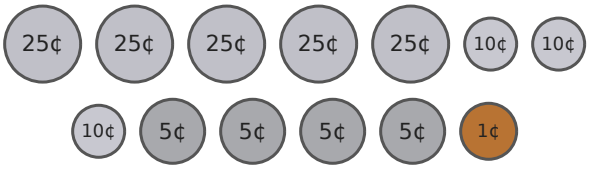

Counting Money Task Cards

Recording sheet · Grade 2 · Find the total value in cents.

Name: _____ Date: _____

Scan to check your answers

1	2	3	4
5	6	7	8
9	10	11	12
13	14	15	16
17	18	19	20
21	22	23	24

Counting Money Task Cards: Answer Key

Grade 2 · Hard

The answers online

1. 145	**2.** 140	**3.** 150
4. 100	**5.** 187	**6.** 134
7. 186	**8.** 110	**9.** 56
10. 184	**11.** 140	**12.** 65
13. 167	**14.** 115	**15.** 146
16. 71	**17.** 141	**18.** 210
19. 189	**20.** 145	**21.** 176
22. 115	**23.** 226	**24.** 176