Task card 1 Comparing Lengths with a Ruler

How many centimeters longer is the blue ribbon than the orange ribbon?

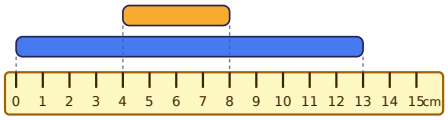

Task card 2 Comparing Lengths with a Ruler

How many inches longer is the purple worm than the green worm?

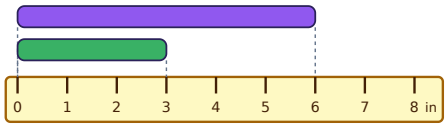

Task card 3 Comparing Lengths with a Ruler

How many centimeters longer is the orange string than the blue string?

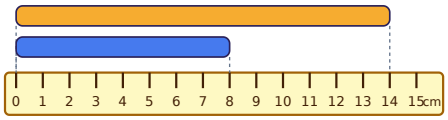

Task card 4 Comparing Lengths with a Ruler

The red ribbon and the orange ribbon are put end to end. How long are they together, in inches?

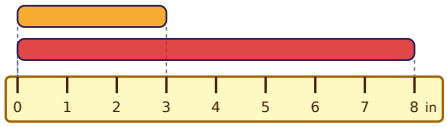

Task card 5 Comparing Lengths with a Ruler

How many centimeters longer is the blue worm than the green worm?

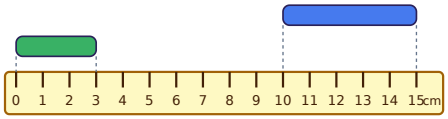

Task card 6 Comparing Lengths with a Ruler

How many inches longer is the green string than the blue string?

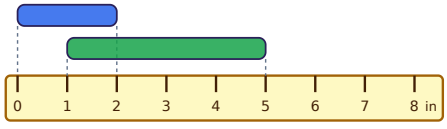

Task card 7 Comparing Lengths with a Ruler

How many centimeters longer is the purple ribbon than the green ribbon?

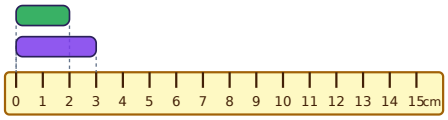

Task card 8 Comparing Lengths with a Ruler

How many inches longer is the purple crayon than the blue crayon?

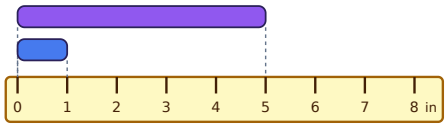

Task card 9 Comparing Lengths with a Ruler

How many centimeters longer is the blue worm than the green worm?

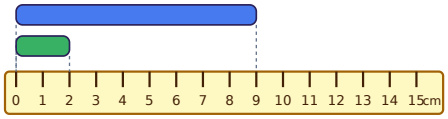

Task card 10 Comparing Lengths with a Ruler

How many inches longer is the orange worm than the blue worm?

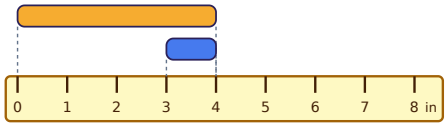

Task card 11 Comparing Lengths with a Ruler

How many centimeters longer is the green crayon than the orange crayon?

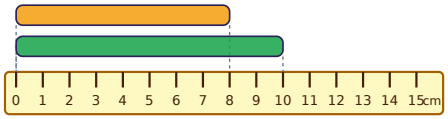

Task card 12 Comparing Lengths with a Ruler

How many inches longer is the green crayon than the red crayon?

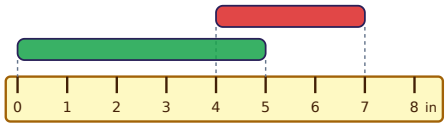

Task card 13 Comparing Lengths with a Ruler

How many centimeters longer is the purple string than the red string?

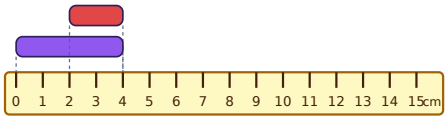

Task card 14 Comparing Lengths with a Ruler

The green ribbon and the orange ribbon are put end to end. How long are they together, in inches?

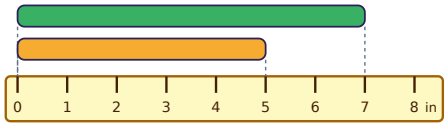

Task card 15 Comparing Lengths with a Ruler

How many centimeters longer is the purple straw than the blue straw?

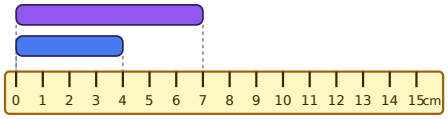

Task card 16 Comparing Lengths with a Ruler

How many inches longer is the green worm than the purple worm?

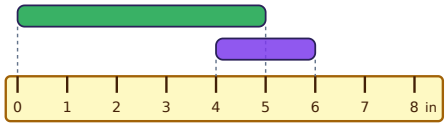

Task card 17 Comparing Lengths with a Ruler

How many centimeters longer is the purple worm than the green worm?

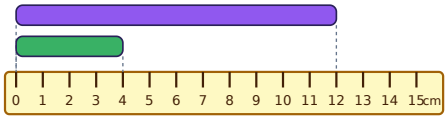

Task card 18 Comparing Lengths with a Ruler

How many inches longer is the orange straw than the green straw?

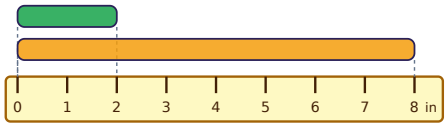

Task card 19 Comparing Lengths with a Ruler

How many centimeters longer is the red ribbon than the purple ribbon?

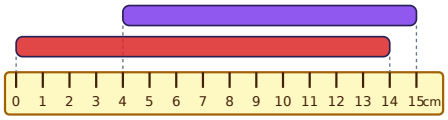

Task card 20 Comparing Lengths with a Ruler

The purple worm and the orange worm are put end to end. How long are they together, in inches?

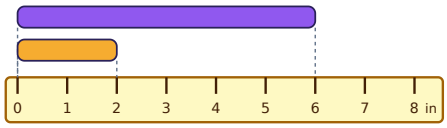

Task card 21 Comparing Lengths with a Ruler

The blue straw and the red straw are put end to end. How long are they together, in centimeters?

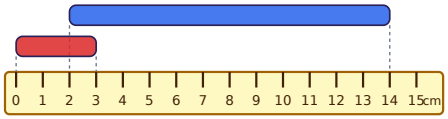

Task card 22 Comparing Lengths with a Ruler

The orange ribbon and the green ribbon are put end to end. How long are they together, in inches?

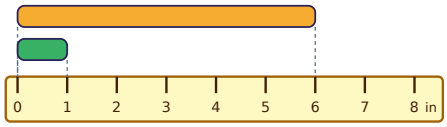

Task card 23 Comparing Lengths with a Ruler

The blue worm and the purple worm are put end to end. How long are they together, in centimeters?

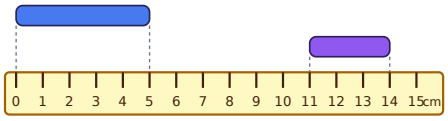

Task card 24 Comparing Lengths with a Ruler

How many inches longer is the purple straw than the orange straw?

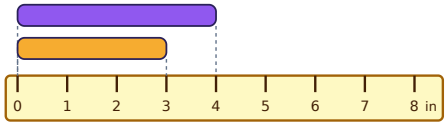

Comparing Lengths with a Ruler Task Cards

Recording sheet · Grade 2 · Measure both objects with the ruler, then answer the question.

Name: _____ Date: _____

Scan to check your answers

1	2	3	4
5	6	7	8
9	10	11	12
13	14	15	16
17	18	19	20
21	22	23	24

Comparing Lengths with a Ruler Task Cards: Answer Key

Grade 2 · Hard

The answers online

1. 9	**2.** 3	**3.** 6
4. 11	**5.** 2	**6.** 2
7. 1	**8.** 4	**9.** 7
10. 3	**11.** 2	**12.** 2
13. 2	**14.** 12	**15.** 3
16. 3	**17.** 8	**18.** 6
19. 3	**20.** 8	**21.** 15
22. 7	**23.** 8	**24.** 1