Task card 1 Comparing Lengths with a Ruler

The green string and the orange string are put end to end. How long are they together, in centimeters?

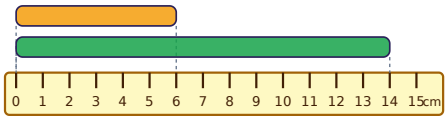

Task card 2 Comparing Lengths with a Ruler

How many inches longer is the red ribbon than the blue ribbon?

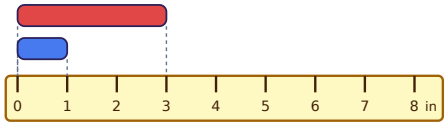

Task card 3 Comparing Lengths with a Ruler

How many centimeters longer is the green worm than the orange worm?

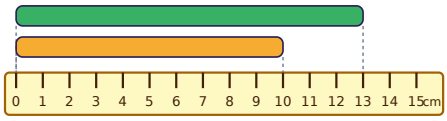

Task card 4 Comparing Lengths with a Ruler

How many inches longer is the green string than the red string?

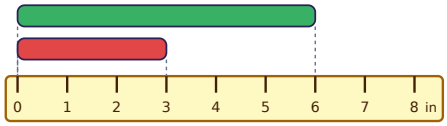

Task card 5 Comparing Lengths with a Ruler

How many centimeters longer is the red worm than the green worm?

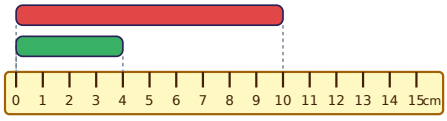

Task card 6 Comparing Lengths with a Ruler

How many inches longer is the purple straw than the orange straw?

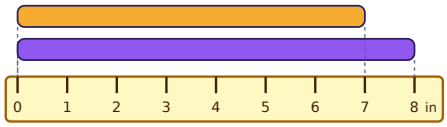

Task card 7 Comparing Lengths with a Ruler

How many centimeters longer is the green crayon than the orange crayon?

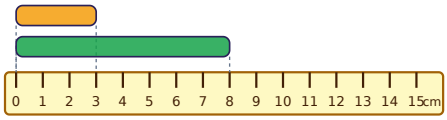

Task card 8 Comparing Lengths with a Ruler

The purple straw and the green straw are put end to end. How long are they together, in inches?

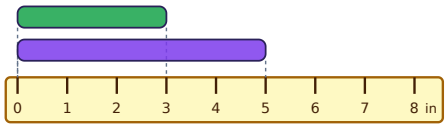

Task card 9 Comparing Lengths with a Ruler

How many centimeters longer is the red ribbon than the orange ribbon?

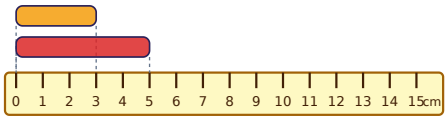

Task card 10 Comparing Lengths with a Ruler

How many inches longer is the blue worm than the orange worm?

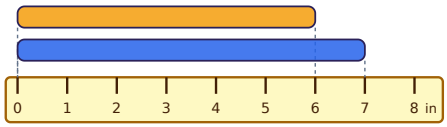

Task card 11 Comparing Lengths with a Ruler

How many centimeters longer is the blue string than the orange string?

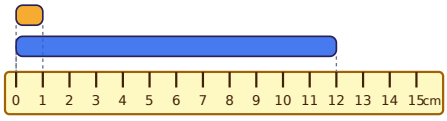

Task card 12 Comparing Lengths with a Ruler

The green ribbon and the purple ribbon are put end to end. How long are they together, in inches?

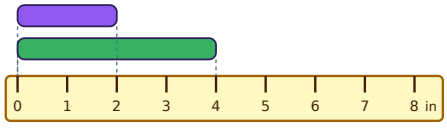

Task card 13 Comparing Lengths with a Ruler

How many centimeters longer is the orange ribbon than the red ribbon?

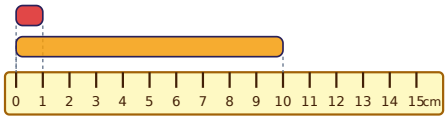

Task card 14 Comparing Lengths with a Ruler

How many inches longer is the red string than the blue string?

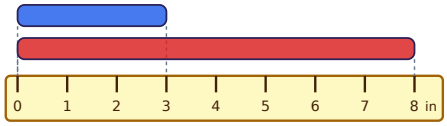

Task card 15 Comparing Lengths with a Ruler

How many centimeters longer is the orange crayon than the blue crayon?

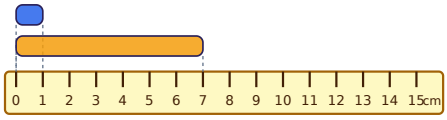

Task card 16 Comparing Lengths with a Ruler

The red string and the purple string are put end to end. How long are they together, in inches?

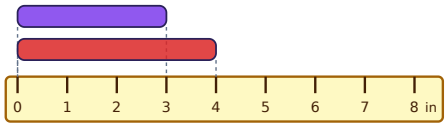

Task card 17 Comparing Lengths with a Ruler

The purple string and the green string are put end to end. How long are they together, in centimeters?

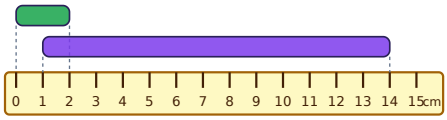

Task card 18 Comparing Lengths with a Ruler

How many inches longer is the green ribbon than the red ribbon?

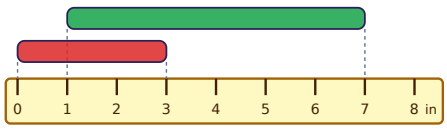

Task card 19 Comparing Lengths with a Ruler

How many centimeters longer is the orange ribbon than the green ribbon?

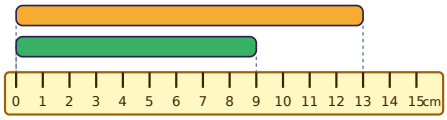

Task card 20 Comparing Lengths with a Ruler

The red crayon and the green crayon are put end to end. How long are they together, in inches?

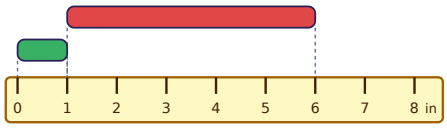

Task card 21 Comparing Lengths with a Ruler

How many centimeters longer is the green ribbon than the orange ribbon?

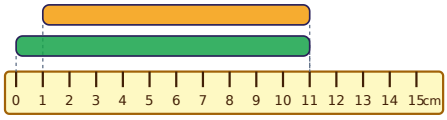

Task card 22 Comparing Lengths with a Ruler

The red worm and the green worm are put end to end. How long are they together, in inches?

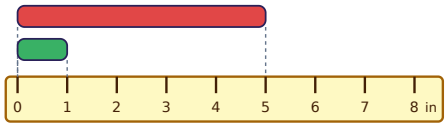

Task card 23 Comparing Lengths with a Ruler

How many centimeters longer is the red string than the orange string?

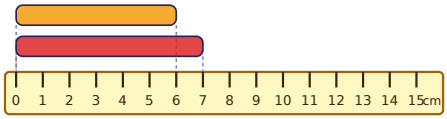

Task card 24 Comparing Lengths with a Ruler

How many inches longer is the red crayon than the green crayon?

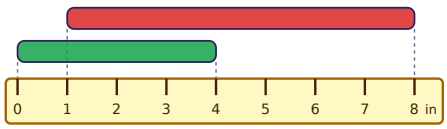

Comparing Lengths with a Ruler Task Cards

Recording sheet · Grade 2 · Measure both objects with the ruler, then answer the question.

Name: _____ Date: _____

Scan to check your answers

1	2	3	4
5	6	7	8
9	10	11	12
13	14	15	16
17	18	19	20
21	22	23	24

Comparing Lengths with a Ruler Task Cards: Answer Key

Grade 2 · Medium

The answers online

1. 20	**2.** 2	**3.** 3
4. 3	**5.** 6	**6.** 1
7. 5	**8.** 8	**9.** 2
10. 1	**11.** 11	**12.** 6
13. 9	**14.** 5	**15.** 6
16. 7	**17.** 15	**18.** 3
19. 4	**20.** 6	**21.** 1
22. 6	**23.** 1	**24.** 3