Comparing Lengths with a Ruler · 1

How many centimeters longer is the blue ribbon than the orange ribbon?

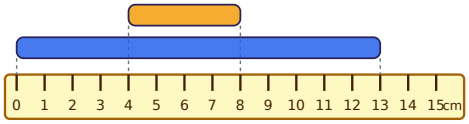

Comparing Lengths with a Ruler · 2

How many inches longer is the purple worm than the green worm?

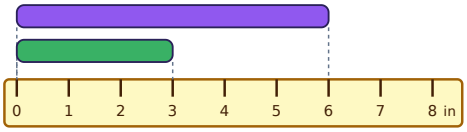

Comparing Lengths with a Ruler · 3

How many centimeters longer is the orange string than the blue string?

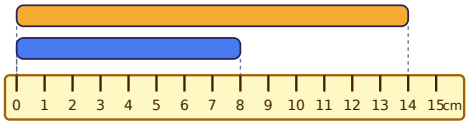

Comparing Lengths with a Ruler · 4

The red ribbon and the orange ribbon are put end to end. How long are they together, in inches?

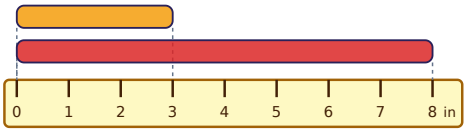

Comparing Lengths with a Ruler · 5

How many centimeters longer is the blue worm than the green worm?

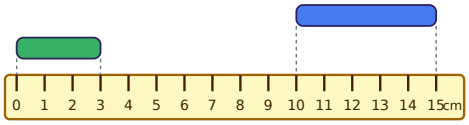

Comparing Lengths with a Ruler · 6

How many inches longer is the green string than the blue string?

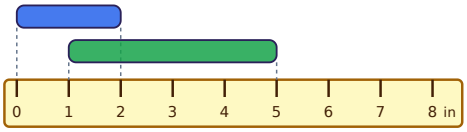

Comparing Lengths with a Ruler · 7

How many centimeters longer is the purple ribbon than the green ribbon?

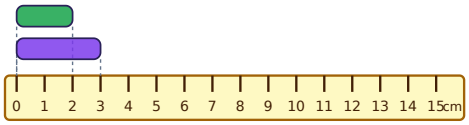

Comparing Lengths with a Ruler · 8

How many inches longer is the purple crayon than the blue crayon?

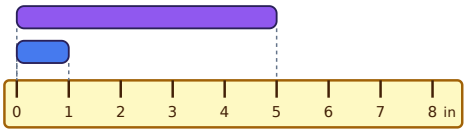

Comparing Lengths with a Ruler · 2

ANSWER

3

Comparing Lengths with a Ruler · 1

ANSWER

9

Comparing Lengths with a Ruler · 4

ANSWER

11

Comparing Lengths with a Ruler · 3

ANSWER

6

Comparing Lengths with a Ruler · 6

ANSWER

2

Comparing Lengths with a Ruler · 5

ANSWER

2

Comparing Lengths with a Ruler · 8

ANSWER

4

Comparing Lengths with a Ruler · 7

ANSWER

1

Comparing Lengths with a Ruler · 9

How many centimeters longer is the blue worm than the green worm?

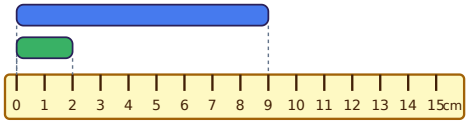

Comparing Lengths with a Ruler · 10

How many inches longer is the orange worm than the blue worm?

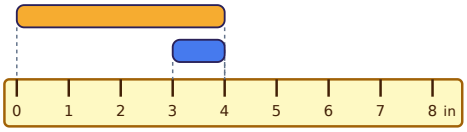

Comparing Lengths with a Ruler · 11

How many centimeters longer is the green crayon than the orange crayon?

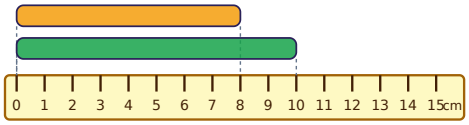

Comparing Lengths with a Ruler · 12

How many inches longer is the green crayon than the red crayon?

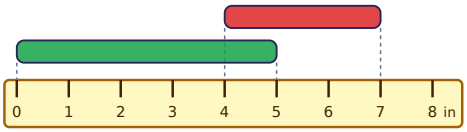

Comparing Lengths with a Ruler · 13

How many centimeters longer is the purple string than the red string?

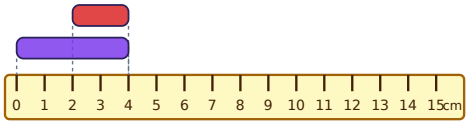

Comparing Lengths with a Ruler · 14

The green ribbon and the orange ribbon are put end to end. How long are they together, in inches?

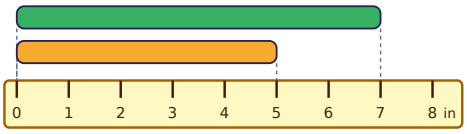

Comparing Lengths with a Ruler · 15

How many centimeters longer is the purple straw than the blue straw?

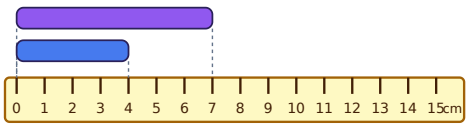

Comparing Lengths with a Ruler · 16

How many inches longer is the green worm than the purple worm?

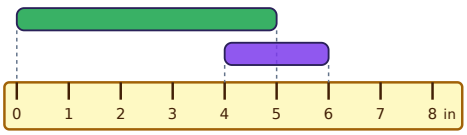

Comparing Lengths with a Ruler · 10

ANSWER

3

Comparing Lengths with a Ruler · 9

ANSWER

7

Comparing Lengths with a Ruler · 12

ANSWER

2

Comparing Lengths with a Ruler · 11

ANSWER

2

Comparing Lengths with a Ruler · 14

ANSWER

12

Comparing Lengths with a Ruler · 13

ANSWER

2

Comparing Lengths with a Ruler · 16

ANSWER

3

Comparing Lengths with a Ruler · 15

ANSWER

3

Comparing Lengths with a Ruler · 17

How many centimeters longer is the purple worm than the green worm?

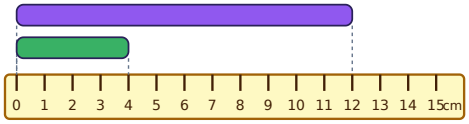

Comparing Lengths with a Ruler · 18

How many inches longer is the orange straw than the green straw?

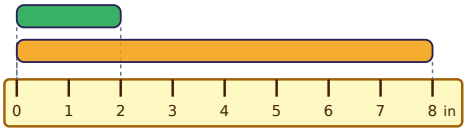

Comparing Lengths with a Ruler · 19

How many centimeters longer is the red ribbon than the purple ribbon?

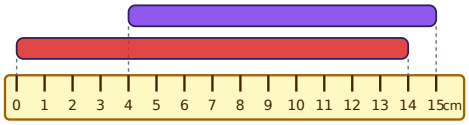

Comparing Lengths with a Ruler · 20

The purple worm and the orange worm are put end to end. How long are they together, in inches?

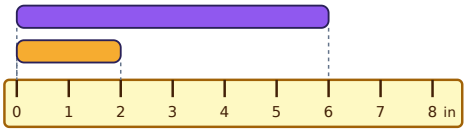

Comparing Lengths with a Ruler · 21

The blue straw and the red straw are put end to end. How long are they together, in centimeters?

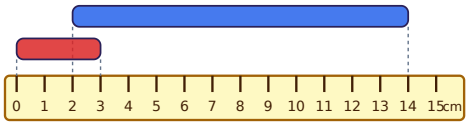

Comparing Lengths with a Ruler · 22

The orange ribbon and the green ribbon are put end to end. How long are they together, in inches?

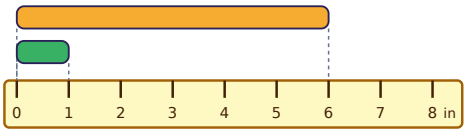

Comparing Lengths with a Ruler · 23

The blue worm and the purple worm are put end to end. How long are they together, in centimeters?

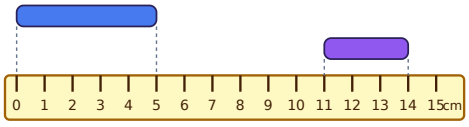

Comparing Lengths with a Ruler · 24

How many inches longer is the purple straw than the orange straw?

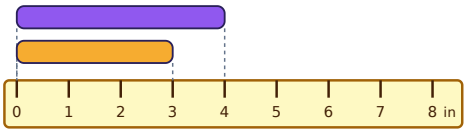

Comparing Lengths with a Ruler · 18

ANSWER

6

Comparing Lengths with a Ruler · 17

ANSWER

8

Comparing Lengths with a Ruler · 20

ANSWER

8

Comparing Lengths with a Ruler · 19

ANSWER

3

Comparing Lengths with a Ruler · 22

ANSWER

7

Comparing Lengths with a Ruler · 21

ANSWER

15

Comparing Lengths with a Ruler · 24

ANSWER

1

Comparing Lengths with a Ruler · 23

ANSWER

8