Comparing Lengths with a Ruler · 1

How many centimeters longer is the green crayon than the orange crayon?

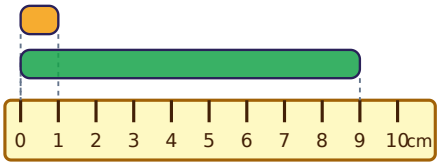

Comparing Lengths with a Ruler · 2

How many centimeters longer is the purple crayon than the orange crayon?

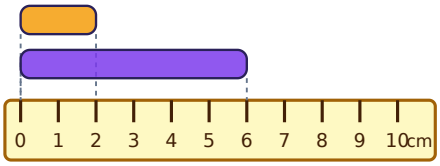

Comparing Lengths with a Ruler · 3

How many centimeters longer is the blue worm than the green worm?

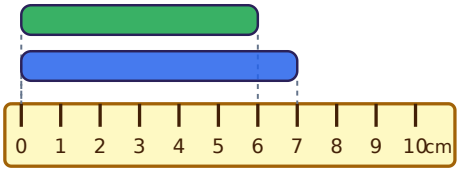

Comparing Lengths with a Ruler · 4

How many centimeters longer is the red worm than the green worm?

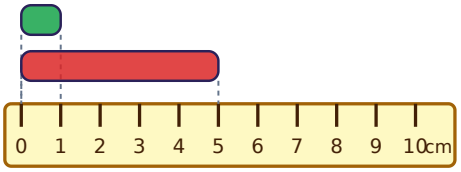

Comparing Lengths with a Ruler · 5

How many centimeters longer is the purple straw than the green straw?

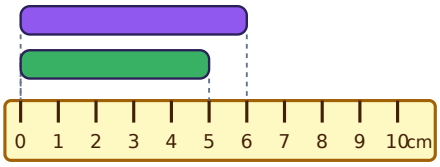

Comparing Lengths with a Ruler · 6

How many centimeters longer is the purple straw than the green straw?

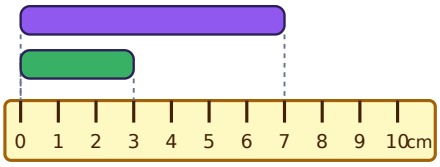

Comparing Lengths with a Ruler · 7

How many centimeters longer is the green worm than the orange worm?

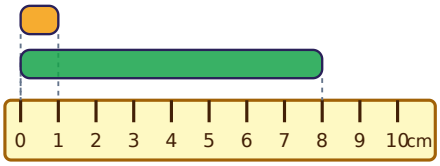

Comparing Lengths with a Ruler · 8

How many centimeters longer is the purple ribbon than the green ribbon?

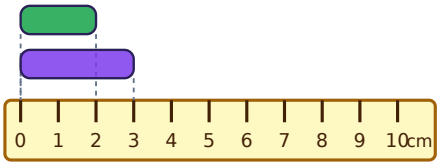

Comparing Lengths with a Ruler · 2

ANSWER

4

Comparing Lengths with a Ruler · 1

ANSWER

8

Comparing Lengths with a Ruler · 4

ANSWER

4

Comparing Lengths with a Ruler · 3

ANSWER

1

Comparing Lengths with a Ruler · 6

ANSWER

4

Comparing Lengths with a Ruler · 5

ANSWER

1

Comparing Lengths with a Ruler · 8

ANSWER

1

Comparing Lengths with a Ruler · 7

ANSWER

7

Comparing Lengths with a Ruler · 9

How many centimeters longer is the red worm than the green worm?

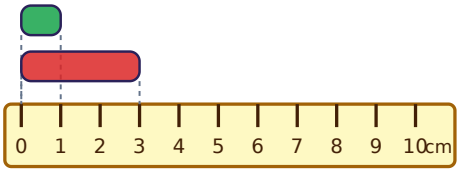

Comparing Lengths with a Ruler · 10

How many centimeters longer is the blue ribbon than the orange ribbon?

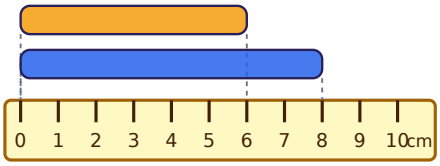

Comparing Lengths with a Ruler · 11

How many centimeters longer is the red string than the blue string?

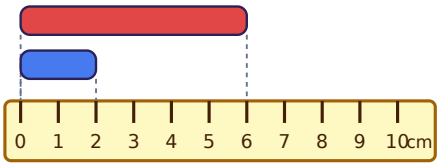

Comparing Lengths with a Ruler · 12

How many centimeters longer is the purple worm than the red worm?

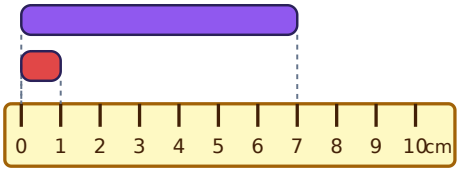

Comparing Lengths with a Ruler · 13

How many centimeters longer is the green crayon than the orange crayon?

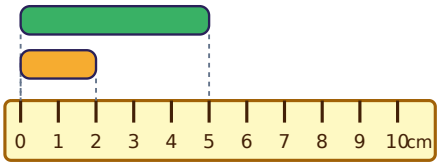

Comparing Lengths with a Ruler · 14

How many centimeters longer is the purple straw than the orange straw?

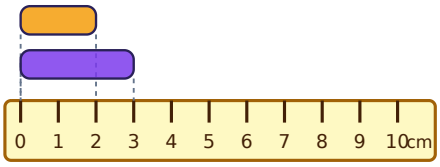

Comparing Lengths with a Ruler · 15

How many centimeters longer is the orange crayon than the blue crayon?

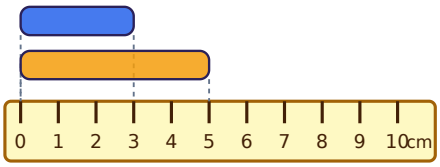

Comparing Lengths with a Ruler · 16

How many centimeters longer is the orange ribbon than the purple ribbon?

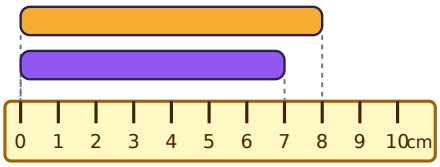

Comparing Lengths with a Ruler · 10

ANSWER

2

Comparing Lengths with a Ruler · 9

ANSWER

2

Comparing Lengths with a Ruler · 12

ANSWER

6

Comparing Lengths with a Ruler · 11

ANSWER

4

Comparing Lengths with a Ruler · 14

ANSWER

1

Comparing Lengths with a Ruler · 13

ANSWER

3

Comparing Lengths with a Ruler · 16

ANSWER

1

Comparing Lengths with a Ruler · 15

ANSWER

2

Comparing Lengths with a Ruler · 17

How many centimeters longer is the red straw than the green straw?

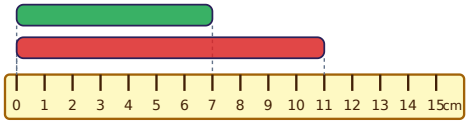

Comparing Lengths with a Ruler · 18

How many inches longer is the orange ribbon than the blue ribbon?

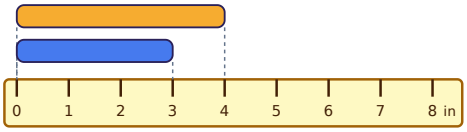

Comparing Lengths with a Ruler · 19

How many centimeters longer is the green straw than the red straw?

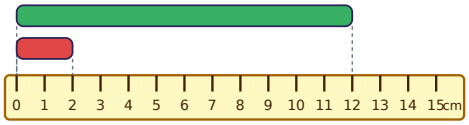

Comparing Lengths with a Ruler · 20

How many inches longer is the red worm than the green worm?

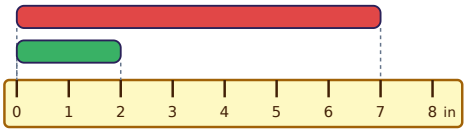

Comparing Lengths with a Ruler · 21

How many centimeters longer is the green ribbon than the orange ribbon?

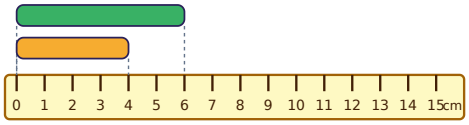

Comparing Lengths with a Ruler · 22

How many inches longer is the blue ribbon than the red ribbon?

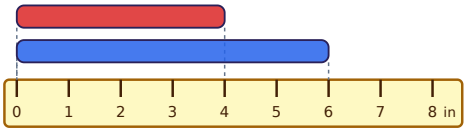

Comparing Lengths with a Ruler · 23

How many centimeters longer is the purple straw than the blue straw?

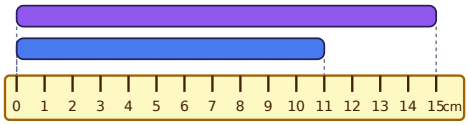

Comparing Lengths with a Ruler · 24

How many inches longer is the purple straw than the blue straw?

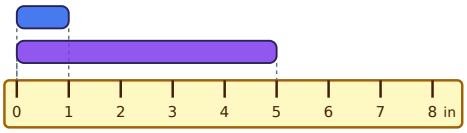

Comparing Lengths with a Ruler · 18

ANSWER

1

Comparing Lengths with a Ruler · 17

ANSWER

4

Comparing Lengths with a Ruler · 20

ANSWER

5

Comparing Lengths with a Ruler · 19

ANSWER

10

Comparing Lengths with a Ruler · 22

ANSWER

2

Comparing Lengths with a Ruler · 21

ANSWER

2

Comparing Lengths with a Ruler · 24

ANSWER

4

Comparing Lengths with a Ruler · 23

ANSWER

4