Task card 1 Christmas Math

The bakery makes 79 cookies. It sells 65 of them. How many cookies are left?

Task card 2 Christmas Math

Mia buys a paper snowflake for 10¢ and a ornament for 30¢. How many cents does Mia spend?

Task card 3 Christmas Math

Sam puts 5 candy canes on each of 4 plates. How many candy canes is that in all?



Task card 4 Christmas Math

Ava puts 5 cookies on each of 2 plates. How many cookies is that in all?



Task card 5 Christmas Math

Mia buys a paper snowflake for 15¢ and a bow for 20¢. How many cents does Mia spend?

Task card 6 Christmas Math

The school bakes 46 candy canes and 31 cookies for the bake sale. How many treats is that in all?

Task card 7 Christmas Math

The school bakes 17 cookies and 53 gingerbread men for the bake sale. How many treats is that in all?

Task card 8 Christmas Math

The bakery makes 43 gingerbread men. It sells 29 of them. How many gingerbread men are left?

Task card 9 Christmas Math

The bakery makes 103 cookies. It sells 77 of them. How many cookies are left?

Task card 10 Christmas Math

Ben buys a paper snowflake for 25¢ and a ornament for 5¢. How many cents does Ben spend?

Task card 11 Christmas Math

Mia puts 2 cookies on each of 2 plates. How many cookies is that in all?



Task card 12 Christmas Math

Leo buys a ornament for 15¢ and a bow for 25¢. How many cents does Leo spend?

Task card 13 Christmas Math

Mia puts 3 gingerbread men on each of 3 plates. How many gingerbread men is that in all?



Task card 14 Christmas Math

The school bakes 89 gingerbread men and 164 candy canes for the bake sale. How many treats is that in all?

Task card 15 Christmas Math

The school bakes 244 gingerbread men and 100 candy canes for the bake sale. How many treats is that in all?

Task card 16 Christmas Math

The bakery makes 352 cookies. It sells 112 of them. How many cookies are left?

Task card 17 Christmas Math

Ella puts 2 cookies on each of 2 plates. How many cookies is that in all?



Task card 18 Christmas Math

The school bakes 236 cookies and 51 candy canes for the bake sale. How many treats is that in all?

Task card 19 Christmas Math

The bakery makes 306 cookies. It sells 41 of them. How many cookies are left?

Task card 20 Christmas Math

Ava buys a ornament for 15¢ and a paper snowflake for 40¢. How many cents does Ava spend?

Task card 21 Christmas Math

The bakery makes 41 cookies. It sells 12 of them. How many cookies are left?

Task card 22 Christmas Math

The school bakes 159 cookies and 18 gingerbread men for the bake sale. How many treats is that in all?

Task card 23 Christmas Math

Sam buys a bow for 40¢ and a paper snowflake for 45¢. How many cents does Sam spend?

Task card 24 Christmas Math

Sam puts 2 gingerbread men on each of 3 plates. How many gingerbread men is that in all?



Christmas Math Task Cards

Recording sheet · Grade 2 · Read each story and solve.

Name: _____ Date: _____

Scan to check your answers

1	2	3	4
5	6	7	8
9	10	11	12
13	14	15	16
17	18	19	20
21	22	23	24

Christmas Math Task Cards: Answer Key

Grade 2 · Medium

The answers online

1. 14	**2.** 40	**3.** 20
4. 10	**5.** 35	**6.** 77
7. 70	**8.** 14	**9.** 26
10. 30	**11.** 4	**12.** 40
13. 9	**14.** 253	**15.** 344
16. 240	**17.** 4	**18.** 287
19. 265	**20.** 55	**21.** 29
22. 177	**23.** 85	**24.** 6