Task card 1 Christmas Math

The bakery makes 59 gingerbread men. It sells 44 of them. How many gingerbread men are left?

Task card 2 Christmas Math

The bakery makes 47 cookies. It sells 17 of them. How many cookies are left?

Task card 3 Christmas Math

Lily puts 2 cookies on each of 2 plates. How many cookies is that in all?



Task card 4 Christmas Math

The school bakes 44 gingerbread men and 47 candy canes for the bake sale. How many treats is that in all?

Task card 5 Christmas Math

Ava buys a ornament for 25¢ and a paper snowflake for 25¢. How many cents does Ava spend?

Task card 6 Christmas Math

The school bakes 37 candy canes and 33 gingerbread men for the bake sale. How many treats is that in all?

Task card 7 Christmas Math

Zoe buys a paper snowflake for 30¢ and a ornament for 10¢. How many cents does Zoe spend?

Task card 8 Christmas Math

Ben puts 3 gingerbread men on each of 2 plates. How many gingerbread men is that in all?



Task card 9 Christmas Math

Lily buys a bow for 40¢ and a paper snowflake for 15¢. How many cents does Lily spend?

Task card 10 Christmas Math

The bakery makes 51 candy canes. It sells 28 of them. How many candy canes are left?

Task card 11 Christmas Math

The school bakes 42 candy canes and 28 gingerbread men for the bake sale. How many treats is that in all?

Task card 12 Christmas Math

Leo puts 5 gingerbread men on each of 2 plates. How many gingerbread men is that in all?



Task card 13 Christmas Math

The school bakes 21 candy canes and 40 cookies for the bake sale. How many treats is that in all?

Task card 14 Christmas Math

Ava buys a paper snowflake for 40¢ and a ornament for 15¢. How many cents does Ava spend?

Task card 15 Christmas Math

Ella puts 3 candy canes on each of 2 plates. How many candy canes is that in all?



Task card 16 Christmas Math

The bakery makes 68 cookies. It sells 43 of them. How many cookies are left?

Task card 17 Christmas Math

Ella buys a ornament for 40¢ and a paper snowflake for 20¢. How many cents does Ella spend?

Task card 18 Christmas Math

Zoe puts 2 gingerbread men on each of 2 plates. How many gingerbread men is that in all?



Task card 19 Christmas Math

The bakery makes 66 gingerbread men. It sells 59 of them. How many gingerbread men are left?

Task card 20 Christmas Math

The bakery makes 37 candy canes. It sells 31 of them. How many candy canes are left?

Task card 21 Christmas Math

The school bakes 17 cookies and 12 gingerbread men for the bake sale. How many treats is that in all?

Task card 22 Christmas Math

The school bakes 24 cookies and 34 candy canes for the bake sale. How many treats is that in all?

Task card 23 Christmas Math

Omar buys a ornament for 20¢ and a bow for 20¢. How many cents does Omar spend?

Task card 24 Christmas Math

Lily puts 5 gingerbread men on each of 3 plates. How many gingerbread men is that in all?



Christmas Math Task Cards

Recording sheet · Grade 2 · Read each story and solve.

Name: _____ Date: _____

Scan to check your answers

1	2	3	4
5	6	7	8
9	10	11	12
13	14	15	16
17	18	19	20
21	22	23	24

Christmas Math Task Cards: Answer Key

Grade 2 · Easy

The answers online

1. 15	**2.** 30	**3.** 4
4. 91	**5.** 50	**6.** 70
7. 40	**8.** 6	**9.** 55
10. 23	**11.** 70	**12.** 10
13. 61	**14.** 55	**15.** 6
16. 25	**17.** 60	**18.** 4
19. 7	**20.** 6	**21.** 29
22. 58	**23.** 40	**24.** 15