Christmas Math · 1

The bakery makes 79 cookies. It sells 65 of them. How many cookies are left?

Christmas Math · 2

Mia buys a paper snowflake for 10¢ and a ornament for 30¢. How many cents does Mia spend?

Christmas Math · 3

Sam puts 5 candy canes on each of 4 plates. How many candy canes is that in all?



Christmas Math · 4

Ava puts 5 cookies on each of 2 plates. How many cookies is that in all?



Christmas Math · 5

Mia buys a paper snowflake for 15¢ and a bow for 20¢. How many cents does Mia spend?

Christmas Math · 6

The school bakes 46 candy canes and 31 cookies for the bake sale. How many treats is that in all?

Christmas Math · 7

The school bakes 17 cookies and 53 gingerbread men for the bake sale. How many treats is that in all?

Christmas Math · 8

The bakery makes 43 gingerbread men. It sells 29 of them. How many gingerbread men are left?

Christmas Math · 2

ANSWER

40

Christmas Math · 1

ANSWER

14

Christmas Math · 4

ANSWER

10

Christmas Math · 3

ANSWER

20

Christmas Math · 6

ANSWER

77

Christmas Math · 5

ANSWER

35

Christmas Math · 8

ANSWER

14

Christmas Math · 7

ANSWER

70

Christmas Math · 9

The bakery makes 103 cookies. It sells 77 of them. How many cookies are left?

Christmas Math · 10

Ben buys a paper snowflake for 25¢ and a ornament for 5¢. How many cents does Ben spend?

Christmas Math · 11

Mia puts 2 cookies on each of 2 plates. How many cookies is that in all?



Christmas Math · 12

Leo buys a ornament for 15¢ and a bow for 25¢. How many cents does Leo spend?

Christmas Math · 13

Mia puts 3 gingerbread men on each of 3 plates. How many gingerbread men is that in all?



Christmas Math · 14

The school bakes 89 gingerbread men and 164 candy canes for the bake sale. How many treats is that in all?

Christmas Math · 15

The school bakes 244 gingerbread men and 100 candy canes for the bake sale. How many treats is that in all?

Christmas Math · 16

The bakery makes 352 cookies. It sells 112 of them. How many cookies are left?

Christmas Math · 10

ANSWER

30

Christmas Math · 9

ANSWER

26

Christmas Math · 12

ANSWER

40

Christmas Math · 11

ANSWER

4

Christmas Math · 14

ANSWER

253

Christmas Math · 13

ANSWER

9

Christmas Math · 16

ANSWER

240

Christmas Math · 15

ANSWER

344

Christmas Math · 17

Ella puts 2 cookies on each of 2 plates. How many cookies is that in all?



Christmas Math · 18

The school bakes 236 cookies and 51 candy canes for the bake sale. How many treats is that in all?

Christmas Math · 19

The bakery makes 306 cookies. It sells 41 of them. How many cookies are left?

Christmas Math · 20

Ava buys a ornament for 15¢ and a paper snowflake for 40¢. How many cents does Ava spend?

Christmas Math · 21

The bakery makes 41 cookies. It sells 12 of them. How many cookies are left?

Christmas Math · 22

The school bakes 159 cookies and 18 gingerbread men for the bake sale. How many treats is that in all?

Christmas Math · 23

Sam buys a bow for 40¢ and a paper snowflake for 45¢. How many cents does Sam spend?

Christmas Math · 24

Sam puts 2 gingerbread men on each of 3 plates. How many gingerbread men is that in all?



Christmas Math · 18

ANSWER

287

Christmas Math · 17

ANSWER

4

Christmas Math · 20

ANSWER

55

Christmas Math · 19

ANSWER

265

Christmas Math · 22

ANSWER

177

Christmas Math · 21

ANSWER

29

Christmas Math · 24

ANSWER

6

Christmas Math · 23

ANSWER

85