Christmas Math · 1

The bakery makes 59 gingerbread men. It sells 44 of them. How many gingerbread men are left?

Christmas Math · 2

The bakery makes 47 cookies. It sells 17 of them. How many cookies are left?

Christmas Math · 3

Lily puts 2 cookies on each of 2 plates. How many cookies is that in all?



Christmas Math · 4

The school bakes 44 gingerbread men and 47 candy canes for the bake sale. How many treats is that in all?

Christmas Math · 5

Ava buys a ornament for 25¢ and a paper snowflake for 25¢. How many cents does Ava spend?

Christmas Math · 6

The school bakes 37 candy canes and 33 gingerbread men for the bake sale. How many treats is that in all?

Christmas Math · 7

Zoe buys a paper snowflake for 30¢ and a ornament for 10¢. How many cents does Zoe spend?

Christmas Math · 8

Ben puts 3 gingerbread men on each of 2 plates. How many gingerbread men is that in all?



Christmas Math · 2

**ANSWER**

**30**

Christmas Math · 1

**ANSWER**

**15**

Christmas Math · 4

**ANSWER**

**91**

Christmas Math · 3

**ANSWER**

**4**

Christmas Math · 6

**ANSWER**

**70**

Christmas Math · 5

**ANSWER**

**50**

Christmas Math · 8

**ANSWER**

**6**

Christmas Math · 7

**ANSWER**

**40**

Christmas Math · 9

Lily buys a bow for 40¢ and a paper snowflake for 15¢. How many cents does Lily spend?

Christmas Math · 10

The bakery makes 51 candy canes. It sells 28 of them. How many candy canes are left?

Christmas Math · 11

The school bakes 42 candy canes and 28 gingerbread men for the bake sale. How many treats is that in all?

Christmas Math · 12

Leo puts 5 gingerbread men on each of 2 plates. How many gingerbread men is that in all?



Christmas Math · 13

The school bakes 21 candy canes and 40 cookies for the bake sale. How many treats is that in all?

Christmas Math · 14

Ava buys a paper snowflake for 40¢ and a ornament for 15¢. How many cents does Ava spend?

Christmas Math · 15

Ella puts 3 candy canes on each of 2 plates. How many candy canes is that in all?



Christmas Math · 16

The bakery makes 68 cookies. It sells 43 of them. How many cookies are left?

Christmas Math · 10

**ANSWER**

**23**

Christmas Math · 9

**ANSWER**

**55**

Christmas Math · 12

**ANSWER**

**10**

Christmas Math · 11

**ANSWER**

**70**

Christmas Math · 14

**ANSWER**

**55**

Christmas Math · 13

**ANSWER**

**61**

Christmas Math · 16

**ANSWER**

**25**

Christmas Math · 15

**ANSWER**

**6**

Christmas Math · 17

Ella buys a ornament for 40¢ and a paper snowflake for 20¢. How many cents does Ella spend?

Christmas Math · 18

Zoe puts 2 gingerbread men on each of 2 plates. How many gingerbread men is that in all?



Christmas Math · 19

The bakery makes 66 gingerbread men. It sells 59 of them. How many gingerbread men are left?

Christmas Math · 20

The bakery makes 37 candy canes. It sells 31 of them. How many candy canes are left?

Christmas Math · 21

The school bakes 17 cookies and 12 gingerbread men for the bake sale. How many treats is that in all?

Christmas Math · 22

The school bakes 24 cookies and 34 candy canes for the bake sale. How many treats is that in all?

Christmas Math · 23

Omar buys a ornament for 20¢ and a bow for 20¢. How many cents does Omar spend?

Christmas Math · 24

Lily puts 5 gingerbread men on each of 3 plates. How many gingerbread men is that in all?



Christmas Math · 18

**ANSWER**

# 4

Christmas Math · 17

**ANSWER**

# 60

Christmas Math · 20

**ANSWER**

# 6

Christmas Math · 19

**ANSWER**

# 7

Christmas Math · 22

**ANSWER**

# 58

Christmas Math · 21

**ANSWER**

# 29

Christmas Math · 24

**ANSWER**

# 15

Christmas Math · 23

**ANSWER**

# 40