Christmas Math · 1

The bakery makes 59 gingerbread men. It sells 44 of them. How many gingerbread men are left?

Christmas Math · 2

The bakery makes 47 cookies. It sells 17 of them. How many cookies are left?

Christmas Math · 3

Lily puts 2 cookies on each of 2 plates. How many cookies is that in all?



Christmas Math · 4

The school bakes 44 gingerbread men and 47 candy canes for the bake sale. How many treats is that in all?

Christmas Math · 5

Ava buys a ornament for 25¢ and a paper snowflake for 25¢. How many cents does Ava spend?

Christmas Math · 6

The school bakes 37 candy canes and 33 gingerbread men for the bake sale. How many treats is that in all?

Christmas Math · 7

Zoe buys a paper snowflake for 30¢ and a ornament for 10¢. How many cents does Zoe spend?

Christmas Math · 8

Ben puts 3 gingerbread men on each of 2 plates. How many gingerbread men is that in all?



Christmas Math · 2

ANSWER

30

Christmas Math · 1

ANSWER

15

Christmas Math · 4

ANSWER

91

Christmas Math · 3

ANSWER

4

Christmas Math · 6

ANSWER

70

Christmas Math · 5

ANSWER

50

Christmas Math · 8

ANSWER

6

Christmas Math · 7

ANSWER

40

Christmas Math · 9

Lily buys a bow for 40¢ and a paper snowflake for 15¢. How many cents does Lily spend?

Christmas Math · 10

The bakery makes 51 candy canes. It sells 28 of them. How many candy canes are left?

Christmas Math · 11

The school bakes 42 candy canes and 28 gingerbread men for the bake sale. How many treats is that in all?

Christmas Math · 12

Leo puts 5 gingerbread men on each of 2 plates. How many gingerbread men is that in all?



Christmas Math · 13

The school bakes 21 candy canes and 40 cookies for the bake sale. How many treats is that in all?

Christmas Math · 14

Ava buys a paper snowflake for 40¢ and a ornament for 15¢. How many cents does Ava spend?

Christmas Math · 15

Ella puts 3 candy canes on each of 2 plates. How many candy canes is that in all?



Christmas Math · 16

The bakery makes 68 cookies. It sells 43 of them. How many cookies are left?

Christmas Math · 10

ANSWER

23

Christmas Math · 9

ANSWER

55

Christmas Math · 12

ANSWER

10

Christmas Math · 11

ANSWER

70

Christmas Math · 14

ANSWER

55

Christmas Math · 13

ANSWER

61

Christmas Math · 16

ANSWER

25

Christmas Math · 15

ANSWER

6

Christmas Math · 17

Ella buys a ornament for 40¢ and a paper snowflake for 20¢. How many cents does Ella spend?

Christmas Math · 18

Zoe puts 2 gingerbread men on each of 2 plates. How many gingerbread men is that in all?



Christmas Math · 19

The bakery makes 66 gingerbread men. It sells 59 of them. How many gingerbread men are left?

Christmas Math · 20

The bakery makes 37 candy canes. It sells 31 of them. How many candy canes are left?

Christmas Math · 21

The school bakes 17 cookies and 12 gingerbread men for the bake sale. How many treats is that in all?

Christmas Math · 22

The school bakes 24 cookies and 34 candy canes for the bake sale. How many treats is that in all?

Christmas Math · 23

Omar buys a ornament for 20¢ and a bow for 20¢. How many cents does Omar spend?

Christmas Math · 24

Lily puts 5 gingerbread men on each of 3 plates. How many gingerbread men is that in all?



Christmas Math · 18

ANSWER

4

Christmas Math · 17

ANSWER

60

Christmas Math · 20

ANSWER

6

Christmas Math · 19

ANSWER

7

Christmas Math · 22

ANSWER

58

Christmas Math · 21

ANSWER

29

Christmas Math · 24

ANSWER

15

Christmas Math · 23

ANSWER

40