Bar Graphs · 1

How many students voted in all?

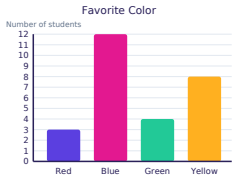

Bar Graphs · 2

How many more students chose Spring than Fall?

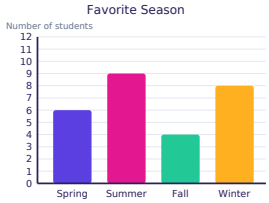

Bar Graphs · 3

How many students did not choose Pizza?

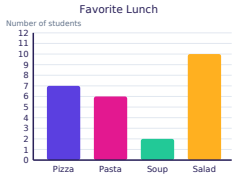

Bar Graphs · 4

How many students chose Summer or Winter?

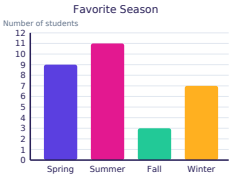

Bar Graphs · 5

How many fewer students chose Pasta than Pizza?

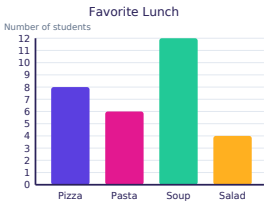

Bar Graphs · 6

3 more students choose Pears. How many students chose Pears now?

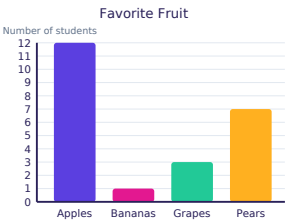

Bar Graphs · 7

How many students voted in all?

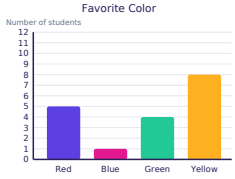

Bar Graphs · 8

How many more students chose Summer than Winter?

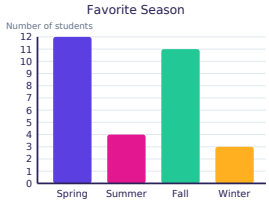

Bar Graphs · 2

ANSWER

2

Bar Graphs · 1

ANSWER

27

Bar Graphs · 4

ANSWER

18

Bar Graphs · 3

ANSWER

18

Bar Graphs · 6

ANSWER

10

Bar Graphs · 5

ANSWER

2

Bar Graphs · 8

ANSWER

1

Bar Graphs · 7

ANSWER

18

Bar Graphs · 9

How many students voted in all?

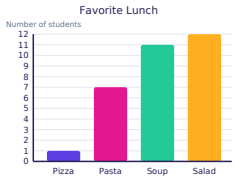

Bar Graphs · 10

How many more students chose Vanilla than Chocolate?

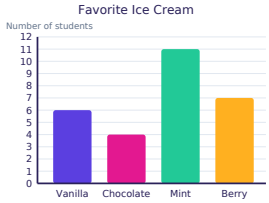

Bar Graphs · 11

How many students did not choose Winter?

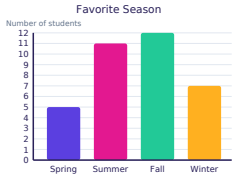

Bar Graphs · 12

How many students chose Tennis or Hockey?

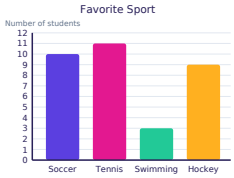

Bar Graphs · 13

How many fewer students chose Dogs than Cats?

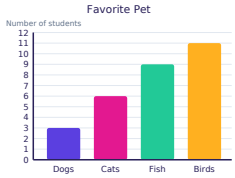

Bar Graphs · 14

4 more students choose Apples. How many students chose Apples now?

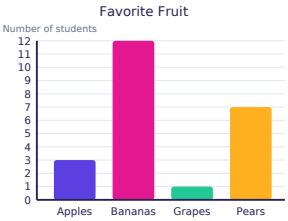

Bar Graphs · 15

How many students voted in all?

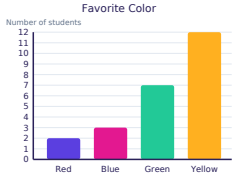

Bar Graphs · 16

How many more students chose Fall than Summer?

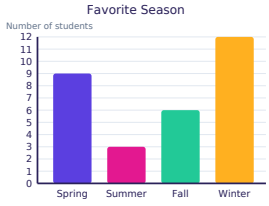

Bar Graphs · 10

ANSWER

2

Bar Graphs · 9

ANSWER

31

Bar Graphs · 12

ANSWER

20

Bar Graphs · 11

ANSWER

28

Bar Graphs · 14

ANSWER

7

Bar Graphs · 13

ANSWER

3

Bar Graphs · 16

ANSWER

3

Bar Graphs · 15

ANSWER

24

Bar Graphs · 17

How many students voted in all?

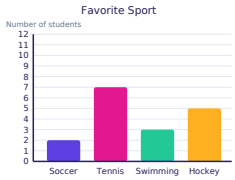

Bar Graphs · 18

How many more students chose Bananas than Grapes?

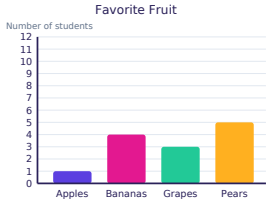

Bar Graphs · 19

How many students did not choose Spring?

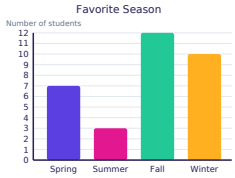

Bar Graphs · 20

How many students chose Hockey or Swimming?

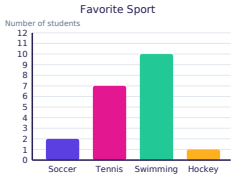

Bar Graphs · 21

How many fewer students chose Chocolate than Berry?

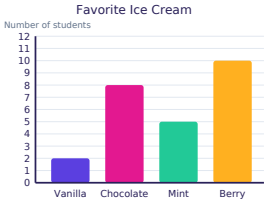

Bar Graphs · 22

2 more students choose Blue. How many students chose Blue now?

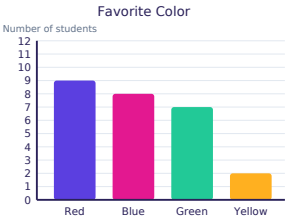

Bar Graphs · 23

How many students voted in all?

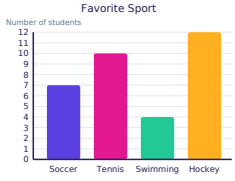

Bar Graphs · 24

How many more students chose Birds than Fish?

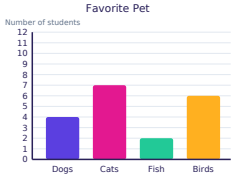

Bar Graphs · 18

ANSWER

1

Bar Graphs · 17

ANSWER

17

Bar Graphs · 20

ANSWER

11

Bar Graphs · 19

ANSWER

25

Bar Graphs · 22

ANSWER

10

Bar Graphs · 21

ANSWER

2

Bar Graphs · 24

ANSWER

4

Bar Graphs · 23

ANSWER

33