Bar Graphs · 1

How many students chose Soup?

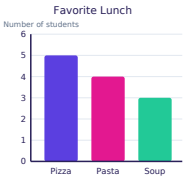

Bar Graphs · 2

Which sport did the most students choose?

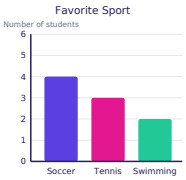

Bar Graphs · 3

How many students chose Red?

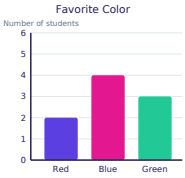

Bar Graphs · 4

Which lunch did the fewest students choose?

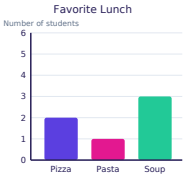

Bar Graphs · 5

How many students chose Vanilla?



Bar Graphs · 6

Which color did the most students choose?

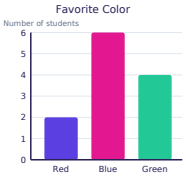

Bar Graphs · 7

How many students chose Apples?

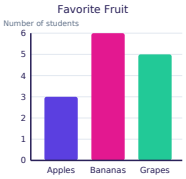

Bar Graphs · 8

Which season did the fewest students choose?

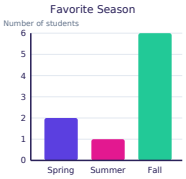

Bar Graphs · 2

ANSWER

Soccer

Bar Graphs · 1

ANSWER

3

Bar Graphs · 4

ANSWER

Pasta

Bar Graphs · 3

ANSWER

2

Bar Graphs · 6

ANSWER

Blue

Bar Graphs · 5

ANSWER

2

Bar Graphs · 8

ANSWER

Summer

Bar Graphs · 7

ANSWER

3

Bar Graphs · 9

How many students chose Mint?

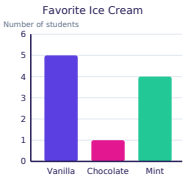

Bar Graphs · 10

Which lunch did the most students choose?

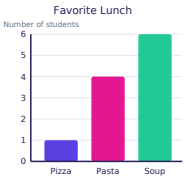

Bar Graphs · 11

How many students chose Bananas?

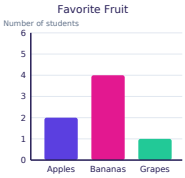

Bar Graphs · 12

Which season did the fewest students choose?

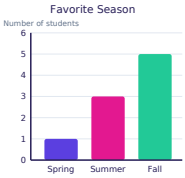

Bar Graphs · 13

How many students chose Vanilla?



Bar Graphs · 14

Which pet did the most students choose?

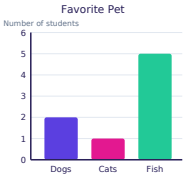

Bar Graphs · 15

How many students chose Tennis?

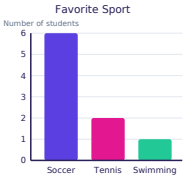

Bar Graphs · 16

Which fruit did the fewest students choose?

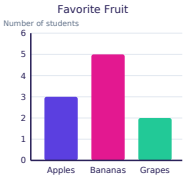

Bar Graphs · 10

ANSWER

Soup

Bar Graphs · 9

ANSWER

4

Bar Graphs · 12

ANSWER

Spring

Bar Graphs · 11

ANSWER

4

Bar Graphs · 14

ANSWER

Fish

Bar Graphs · 13

ANSWER

3

Bar Graphs · 16

ANSWER

Grapes

Bar Graphs · 15

ANSWER

2

Bar Graphs · 17

How many students chose Winter?

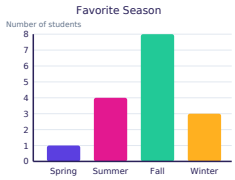

Bar Graphs · 18

How many more students chose Salad than Pizza?

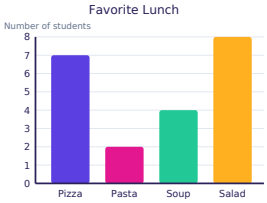

Bar Graphs · 19

Which season did the most students choose?

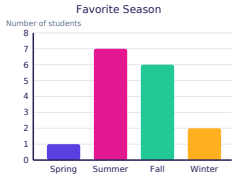

Bar Graphs · 20

How many students chose Swimming or Hockey?

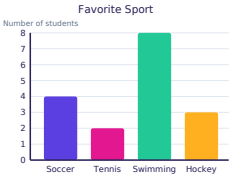

Bar Graphs · 21

Which season did the fewest students choose?

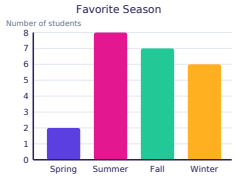

Bar Graphs · 22

How many fewer students chose Winter than Fall?

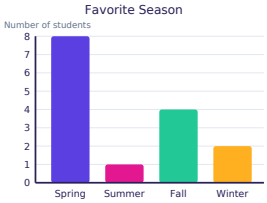

Bar Graphs · 23

How many students chose Chocolate?

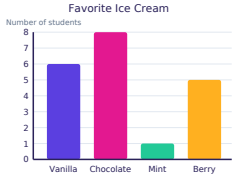

Bar Graphs · 24

How many more students chose Red than Yellow?

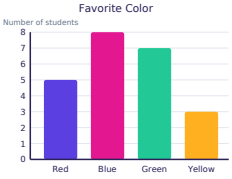

Bar Graphs · 18

ANSWER

1

Bar Graphs · 17

ANSWER

3

Bar Graphs · 20

ANSWER

11

Bar Graphs · 19

ANSWER

Summer

Bar Graphs · 22

ANSWER

2

Bar Graphs · 21

ANSWER

Spring

Bar Graphs · 24

ANSWER

2

Bar Graphs · 23

ANSWER

8