Task card 1 Bar Graph Word Problems

How many more rainy days were there in July and June together than in May?

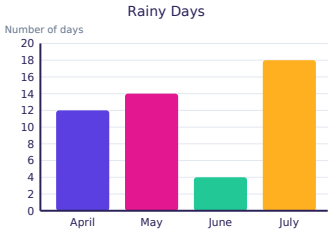

Task card 2 Bar Graph Word Problems

How many more points does the Red team need to tie the Gold team?

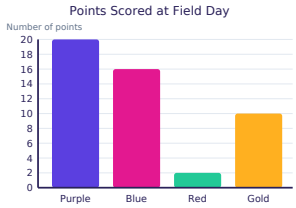

Task card 3 Bar Graph Word Problems

How many cookies were sold in all?

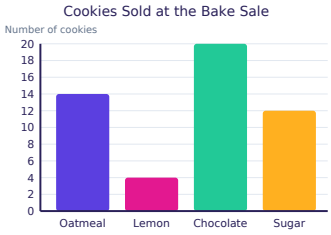

Task card 4 Bar Graph Word Problems

How many more rainy days were there in April and May together than in June?

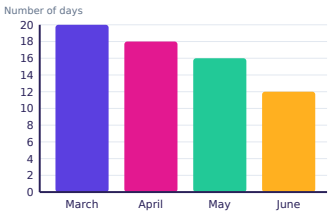

Task card 5 Bar Graph Word Problems

How many more books did Ava read than Max?



Task card 6 Bar Graph Word Problems

A teacher brings 5 more cans on Tuesday. How many cans were collected on Tuesday now?

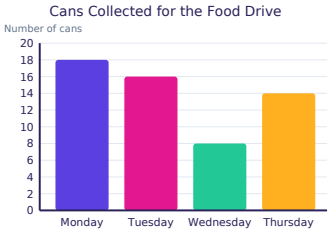

Task card 7 Bar Graph Word Problems

How many more rainy days were there in June and April together than in March?

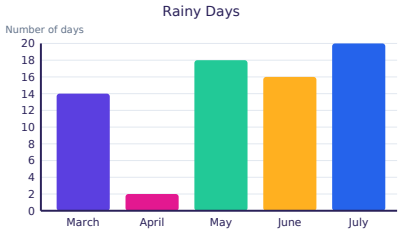

Task card 8 Bar Graph Word Problems

How many more books did Leo and Zoe read together than Mia?



Task card 9 Bar Graph Word Problems

The zoo wants as many Zebras as Monkeys. How many more Zebras does it need?



Task card 10 Bar Graph Word Problems

How many animals are on the graph in all?



Task card 11 Bar Graph Word Problems

Max reads 3 more books. How many books has Max read now?



Task card 12 Bar Graph Word Problems

How many more Monkeys and Goats together are there than Penguins?



Task card 13 Bar Graph Word Problems

How many more books did Mia and Max read together than Leo?



Task card 14 Bar Graph Word Problems

How many more rainy days would March need to have as many as April?

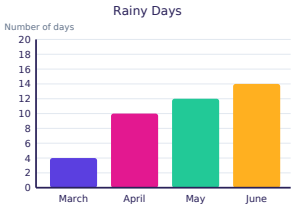

Task card 15 Bar Graph Word Problems

How many books did all the friends read in all?



Task card 16 Bar Graph Word Problems

How many more Monkeys and Zebras together are there than Lions?

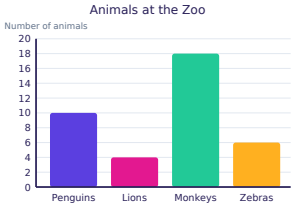

Task card 17 Bar Graph Word Problems

How many more cans did the class collect on Thursday than on Wednesday?

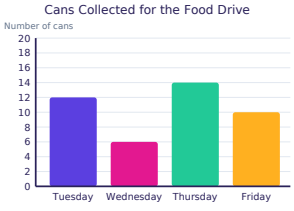

Task card 18 Bar Graph Word Problems

Ava reads 5 more books. How many books has Ava read now?



Task card 19 Bar Graph Word Problems

How many more Lemon and Oatmeal cookies together were sold than Chocolate cookies?

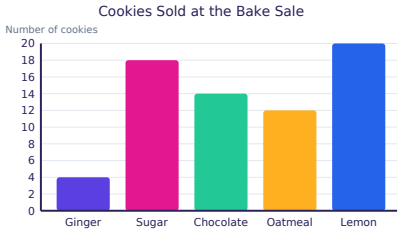

Task card 20 Bar Graph Word Problems

How many more Lemon and Ginger cookies together were sold than Chocolate cookies?

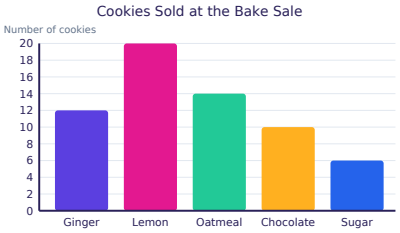

Task card 21 Bar Graph Word Problems

How many more points does the Purple team need to tie the Blue team?

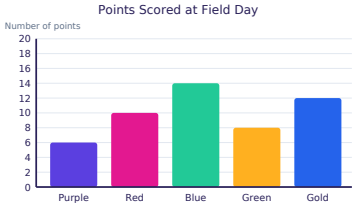

Task card 22 Bar Graph Word Problems

How many points did all the teams score in all?

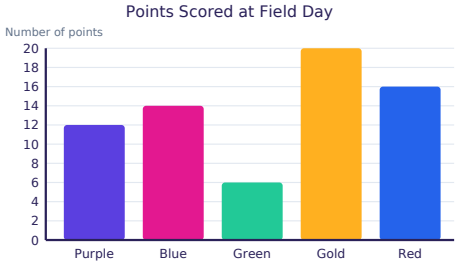

Task card 23 Bar Graph Word Problems

The Gold team wins 5 more points. How many points does it have now?

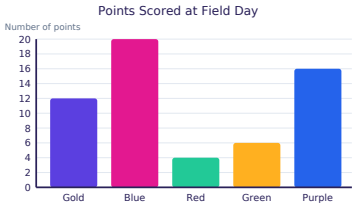

Task card 24 Bar Graph Word Problems

How many more points did the Gold and Blue teams score together than the Red team?

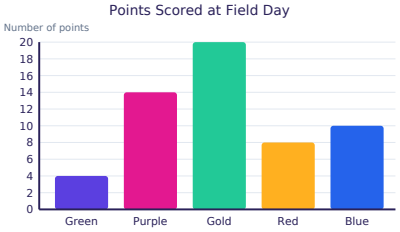

Bar Graph Word Problems Task Cards

Recording sheet · Grade 2 · Read each bar on the graph with the scale on the side. Then solve the story problem.

Name: _____ Date: _____

Scan to check your answers

1	2	3	4
5	6	7	8
9	10	11	12
13	14	15	16
17	18	19	20
21	22	23	24

Bar Graph Word Problems Task Cards: Answer Key

Grade 2 · Hard

The answers online

1. 8	**2.** 8	**3.** 50
4. 22	**5.** 6	**6.** 21
7. 4	**8.** 28	**9.** 10
10. 54	**11.** 21	**12.** 32
13. 14	**14.** 6	**15.** 32
16. 20	**17.** 8	**18.** 23
19. 18	**20.** 22	**21.** 8
22. 68	**23.** 17	**24.** 22