Task card 1 Bar Graph Word Problems

How many more points does the Gold team need to tie the Purple team?

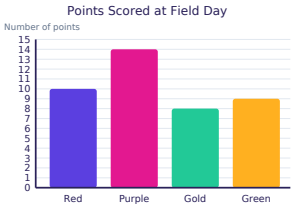

Task card 2 Bar Graph Word Problems

How many more cans did the class collect on Wednesday than on Tuesday?

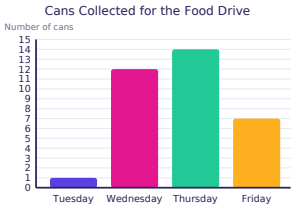

Task card 3 Bar Graph Word Problems

How many cookies were sold in all?

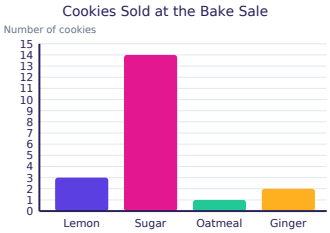

Task card 4 Bar Graph Word Problems

How many fewer Zebras than Monkeys live at the zoo?

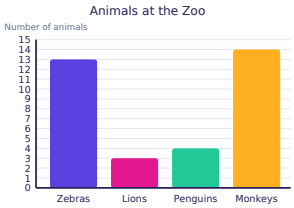

Task card 5 Bar Graph Word Problems

The graph left out 6 rainy days in June. How many rainy days did June really have?

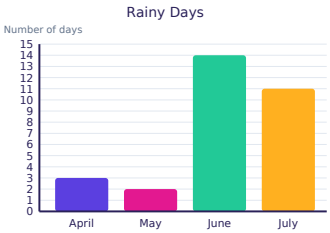

Task card 6 Bar Graph Word Problems

How many Lemon and Sugar cookies were sold in all?

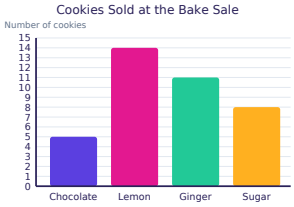

Task card 7 Bar Graph Word Problems

Max wants to read as many books as Ava. How many more books does Max need to read?



Task card 8 Bar Graph Word Problems

How many points did all the teams score in all?

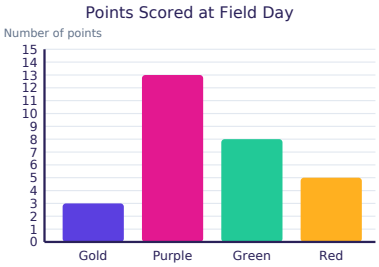

Task card 9 Bar Graph Word Problems

How many rainy days were there in March?

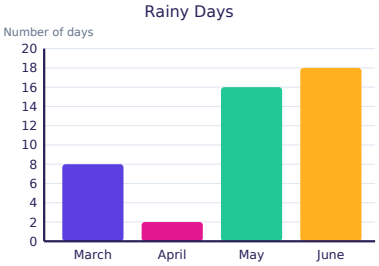

Task card 10 Bar Graph Word Problems

How many more Oatmeal cookies than Sugar cookies were sold?

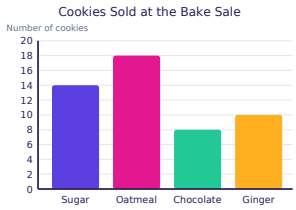

Task card 11 Bar Graph Word Problems

How many rainy days were there in May and March in all?

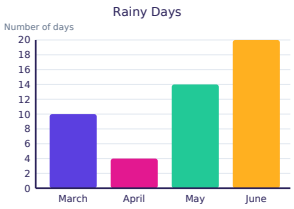

Task card 12 Bar Graph Word Problems

How many fewer Goats than Monkeys live at the zoo?

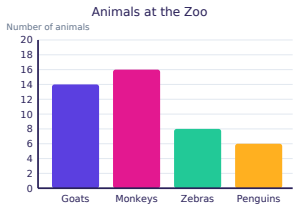

Task card 13 Bar Graph Word Problems

How many books did all the friends read in all?



Task card 14 Bar Graph Word Problems

The zoo wants as many Lions as Penguins. How many more Lions does it need?

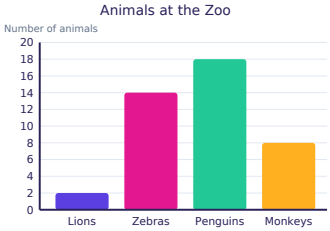

Task card 15 Bar Graph Word Problems

On which day did the class collect the most cans?

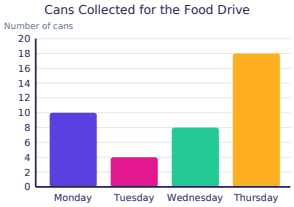

Task card 16 Bar Graph Word Problems

Later, 2 more Lemon cookies are sold. How many Lemon cookies were sold in all?

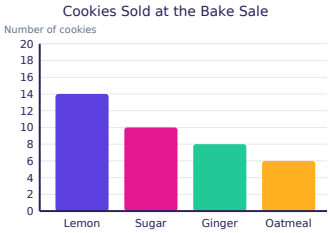

Task card 17 Bar Graph Word Problems

How many more Chocolate cookies needed to be sold to match the Sugar cookies?

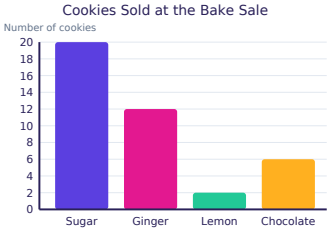

Task card 18 Bar Graph Word Problems

How many books did all the friends read in all?



Task card 19 Bar Graph Word Problems

How many more books did Sam read than Mia?



Task card 20 Bar Graph Word Problems

The graph left out 4 rainy days in May. How many rainy days did May really have?

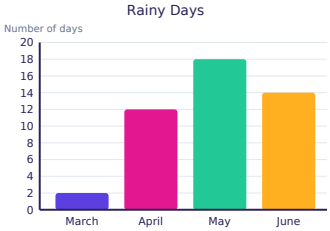

Task card 21 Bar Graph Word Problems

How many fewer books did Leo read than Max?



Task card 22 Bar Graph Word Problems

How many rainy days were there in May and April in all?

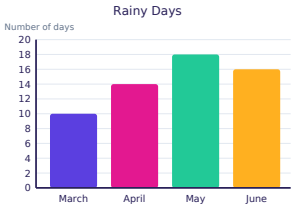

Task card 23 Bar Graph Word Problems

The zoo wants as many Lions as Goats. How many more Lions does it need?



Task card 24 Bar Graph Word Problems

How many points did all the teams score in all?

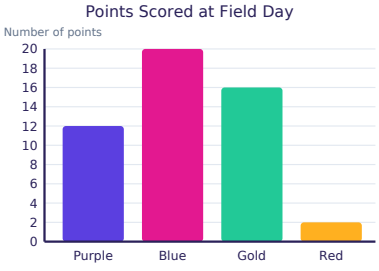

Bar Graph Word Problems Task Cards

Recording sheet · Grade 2 · Read each bar on the graph with the scale on the side. Then solve the story problem.

Name: _____ Date: _____

Scan to check your answers

1	2	3	4
5	6	7	8
9	10	11	12
13	14	15	16
17	18	19	20
21	22	23	24

Bar Graph Word Problems Task Cards: Answer Key

Grade 2 · Medium

The answers online

1. 6	**2.** 11	**3.** 20
4. 1	**5.** 20	**6.** 22
7. 1	**8.** 29	**9.** 8
10. 4	**11.** 24	**12.** 2
13. 46	**14.** 16	**15.** Thursday
16. 16	**17.** 14	**18.** 46
19. 10	**20.** 22	**21.** 10
22. 32	**23.** 8	**24.** 50