Bar Graph Word Problems · 1

How many more points does the Gold team need to tie the Purple team?

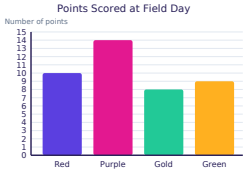

Bar Graph Word Problems · 2

How many more cans did the class collect on Wednesday than on Tuesday?

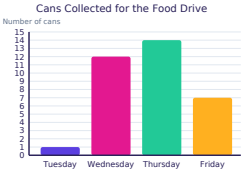

Bar Graph Word Problems · 3

How many cookies were sold in all?



Bar Graph Word Problems · 4

How many fewer Zebras than Monkeys live at the zoo?

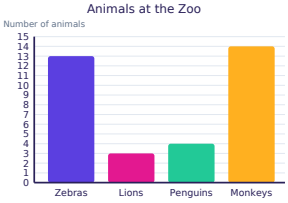

Bar Graph Word Problems · 5

The graph left out 6 rainy days in June. How many rainy days did June really have?

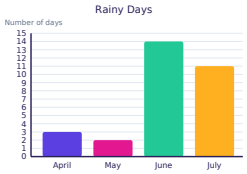

Bar Graph Word Problems · 6

How many Lemon and Sugar cookies were sold in all?

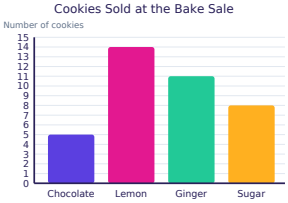

Bar Graph Word Problems · 7

Max wants to read as many books as Ava. How many more books does Max need to read?



Bar Graph Word Problems · 8

How many points did all the teams score in all?

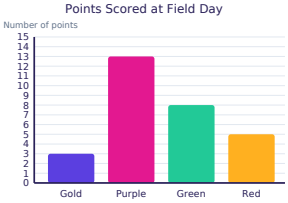

Bar Graph Word Problems · 2

ANSWER

11

Bar Graph Word Problems · 1

ANSWER

6

Bar Graph Word Problems · 4

ANSWER

1

Bar Graph Word Problems · 3

ANSWER

20

Bar Graph Word Problems · 6

ANSWER

22

Bar Graph Word Problems · 5

ANSWER

20

Bar Graph Word Problems · 8

ANSWER

29

Bar Graph Word Problems · 7

ANSWER

1

Bar Graph Word Problems · 9

How many rainy days were there in March?

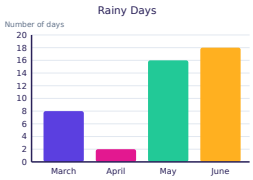

Bar Graph Word Problems · 10

How many more Oatmeal cookies than Sugar cookies were sold?

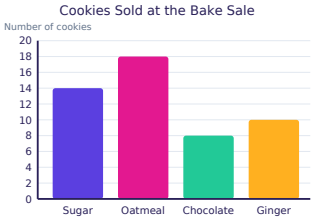

Bar Graph Word Problems · 11

How many rainy days were there in May and March in all?

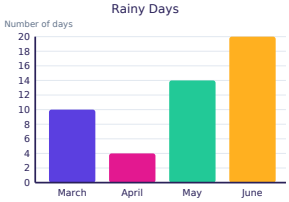

Bar Graph Word Problems · 12

How many fewer Goats than Monkeys live at the zoo?

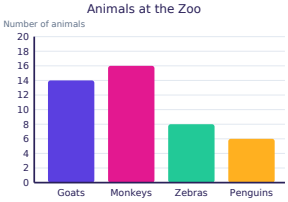

Bar Graph Word Problems · 13

How many books did all the friends read in all?



Bar Graph Word Problems · 14

The zoo wants as many Lions as Penguins. How many more Lions does it need?



Bar Graph Word Problems · 15

On which day did the class collect the most cans?

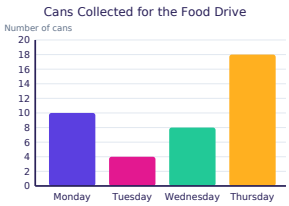

Bar Graph Word Problems · 16

Later, 2 more Lemon cookies are sold. How many Lemon cookies were sold in all?

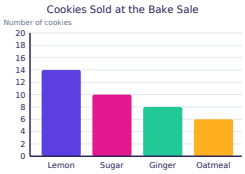

Bar Graph Word Problems · 10

ANSWER

4

Bar Graph Word Problems · 9

ANSWER

8

Bar Graph Word Problems · 12

ANSWER

2

Bar Graph Word Problems · 11

ANSWER

24

Bar Graph Word Problems · 14

ANSWER

16

Bar Graph Word Problems · 13

ANSWER

46

Bar Graph Word Problems · 16

ANSWER

16

Bar Graph Word Problems · 15

ANSWER

Thursday

Bar Graph Word Problems · 17

How many more Chocolate cookies needed to be sold to match the Sugar cookies?

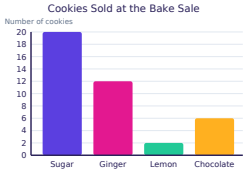

Bar Graph Word Problems · 18

How many books did all the friends read in all?



Bar Graph Word Problems · 19

How many more books did Sam read than Mia?



Bar Graph Word Problems · 20

The graph left out 4 rainy days in May. How many rainy days did May really have?

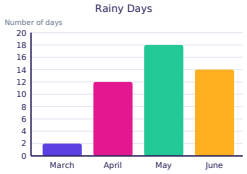

Bar Graph Word Problems · 21

How many fewer books did Leo read than Max?



Bar Graph Word Problems · 22

How many rainy days were there in May and April in all?

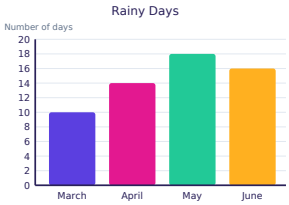

Bar Graph Word Problems · 23

The zoo wants as many Lions as Goats. How many more Lions does it need?



Bar Graph Word Problems · 24

How many points did all the teams score in all?

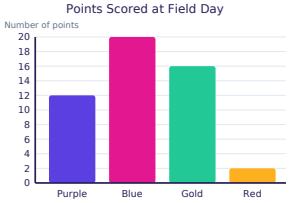

Bar Graph Word Problems · 18

ANSWER

46

Bar Graph Word Problems · 17

ANSWER

14

Bar Graph Word Problems · 20

ANSWER

22

Bar Graph Word Problems · 19

ANSWER

10

Bar Graph Word Problems · 22

ANSWER

32

Bar Graph Word Problems · 21

ANSWER

10

Bar Graph Word Problems · 24

ANSWER

50

Bar Graph Word Problems · 23

ANSWER

8