Bar Graph Word Problems · 1

How many more rainy days were there in July and June together than in May?

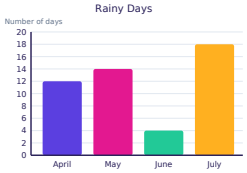

Bar Graph Word Problems · 2

How many more points does the Red team need to tie the Gold team?

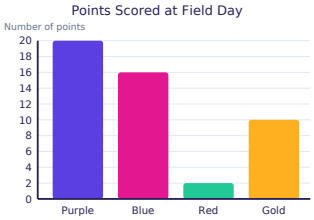

Bar Graph Word Problems · 3

How many cookies were sold in all?

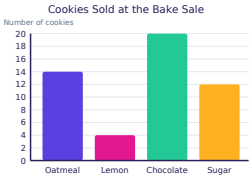

Bar Graph Word Problems · 4

How many more rainy days were there in April and May together than in June?

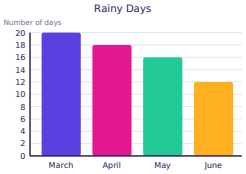

Bar Graph Word Problems · 5

How many more books did Ava read than Max?



Bar Graph Word Problems · 6

A teacher brings 5 more cans on Tuesday. How many cans were collected on Tuesday now?

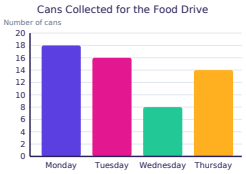

Bar Graph Word Problems · 7

How many more rainy days were there in June and April together than in March?

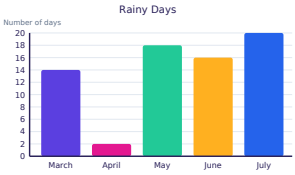

Bar Graph Word Problems · 8

How many more books did Leo and Zoe read together than Mia?



Bar Graph Word Problems · 2

ANSWER

8

Bar Graph Word Problems · 1

ANSWER

8

Bar Graph Word Problems · 4

ANSWER

22

Bar Graph Word Problems · 3

ANSWER

50

Bar Graph Word Problems · 6

ANSWER

21

Bar Graph Word Problems · 5

ANSWER

6

Bar Graph Word Problems · 8

ANSWER

28

Bar Graph Word Problems · 7

ANSWER

4

Bar Graph Word Problems · 9

The zoo wants as many Zebras as Monkeys. How many more Zebras does it need?



Bar Graph Word Problems · 10

How many animals are on the graph in all?



Bar Graph Word Problems · 11

Max reads 3 more books. How many books has Max read now?



Bar Graph Word Problems · 12

How many more Monkeys and Goats together are there than Penguins?



Bar Graph Word Problems · 13

How many more books did Mia and Max read together than Leo?



Bar Graph Word Problems · 14

How many more rainy days would March need to have as many as April?

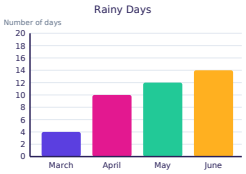

Bar Graph Word Problems · 15

How many books did all the friends read in all?



Bar Graph Word Problems · 16

How many more Monkeys and Zebras together are there than Lions?

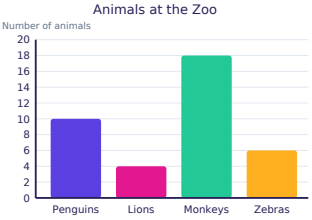

Bar Graph Word Problems · 10

ANSWER

54

Bar Graph Word Problems · 9

ANSWER

10

Bar Graph Word Problems · 12

ANSWER

32

Bar Graph Word Problems · 11

ANSWER

21

Bar Graph Word Problems · 14

ANSWER

6

Bar Graph Word Problems · 13

ANSWER

14

Bar Graph Word Problems · 16

ANSWER

20

Bar Graph Word Problems · 15

ANSWER

32

Bar Graph Word Problems · 17

How many more cans did the class collect on Thursday than on Wednesday?

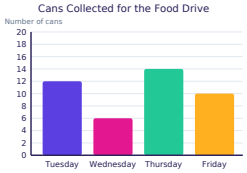

Bar Graph Word Problems · 18

Ava reads 5 more books. How many books has Ava read now?



Bar Graph Word Problems · 19

How many more Lemon and Oatmeal cookies together were sold than Chocolate cookies?

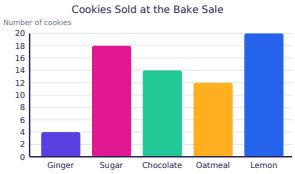

Bar Graph Word Problems · 20

How many more Lemon and Ginger cookies together were sold than Chocolate cookies?

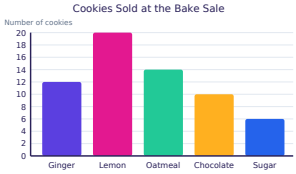

Bar Graph Word Problems · 21

How many more points does the Purple team need to tie the Blue team?

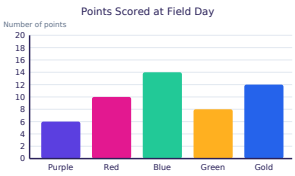

Bar Graph Word Problems · 22

How many points did all the teams score in all?

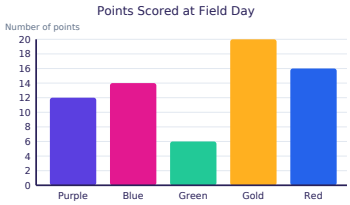

Bar Graph Word Problems · 23

The Gold team wins 5 more points. How many points does it have now?

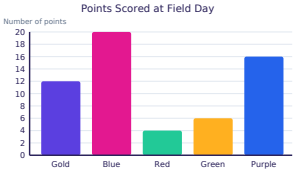

Bar Graph Word Problems · 24

How many more points did the Gold and Blue teams score together than the Red team?

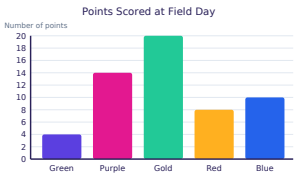

Bar Graph Word Problems · 18

ANSWER

23

Bar Graph Word Problems · 17

ANSWER

8

Bar Graph Word Problems · 20

ANSWER

22

Bar Graph Word Problems · 19

ANSWER

18

Bar Graph Word Problems · 22

ANSWER

68

Bar Graph Word Problems · 21

ANSWER

8

Bar Graph Word Problems · 24

ANSWER

22

Bar Graph Word Problems · 23

ANSWER

17