Bar Graph Word Problems · 1

How many rainy days were there in June?

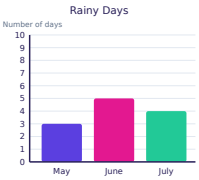

Bar Graph Word Problems · 2

How many more Ginger cookies than Sugar cookies were sold?

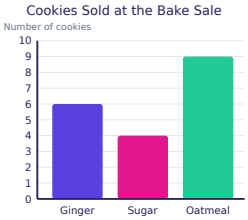

Bar Graph Word Problems · 3

How many Chocolate and Sugar cookies were sold in all?

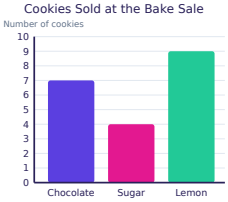

Bar Graph Word Problems · 4

Which kind of cookie sold the most?

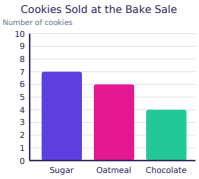

Bar Graph Word Problems · 5

How many cans did the class collect on Monday?

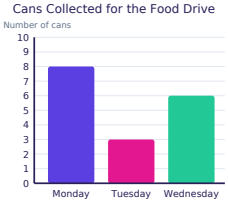

Bar Graph Word Problems · 6

How many fewer points did the Gold team score than the Green team?

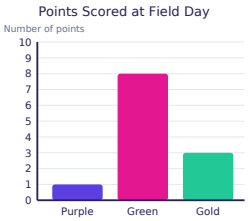

Bar Graph Word Problems · 7

How many points did the Green and Blue teams score in all?

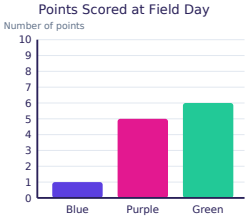

Bar Graph Word Problems · 8

Which team scored the fewest points? Write its color.

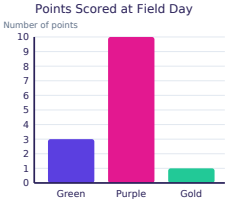

Bar Graph Word Problems · 2

ANSWER

2

Bar Graph Word Problems · 1

ANSWER

5

Bar Graph Word Problems · 4

ANSWER

Sugar

Bar Graph Word Problems · 3

ANSWER

11

Bar Graph Word Problems · 6

ANSWER

5

Bar Graph Word Problems · 5

ANSWER

8

Bar Graph Word Problems · 8

ANSWER

Gold

Bar Graph Word Problems · 7

ANSWER

7

Bar Graph Word Problems · 9

How many more books did Sam read than Ava?



Bar Graph Word Problems · 10

How many points did the Red and Gold teams score in all?

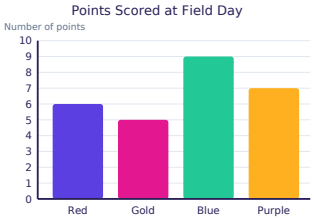

Bar Graph Word Problems · 11

How many fewer books did Zoe read than Ava?



Bar Graph Word Problems · 12

How many Chocolate cookies were sold?

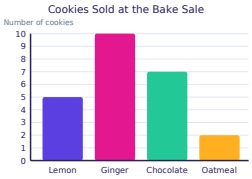

Bar Graph Word Problems · 13

Which animal does the zoo have the most of?

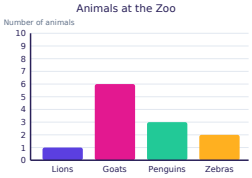

Bar Graph Word Problems · 14

How many more points did the Blue team score than the Gold team?

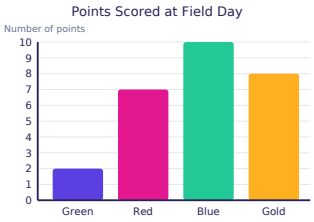

Bar Graph Word Problems · 15

How many Monkeys and Lions live at the zoo altogether?

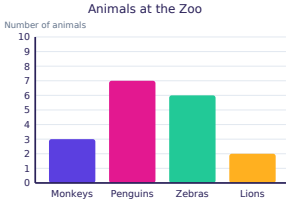

Bar Graph Word Problems · 16

Which month had the fewest rainy days?

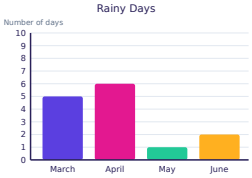

Bar Graph Word Problems · 10

ANSWER

11

Bar Graph Word Problems · 9

ANSWER

2

Bar Graph Word Problems · 12

ANSWER

7

Bar Graph Word Problems · 11

ANSWER

2

Bar Graph Word Problems · 14

ANSWER

2

Bar Graph Word Problems · 13

ANSWER

Goats

Bar Graph Word Problems · 16

ANSWER

May

Bar Graph Word Problems · 15

ANSWER

5

Bar Graph Word Problems · 17

How many more Sugar cookies than Oatmeal cookies were sold?

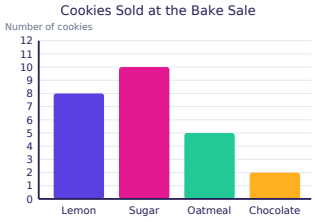

Bar Graph Word Problems · 18

How many fewer Monkeys than Zebras live at the zoo?



Bar Graph Word Problems · 19

How many cans did the class collect on Thursday and Monday in all?

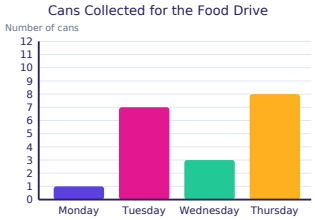

Bar Graph Word Problems · 20

How many cookies were sold in all?

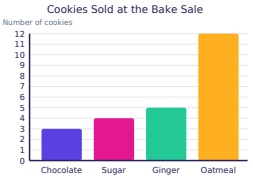

Bar Graph Word Problems · 21

How many more points does the Green team need to tie the Blue team?

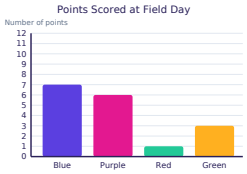

Bar Graph Word Problems · 22

How many more cans did the class collect on Monday than on Tuesday?

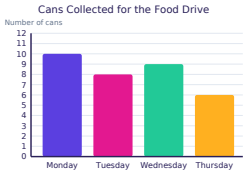

Bar Graph Word Problems · 23

How many books did Max and Sam read in all?



Bar Graph Word Problems · 24

Max reads 4 more books. How many books has Max read now?



Bar Graph Word Problems · 18

ANSWER

1

Bar Graph Word Problems · 17

ANSWER

5

Bar Graph Word Problems · 20

ANSWER

24

Bar Graph Word Problems · 19

ANSWER

9

Bar Graph Word Problems · 22

ANSWER

2

Bar Graph Word Problems · 21

ANSWER

4

Bar Graph Word Problems · 24

ANSWER

16

Bar Graph Word Problems · 23

ANSWER

15