Task card 1 Reading Bar Graphs

What is the total of all the bars?

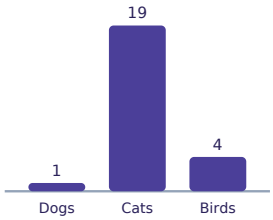

Task card 2 Reading Bar Graphs

What is the total of all the bars?

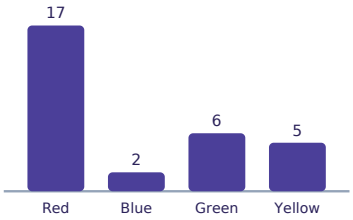

Task card 3 Reading Bar Graphs

What is the difference between Apples and Oranges?

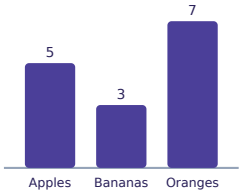

Task card 4 Reading Bar Graphs

What is the difference between Red and Yellow?

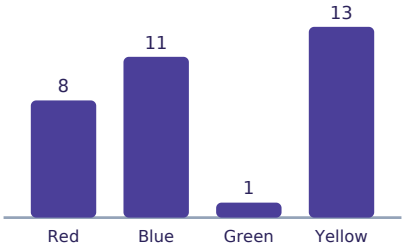

Task card 5 Reading Bar Graphs

What is the difference between Red and Green?

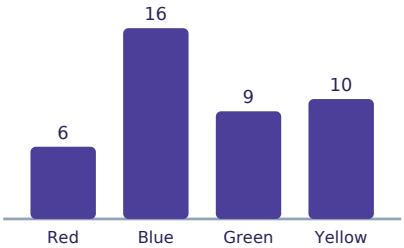

Task card 6 Reading Bar Graphs

What is the total of all the bars?

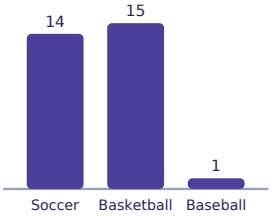

Task card 7 Reading Bar Graphs

What is the total of all the bars?

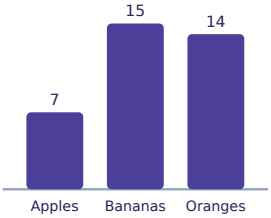

Task card 8 Reading Bar Graphs

What is the total of all the bars?

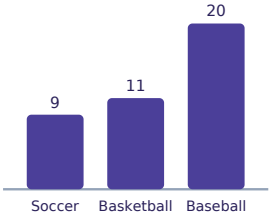

Task card 9 Reading Bar Graphs

Which category has the shortest bar?

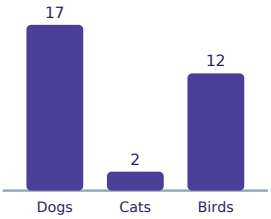

Task card 10 Reading Bar Graphs

Which category has the tallest bar?

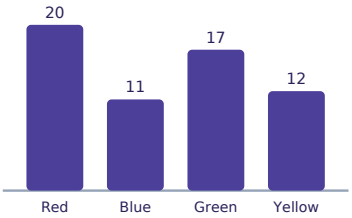

Task card 11 Reading Bar Graphs

What is the total of all the bars?

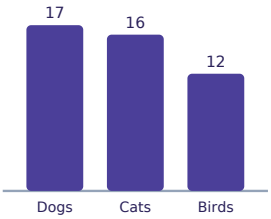

Task card 12 Reading Bar Graphs

What is the total of all the bars?

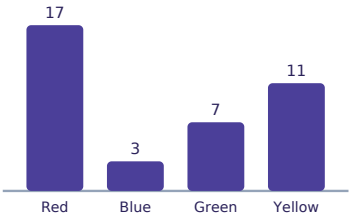

Task card 13 Reading Bar Graphs

What is the difference between Basketball and Soccer?

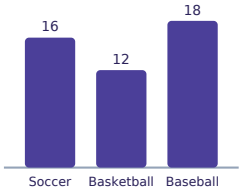

Task card 14 Reading Bar Graphs

What is the total of all the bars?

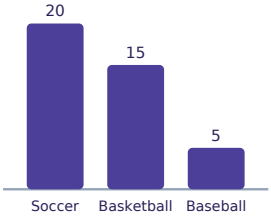

Task card 15 Reading Bar Graphs

What is the total of all the bars?

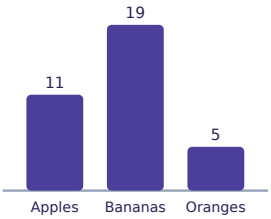

Task card 16 Reading Bar Graphs

What is the difference between Soccer and Baseball?

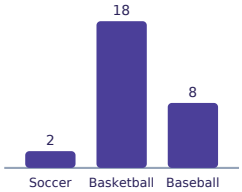

Task card 17 Reading Bar Graphs

What is the difference between Soccer and Baseball?

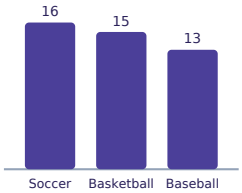

Task card 18 Reading Bar Graphs

What is the total of all the bars?

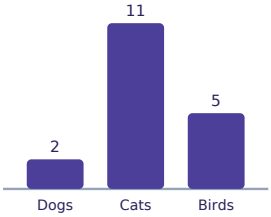

Task card 19 Reading Bar Graphs

What is the total of all the bars?

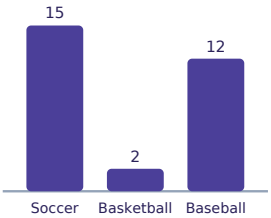

Task card 20 Reading Bar Graphs

What is the difference between Soccer and Basketball?

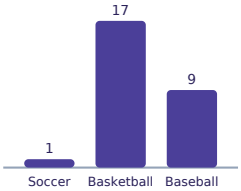

Task card 21 Reading Bar Graphs

What is the difference between Birds and Cats?

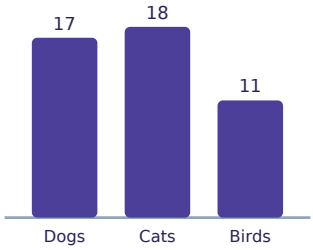

Task card 22 Reading Bar Graphs

Which category has the tallest bar?

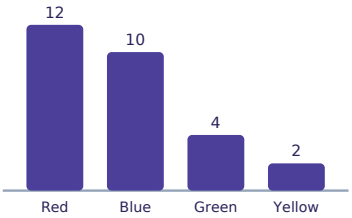

Task card 23 Reading Bar Graphs

Which category has the tallest bar?

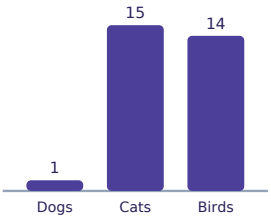

Task card 24 Reading Bar Graphs

What is the total of all the bars?

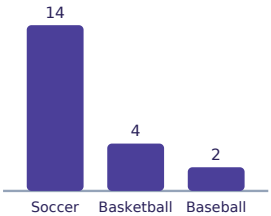

Reading Bar Graphs Task Cards

Recording sheet · Grade 2 · Study the bar graph, then answer each question.

Name: _____ Date: _____

Scan to check your answers

1	2	3	4
5	6	7	8
9	10	11	12
13	14	15	16
17	18	19	20
21	22	23	24

Reading Bar Graphs Task Cards: Answer Key

Grade 2 · Hard

The answers online

1. 24	**2.** 30	**3.** 2
4. 5	**5.** 3	**6.** 30
7. 36	**8.** 40	**9.** Cats
10. Red	**11.** 45	**12.** 38
13. 4	**14.** 40	**15.** 35
16. 6	**17.** 3	**18.** 18
19. 29	**20.** 16	**21.** 7
22. Red	**23.** Cats	**24.** 20