Reading Bar Graphs · 1

Which category has the tallest bar?

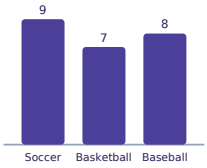

Reading Bar Graphs · 2

What is the difference between Apples and Oranges?

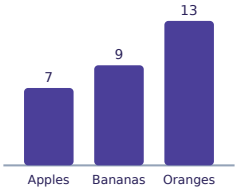

Reading Bar Graphs · 3

Which category has the shortest bar?

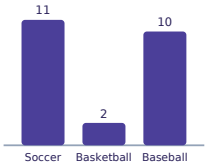

Reading Bar Graphs · 4

What is the difference between Red and Blue?

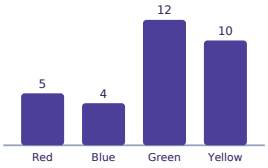

Reading Bar Graphs · 5

What is the total of all the bars?

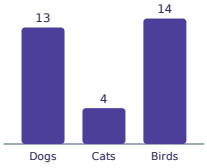

Reading Bar Graphs · 6

Which category has the shortest bar?

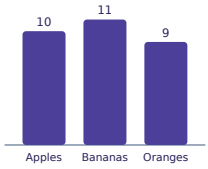

Reading Bar Graphs · 7

Which category has the shortest bar?

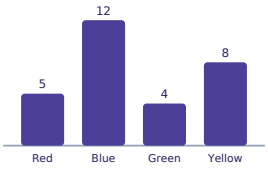

Reading Bar Graphs · 8

Which category has the tallest bar?

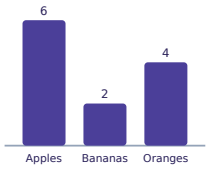

Reading Bar Graphs · 2

ANSWER

6

Reading Bar Graphs · 1

ANSWER

Soccer

Reading Bar Graphs · 4

ANSWER

1

Reading Bar Graphs · 3

ANSWER

Basketball

Reading Bar Graphs · 6

ANSWER

Oranges

Reading Bar Graphs · 5

ANSWER

31

Reading Bar Graphs · 8

ANSWER

Apples

Reading Bar Graphs · 7

ANSWER

Green

Reading Bar Graphs · 9

Which category has the shortest bar?

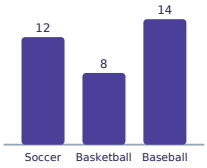

Reading Bar Graphs · 10

What is the total of all the bars?

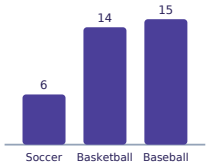

Reading Bar Graphs · 11

What is the total of all the bars?

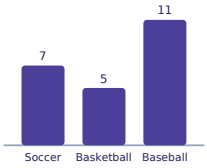

Reading Bar Graphs · 12

Which category has the shortest bar?

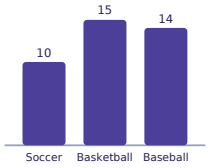

Reading Bar Graphs · 13

Which category has the tallest bar?

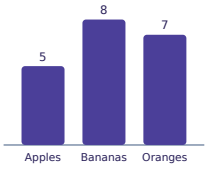

Reading Bar Graphs · 14

What is the total of all the bars?

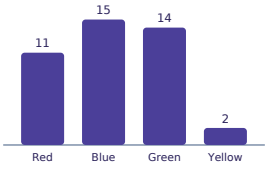

Reading Bar Graphs · 15

Which category has the shortest bar?

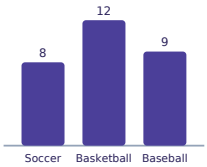

Reading Bar Graphs · 16

What is the difference between Soccer and Baseball?

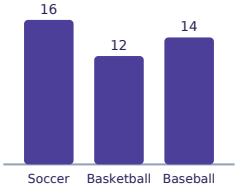

Reading Bar Graphs · 10

ANSWER

35

Reading Bar Graphs · 9

ANSWER

Basketball

Reading Bar Graphs · 12

ANSWER

Soccer

Reading Bar Graphs · 11

ANSWER

23

Reading Bar Graphs · 14

ANSWER

42

Reading Bar Graphs · 13

ANSWER

Bananas

Reading Bar Graphs · 16

ANSWER

2

Reading Bar Graphs · 15

ANSWER

Soccer

Reading Bar Graphs · 17

Which category has the shortest bar?

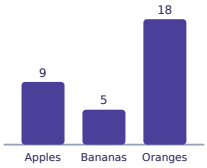

Reading Bar Graphs · 18

What is the difference between Cats and Birds?

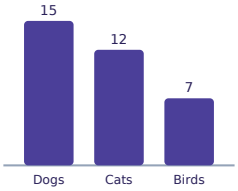

Reading Bar Graphs · 19

What is the total of all the bars?

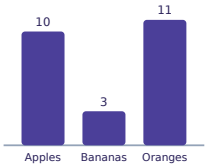

Reading Bar Graphs · 20

Which category has the tallest bar?

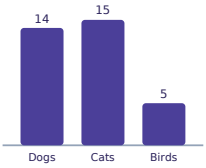

Reading Bar Graphs · 21

What is the difference between Apples and Bananas?

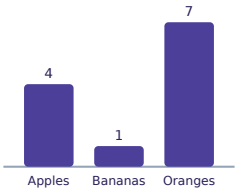

Reading Bar Graphs · 22

What is the difference between Green and Yellow?

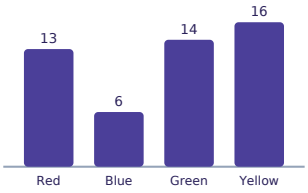

Reading Bar Graphs · 23

Which category has the shortest bar?

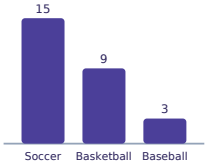

Reading Bar Graphs · 24

What is the total of all the bars?

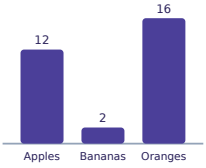

Reading Bar Graphs · 18

ANSWER

5

Reading Bar Graphs · 17

ANSWER

Bananas

Reading Bar Graphs · 20

ANSWER

Cats

Reading Bar Graphs · 19

ANSWER

24

Reading Bar Graphs · 22

ANSWER

2

Reading Bar Graphs · 21

ANSWER

3

Reading Bar Graphs · 24

ANSWER

30

Reading Bar Graphs · 23

ANSWER

Baseball