Reading Bar Graphs · 1

What is the total of all the bars?

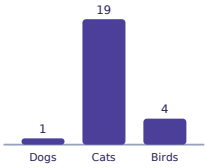

Reading Bar Graphs · 2

What is the total of all the bars?

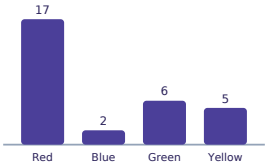

Reading Bar Graphs · 3

What is the difference between Apples and Oranges?

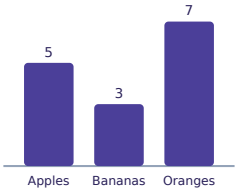

Reading Bar Graphs · 4

What is the difference between Red and Yellow?

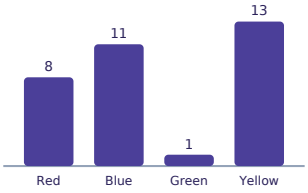

Reading Bar Graphs · 5

What is the difference between Red and Green?

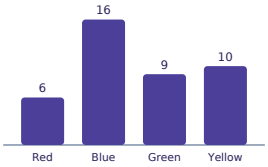

Reading Bar Graphs · 6

What is the total of all the bars?

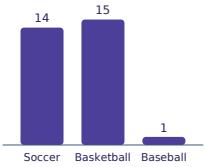

Reading Bar Graphs · 7

What is the total of all the bars?

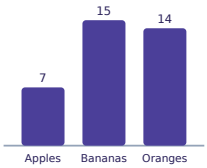

Reading Bar Graphs · 8

What is the total of all the bars?

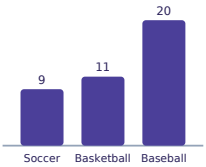

Reading Bar Graphs · 2

ANSWER

30

Reading Bar Graphs · 1

ANSWER

24

Reading Bar Graphs · 4

ANSWER

5

Reading Bar Graphs · 3

ANSWER

2

Reading Bar Graphs · 6

ANSWER

30

Reading Bar Graphs · 5

ANSWER

3

Reading Bar Graphs · 8

ANSWER

40

Reading Bar Graphs · 7

ANSWER

36

Reading Bar Graphs · 9

Which category has the shortest bar?

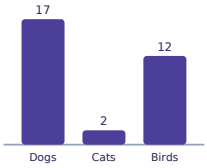

Reading Bar Graphs · 10

Which category has the tallest bar?

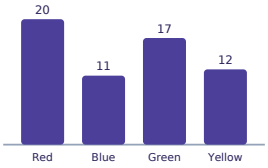

Reading Bar Graphs · 11

What is the total of all the bars?

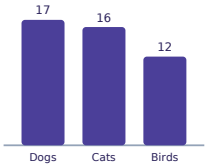

Reading Bar Graphs · 12

What is the total of all the bars?

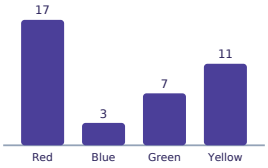

Reading Bar Graphs · 13

What is the difference between Basketball and Soccer?

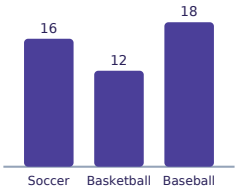

Reading Bar Graphs · 14

What is the total of all the bars?

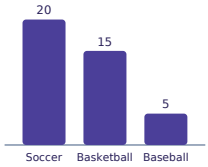

Reading Bar Graphs · 15

What is the total of all the bars?

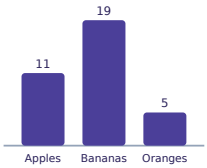

Reading Bar Graphs · 16

What is the difference between Soccer and Baseball?

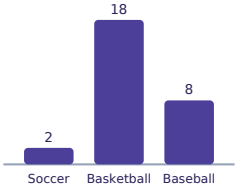

Reading Bar Graphs · 10

ANSWER

Red

Reading Bar Graphs · 9

ANSWER

Cats

Reading Bar Graphs · 12

ANSWER

38

Reading Bar Graphs · 11

ANSWER

45

Reading Bar Graphs · 14

ANSWER

40

Reading Bar Graphs · 13

ANSWER

4

Reading Bar Graphs · 16

ANSWER

6

Reading Bar Graphs · 15

ANSWER

35

Reading Bar Graphs · 17

What is the difference between Soccer and Baseball?

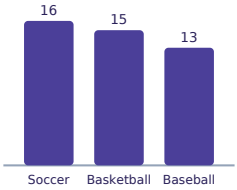

Reading Bar Graphs · 18

What is the total of all the bars?

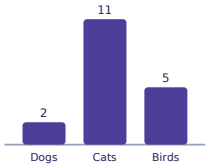

Reading Bar Graphs · 19

What is the total of all the bars?

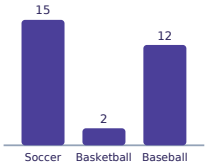

Reading Bar Graphs · 20

What is the difference between Soccer and Basketball?

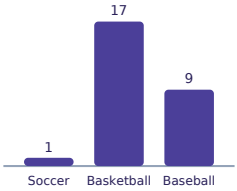

Reading Bar Graphs · 21

What is the difference between Birds and Cats?

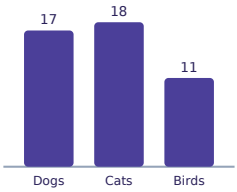

Reading Bar Graphs · 22

Which category has the tallest bar?

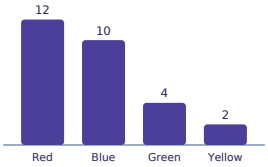

Reading Bar Graphs · 23

Which category has the tallest bar?

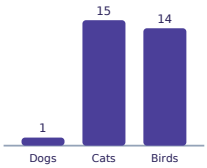

Reading Bar Graphs · 24

What is the total of all the bars?

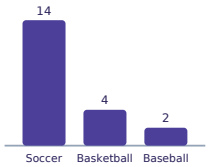

Reading Bar Graphs · 18

ANSWER

18

Reading Bar Graphs · 17

ANSWER

3

Reading Bar Graphs · 20

ANSWER

16

Reading Bar Graphs · 19

ANSWER

29

Reading Bar Graphs · 22

ANSWER

Red

Reading Bar Graphs · 21

ANSWER

7

Reading Bar Graphs · 24

ANSWER

20

Reading Bar Graphs · 23

ANSWER

Cats