Reading Bar Graphs · 1

What is the difference between Yellow and Red?

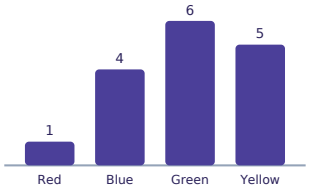

Reading Bar Graphs · 2

Which category has the tallest bar?

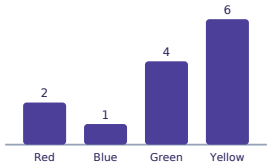

Reading Bar Graphs · 3

What is the total of all the bars?

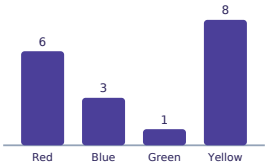

Reading Bar Graphs · 4

What is the total of all the bars?

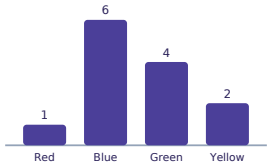

Reading Bar Graphs · 5

What is the difference between Oranges and Bananas?

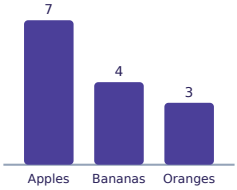

Reading Bar Graphs · 6

What is the total of all the bars?

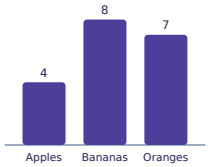

Reading Bar Graphs · 7

Which category has the shortest bar?

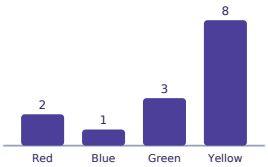

Reading Bar Graphs · 8

What is the total of all the bars?

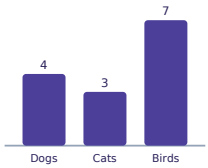

Reading Bar Graphs · 2

ANSWER

Yellow

Reading Bar Graphs · 1

ANSWER

4

Reading Bar Graphs · 4

ANSWER

13

Reading Bar Graphs · 3

ANSWER

18

Reading Bar Graphs · 6

ANSWER

19

Reading Bar Graphs · 5

ANSWER

1

Reading Bar Graphs · 8

ANSWER

14

Reading Bar Graphs · 7

ANSWER

Blue

Reading Bar Graphs · 9

What is the difference between Dogs and Cats?

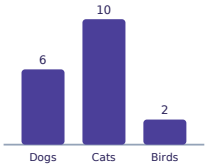

Reading Bar Graphs · 10

Which category has the shortest bar?

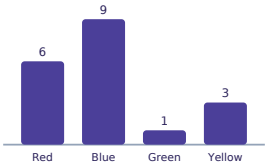

Reading Bar Graphs · 11

What is the total of all the bars?

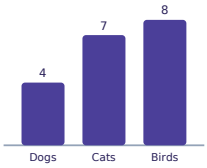

Reading Bar Graphs · 12

What is the total of all the bars?

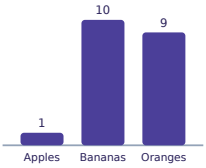

Reading Bar Graphs · 13

Which category has the shortest bar?

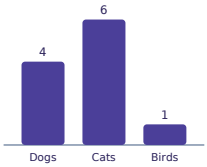

Reading Bar Graphs · 14

What is the difference between Yellow and Blue?

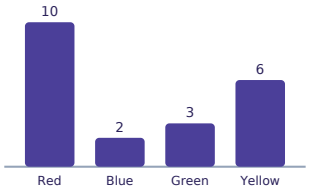

Reading Bar Graphs · 15

What is the difference between Cats and Birds?

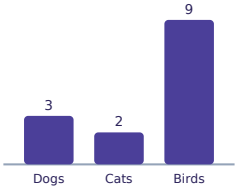

Reading Bar Graphs · 16

What is the difference between Blue and Red?

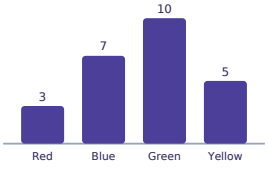

Reading Bar Graphs · 10

ANSWER

Green

Reading Bar Graphs · 9

ANSWER

4

Reading Bar Graphs · 12

ANSWER

20

Reading Bar Graphs · 11

ANSWER

19

Reading Bar Graphs · 14

ANSWER

4

Reading Bar Graphs · 13

ANSWER

Birds

Reading Bar Graphs · 16

ANSWER

4

Reading Bar Graphs · 15

ANSWER

7

Reading Bar Graphs · 17

What is the total of all the bars?

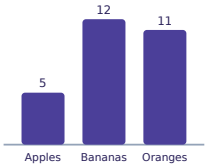

Reading Bar Graphs · 18

What is the total of all the bars?

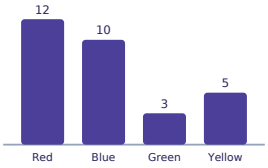

Reading Bar Graphs · 19

What is the total of all the bars?

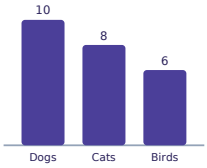

Reading Bar Graphs · 20

What is the total of all the bars?

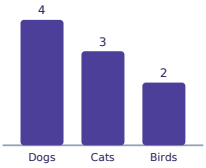

Reading Bar Graphs · 21

What is the total of all the bars?

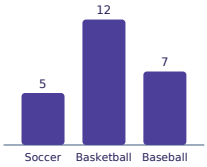

Reading Bar Graphs · 22

What is the total of all the bars?

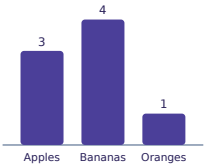

Reading Bar Graphs · 23

Which category has the tallest bar?

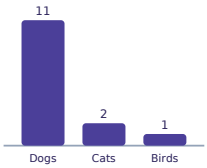

Reading Bar Graphs · 24

What is the difference between Blue and Red?

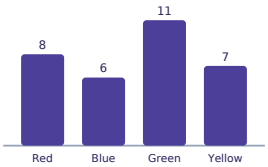

Reading Bar Graphs · 18

ANSWER

30

Reading Bar Graphs · 17

ANSWER

28

Reading Bar Graphs · 20

ANSWER

9

Reading Bar Graphs · 19

ANSWER

24

Reading Bar Graphs · 22

ANSWER

8

Reading Bar Graphs · 21

ANSWER

24

Reading Bar Graphs · 24

ANSWER

2

Reading Bar Graphs · 23

ANSWER

Dogs